Valentine's Day Math · 1

Each box holds 15 cupcakes. The bakery fills 15 boxs. How many cupcakes is that?

Valentine's Day Math · 2

Sam eats $\frac{2}{10}$ of a heart-shaped cake. Ben eats $\frac{1}{10}$ of it. What fraction of the heart-shaped cake did they eat together?

Valentine's Day Math · 3

Mia eats $\frac{6}{12}$ of a heart-shaped cake. Ava eats $\frac{5}{12}$ of it. What fraction of the heart-shaped cake did they eat together?

Valentine's Day Math · 4

Each box holds 22 cupcakes. The bakery fills 43 boxs. How many cupcakes is that?

Valentine's Day Math · 5

There are 115 brownies. Each box holds 9. How many boxs can be filled all the way?

Valentine's Day Math · 6

Ava glues red ribbon all the way around a rectangular bulletin board that is 12 feet wide and 11 feet tall. How many feet of ribbon does Ava need?

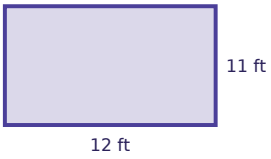

Valentine's Day Math · 7

There are 141 cupcakes. Each box holds 7. How many boxs can be filled all the way?

Valentine's Day Math · 8

Ava glues red ribbon all the way around a rectangular bulletin board that is 5 feet wide and 3 feet tall. How many feet of ribbon does Ava need?

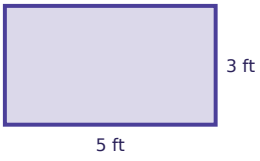

Valentine's Day Math · 2

ANSWER

$\frac{3}{10}$

Valentine's Day Math · 1

ANSWER

225

Valentine's Day Math · 4

ANSWER

946

Valentine's Day Math · 3

ANSWER

$\frac{11}{12}$

Valentine's Day Math · 6

ANSWER

46

Valentine's Day Math · 5

ANSWER

12

Valentine's Day Math · 8

ANSWER

16

Valentine's Day Math · 7

ANSWER

20

Valentine's Day Math · 9

Omar eats $\frac{2}{10}$ of a heart-shaped cake. Sam eats $\frac{1}{10}$ of it. What fraction of the heart-shaped cake did they eat together?

Valentine's Day Math · 10

Each box holds 16 brownies. The bakery fills 34 boxs. How many brownies is that?

Valentine's Day Math · 11

Sam glues red ribbon all the way around a rectangular bulletin board that is 12 feet wide and 5 feet tall. How many feet of ribbon does Sam need?



Valentine's Day Math · 12

Mia glues red ribbon all the way around a rectangular bulletin board that is 6 feet wide and 3 feet tall. How many feet of ribbon does Mia need?

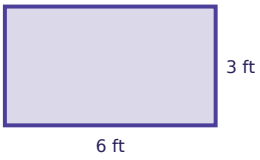

Valentine's Day Math · 13

There are 43 heart cookies. Each box holds 4. How many boxs can be filled all the way?

Valentine's Day Math · 14

There are 32 brownies. Each box holds 3. How many boxs can be filled all the way?

Valentine's Day Math · 15

Each box holds 11 brownies. The bakery fills 12 boxs. How many brownies is that?

Valentine's Day Math · 16

Ava eats $\frac{2}{12}$ of a heart-shaped cake. Ella eats $\frac{9}{12}$ of it. What fraction of the heart-shaped cake did they eat together?

Valentine's Day Math · 10

ANSWER

544

Valentine's Day Math · 9

ANSWER

$\frac{3}{10}$

Valentine's Day Math · 12

ANSWER

18

Valentine's Day Math · 11

ANSWER

34

Valentine's Day Math · 14

ANSWER

10

Valentine's Day Math · 13

ANSWER

10

Valentine's Day Math · 16

ANSWER

$\frac{11}{12}$

Valentine's Day Math · 15

ANSWER

132

Valentine's Day Math · 17

Sam eats $\frac{9}{12}$ of a heart-shaped cake. Lily eats $\frac{2}{12}$ of it. What fraction of the heart-shaped cake did they eat together?

Valentine's Day Math · 18

Ava glues red ribbon all the way around a rectangular bulletin board that is 4 feet wide and 2 feet tall. How many feet of ribbon does Ava need?

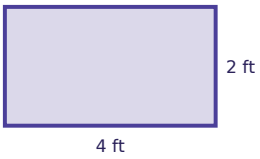

Valentine's Day Math · 19

There are 149 cupcakes. Each box holds 8. How many boxs can be filled all the way?

Valentine's Day Math · 20

Each box holds 21 brownies. The bakery fills 22 boxs. How many brownies is that?

Valentine's Day Math · 21

Each box holds 14 cupcakes. The bakery fills 43 boxs. How many cupcakes is that?

Valentine's Day Math · 22

There are 81 heart cookies. Each box holds 7. After filling as many boxs as possible, how many heart cookies are left over?

Valentine's Day Math · 23

Lily eats $\frac{2}{10}$ of a heart-shaped cake. Leo eats $\frac{1}{10}$ of it. What fraction of the heart-shaped cake did they eat together?

Valentine's Day Math · 24

Zoe glues red ribbon all the way around a rectangular bulletin board that is 5 feet wide and 2 feet tall. How many feet of ribbon does Zoe need?

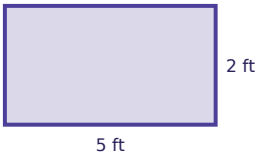

Valentine's Day Math · 18

ANSWER

12

Valentine's Day Math · 17

ANSWER

$$\frac{11}{12}$$

Valentine's Day Math · 20

ANSWER

462

Valentine's Day Math · 19

ANSWER

18

Valentine's Day Math · 22

ANSWER

4

Valentine's Day Math · 21

ANSWER

602

Valentine's Day Math · 24

ANSWER

14

Valentine's Day Math · 23

ANSWER

$$\frac{3}{10}$$