Valentine's Day Math · 1

Ava eats $\frac{2}{7}$ of a heart-shaped cake. Zoe eats $\frac{1}{7}$ of it. What fraction of the heart-shaped cake did they eat together?

Valentine's Day Math · 2

There are 26 heart cookies. Each box holds 3. After filling as many boxs as possible, how many heart cookies are left over?

Valentine's Day Math · 3

Each box holds 7 brownies. The bakery fills 28 boxs. How many brownies is that?

Valentine's Day Math · 4

Omar glues red ribbon all the way around a rectangular bulletin board that is 4 feet wide and 3 feet tall. How many feet of ribbon does Omar need?

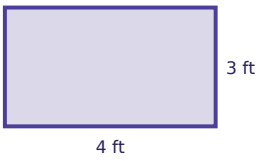

Valentine's Day Math · 5

There are 44 brownies. Each box holds 8. After filling as many boxs as possible, how many brownies are left over?

Valentine's Day Math · 6

Lily glues red ribbon all the way around a rectangular bulletin board that is 6 feet wide and 4 feet tall. How many feet of ribbon does Lily need?

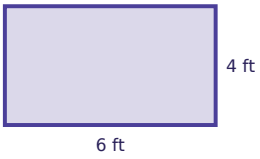

Valentine's Day Math · 7

Each box holds 4 heart cookies. The bakery fills 24 boxs. How many heart cookies is that?

Valentine's Day Math · 8

Ava eats $\frac{3}{8}$ of a heart-shaped cake. Leo eats $\frac{2}{8}$ of it. What fraction of the heart-shaped cake did they eat together?

Valentine's Day Math · 2

ANSWER

2

Valentine's Day Math · 1

ANSWER

$$\frac{3}{7}$$

Valentine's Day Math · 4

ANSWER

14

Valentine's Day Math · 3

ANSWER

196

Valentine's Day Math · 6

ANSWER

20

Valentine's Day Math · 5

ANSWER

4

Valentine's Day Math · 8

ANSWER

$$\frac{5}{8}$$

Valentine's Day Math · 7

ANSWER

96

Valentine's Day Math · 9

Each box holds 7 heart cookies. The bakery fills 40 boxs. How many heart cookies is that?

Valentine's Day Math · 10

Zoe glues red ribbon all the way around a rectangular bulletin board that is 7 feet wide and 4 feet tall. How many feet of ribbon does Zoe need?

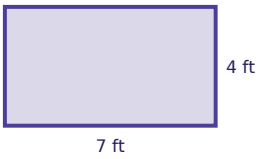

Valentine's Day Math · 11

There are 22 brownies. Each box holds 4. After filling as many boxs as possible, how many brownies are left over?

Valentine's Day Math · 12

Each box holds 5 cupcakes. The bakery fills 13 boxs. How many cupcakes is that?

Valentine's Day Math · 13

Ella eats $\frac{2}{8}$ of a heart-shaped cake. Ava eats $\frac{1}{8}$ of it. What fraction of the heart-shaped cake did they eat together?

Valentine's Day Math · 14

There are 44 cupcakes. Each box holds 7. How many boxs can be filled all the way?

Valentine's Day Math · 15

Ben glues red ribbon all the way around a rectangular bulletin board that is 5 feet wide and 4 feet tall. How many feet of ribbon does Ben need?

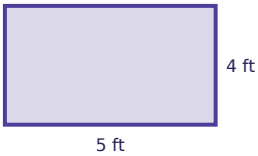

Valentine's Day Math · 16

Sam eats $\frac{4}{7}$ of a heart-shaped cake. Ben eats $\frac{2}{7}$ of it. What fraction of the heart-shaped cake did they eat together?

Valentine's Day Math · 10

ANSWER

22

Valentine's Day Math · 9

ANSWER

280

Valentine's Day Math · 12

ANSWER

65

Valentine's Day Math · 11

ANSWER

2

Valentine's Day Math · 14

ANSWER

6

Valentine's Day Math · 13

ANSWER

$$\frac{3}{8}$$

Valentine's Day Math · 16

ANSWER

$$\frac{6}{7}$$

Valentine's Day Math · 15

ANSWER

18

Valentine's Day Math · 17

Each box holds 8 heart cookies. The bakery fills 46 boxs. How many heart cookies is that?

Valentine's Day Math · 18

Each box holds 8 brownies. The bakery fills 12 boxs. How many brownies is that?

Valentine's Day Math · 19

There are 85 cupcakes. Each box holds 7. After filling as many boxs as possible, how many cupcakes are left over?

Valentine's Day Math · 20

There are 86 brownies. Each box holds 7. After filling as many boxs as possible, how many brownies are left over?

Valentine's Day Math · 21

Noah eats $\frac{4}{7}$ of a heart-shaped cake. Ben eats $\frac{2}{7}$ of it. What fraction of the heart-shaped cake did they eat together?

Valentine's Day Math · 22

Ava glues red ribbon all the way around a rectangular bulletin board that is 9 feet wide and 7 feet tall. How many feet of ribbon does Ava need?

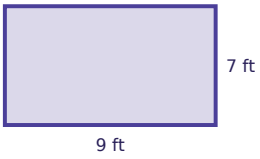

Valentine's Day Math · 23

Ben glues red ribbon all the way around a rectangular bulletin board that is 5 feet wide and 2 feet tall. How many feet of ribbon does Ben need?

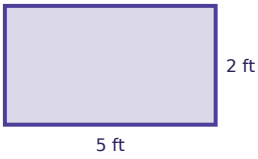

Valentine's Day Math · 24

Ava eats $\frac{2}{7}$ of a heart-shaped cake. Ben eats $\frac{3}{7}$ of it. What fraction of the heart-shaped cake did they eat together?

Valentine's Day Math · 18

ANSWER

96

Valentine's Day Math · 17

ANSWER

368

Valentine's Day Math · 20

ANSWER

2

Valentine's Day Math · 19

ANSWER

1

Valentine's Day Math · 22

ANSWER

32

Valentine's Day Math · 21

ANSWER

$$\frac{6}{7}$$

Valentine's Day Math · 24

ANSWER

$$\frac{5}{7}$$

Valentine's Day Math · 23

ANSWER

14