2 minutes 53 seconds = ___ seconds



69 days = 9 weeks and ___ days



The clock shows when a class starts. It lasts 2 hours 25 minutes. What time does it end? (Write it like 4:05.)





Compare. Write >, < or =: 2 weeks ___ 17 days



10 weeks 6 days = ___ days



733 minutes = 12 hours and ___ minutes



The clock shows when a class starts. It lasts 3 hours 10 minutes. What time does it end? (Write it like 4:05.)





Compare. Write >, < or =: 12 hours ___ 726 minutes

Time: Converting Units & Elapsed Time · 2

**ANSWER**

**6**

Time: Converting Units & Elapsed Time · 1

**ANSWER**

**173**

Time: Converting Units & Elapsed Time · 4

**ANSWER**

**<**

Time: Converting Units & Elapsed Time · 3

**ANSWER**

**12:05**

Time: Converting Units & Elapsed Time · 6

**ANSWER**

**13**

Time: Converting Units & Elapsed Time · 5

**ANSWER**

**76**

Time: Converting Units & Elapsed Time · 8

**ANSWER**

**<**

Time: Converting Units & Elapsed Time · 7

**ANSWER**

**8:10**

4 days 5 hours = ___ hours



679 seconds = 11 minutes and ___ seconds



The clock shows when a class starts. It lasts 40 minutes. What time does it end? (Write it like 4:05.)





Compare. Write >, < or =: 7 minutes ___ 474 seconds



2 weeks 3 days = ___ days



195 hours = 8 days and ___ hours



The clock shows when a class starts. It lasts 10 minutes. What time does it end? (Write it like 4:05.)





Compare. Write >, < or =: 5 minutes ___ 291 seconds

Time: Converting Units & Elapsed Time · 10

**ANSWER**

**19**

Time: Converting Units & Elapsed Time · 9

**ANSWER**

**101**

Time: Converting Units & Elapsed Time · 12

**ANSWER**

**<**

Time: Converting Units & Elapsed Time · 11

**ANSWER**

**7:40**

Time: Converting Units & Elapsed Time · 14

**ANSWER**

**3**

Time: Converting Units & Elapsed Time · 13

**ANSWER**

**17**

Time: Converting Units & Elapsed Time · 16

**ANSWER**

**>**

Time: Converting Units & Elapsed Time · 15

**ANSWER**

**6:45**

3 minutes 16 seconds = ___ seconds



496 seconds = 8 minutes and ___ seconds



The clock shows when a class starts. It lasts 3 hours 15 minutes. What time does it end? (Write it like 4:05.)





Compare. Write >, < or =: 10 years ___ 114 months



8 years 9 months = ___ months



761 seconds = 12 minutes and ___ seconds



The clock shows when a class starts. It lasts 2 hours 5 minutes. What time does it end? (Write it like 4:05.)





Compare. Write >, < or =: 4 weeks ___ 32 days

Time: Converting Units & Elapsed Time · 18

**ANSWER**

**16**

Time: Converting Units & Elapsed Time · 17

**ANSWER**

**196**

Time: Converting Units & Elapsed Time · 20

**ANSWER**

**>**

Time: Converting Units & Elapsed Time · 19

**ANSWER**

**10:55**

Time: Converting Units & Elapsed Time · 22

**ANSWER**

**41**

Time: Converting Units & Elapsed Time · 21

**ANSWER**

**105**

Time: Converting Units & Elapsed Time · 24

**ANSWER**

**<**

Time: Converting Units & Elapsed Time · 23

**ANSWER**

**6:50**