2 minutes 53 seconds = ___ seconds

69 days = 9 weeks and ___ days

The clock shows when a class starts. It lasts 2 hours 25 minutes. What time does it end? (Write it like 4:05.)



Compare. Write >, < or =: 2 weeks ___ 17 days

10 weeks 6 days = ___ days

733 minutes = 12 hours and ___ minutes

The clock shows when a class starts. It lasts 3 hours 10 minutes. What time does it end? (Write it like 4:05.)



Compare. Write >, < or =: 12 hours ___ 726 minutes

Time: Converting Units & Elapsed Time · 2

ANSWER

6

Time: Converting Units & Elapsed Time · 1

ANSWER

173

Time: Converting Units & Elapsed Time · 4

ANSWER

<

Time: Converting Units & Elapsed Time · 3

ANSWER

12:05

Time: Converting Units & Elapsed Time · 6

ANSWER

13

Time: Converting Units & Elapsed Time · 5

ANSWER

76

Time: Converting Units & Elapsed Time · 8

ANSWER

<

Time: Converting Units & Elapsed Time · 7

ANSWER

8:10

4 days 5 hours = ___ hours

679 seconds = 11 minutes and ___ seconds

The clock shows when a class starts. It lasts 40 minutes. What time does it end? (Write it like 4:05.)



Compare. Write >, < or =: 7 minutes ___ 474 seconds

2 weeks 3 days = ___ days

195 hours = 8 days and ___ hours

The clock shows when a class starts. It lasts 10 minutes. What time does it end? (Write it like 4:05.)



Compare. Write >, < or =: 5 minutes ___ 291 seconds

Time: Converting Units & Elapsed Time · 10

ANSWER

19

Time: Converting Units & Elapsed Time · 9

ANSWER

101

Time: Converting Units & Elapsed Time · 12

ANSWER

<

Time: Converting Units & Elapsed Time · 11

ANSWER

7:40

Time: Converting Units & Elapsed Time · 14

ANSWER

3

Time: Converting Units & Elapsed Time · 13

ANSWER

17

Time: Converting Units & Elapsed Time · 16

ANSWER

>

Time: Converting Units & Elapsed Time · 15

ANSWER

6:45

3 minutes 16 seconds = ___ seconds

496 seconds = 8 minutes and ___ seconds

The clock shows when a class starts. It lasts 3 hours 15 minutes. What time does it end? (Write it like 4:05.)



Compare. Write >, < or =: 10 years ___ 114 months

8 years 9 months = ___ months

761 seconds = 12 minutes and ___ seconds

The clock shows when a class starts. It lasts 2 hours 5 minutes. What time does it end? (Write it like 4:05.)



Compare. Write >, < or =: 4 weeks ___ 32 days

Time: Converting Units & Elapsed Time · 18

ANSWER

16

Time: Converting Units & Elapsed Time · 17

ANSWER

196

Time: Converting Units & Elapsed Time · 20

ANSWER

>

Time: Converting Units & Elapsed Time · 19

ANSWER

10:55

Time: Converting Units & Elapsed Time · 22

ANSWER

41

Time: Converting Units & Elapsed Time · 21

ANSWER

105

Time: Converting Units & Elapsed Time · 24

ANSWER

<

Time: Converting Units & Elapsed Time · 23

ANSWER

6:50