Task card 1 Thanksgiving Math

Noah sews ribbon all the way around a rectangular tablecloth that is 13 feet long and 9 feet wide. How many feet of ribbon does Noah need?

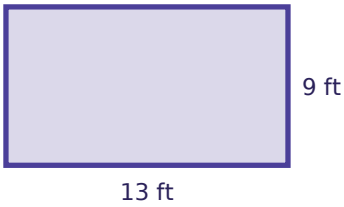

Task card 2 Thanksgiving Math

Zoe eats $\frac{3}{8}$ of a pumpkin pie. Sam eats $\frac{4}{8}$ of it. What fraction of the pumpkin pie did they eat together?

Task card 3 Thanksgiving Math

There are 156 cranberry tarts. Each basket holds 9. How many baskets can be filled all the way?

Task card 4 Thanksgiving Math

Each basket holds 19 corn muffins. The bakery fills 89 baskets. How many corn muffins is that?

Task card 5 Thanksgiving Math

There are 46 rolls. Each basket holds 5. After filling as many baskets as possible, how many rolls are left over?

Task card 6 Thanksgiving Math

Lily eats $\frac{1}{12}$ of a pumpkin pie. Noah eats $\frac{4}{12}$ of it. What fraction of the pumpkin pie did they eat together?

Task card 7 Thanksgiving Math

Each basket holds 23 cranberry tarts. The bakery fills 72 baskets. How many cranberry tarts is that?

Task card 8 Thanksgiving Math

Ava sews ribbon all the way around a rectangular tablecloth that is 9 feet long and 5 feet wide. How many feet of ribbon does Ava need?



Task card 9 Thanksgiving Math

Noah eats $\frac{4}{9}$ of a pumpkin pie. Ella eats $\frac{1}{9}$ of it. What fraction of the pumpkin pie did they eat together?

Task card 10 Thanksgiving Math

Each basket holds 11 rolls. The bakery fills 24 baskets. How many rolls is that?

Task card 11 Thanksgiving Math

There are 86 rolls. Each basket holds 4. After filling as many baskets as possible, how many rolls are left over?

Task card 12 Thanksgiving Math

Mia sews ribbon all the way around a rectangular tablecloth that is 13 feet long and 6 feet wide. How many feet of ribbon does Mia need?



Task card 13 Thanksgiving Math

Each basket holds 18 corn muffins. The bakery fills 52 baskets. How many corn muffins is that?

Task card 14 Thanksgiving Math

Leo sews ribbon all the way around a rectangular tablecloth that is 9 feet long and 7 feet wide. How many feet of ribbon does Leo need?

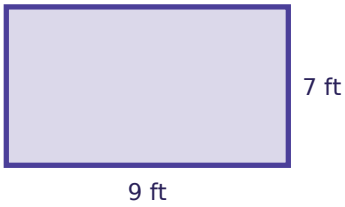

Task card 15 Thanksgiving Math

Ben eats $\frac{6}{10}$ of a pumpkin pie. Sam eats $\frac{1}{10}$ of it. What fraction of the pumpkin pie did they eat together?

Task card 16 Thanksgiving Math

There are 44 rolls. Each basket holds 9. After filling as many baskets as possible, how many rolls are left over?

Task card 17 Thanksgiving Math

Zoe eats $\frac{1}{10}$ of a pumpkin pie. Omar eats $\frac{6}{10}$ of it. What fraction of the pumpkin pie did they eat together?

Task card 18 Thanksgiving Math

Each basket holds 13 rolls. The bakery fills 49 baskets. How many rolls is that?

Task card 19 Thanksgiving Math

Ava sews ribbon all the way around a rectangular tablecloth that is 6 feet long and 3 feet wide. How many feet of ribbon does Ava need?

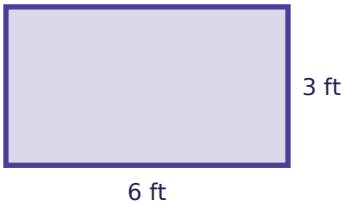

Task card 20 Thanksgiving Math

There are 94 rolls. Each basket holds 9. How many baskets can be filled all the way?

Task card 21 Thanksgiving Math

Ella eats $\frac{2}{12}$ of a pumpkin pie. Zoe eats $\frac{3}{12}$ of it. What fraction of the pumpkin pie did they eat together?

Task card 22 Thanksgiving Math

Each basket holds 17 cranberry tarts. The bakery fills 29 baskets. How many cranberry tarts is that?

Task card 23 Thanksgiving Math

There are 84 cranberry tarts. Each basket holds 5. After filling as many baskets as possible, how many cranberry tarts are left over?

Task card 24 Thanksgiving Math

Sam sews ribbon all the way around a rectangular tablecloth that is 12 feet long and 6 feet wide. How many feet of ribbon does Sam need?

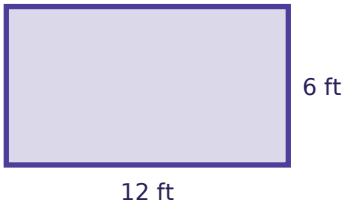

Thanksgiving Math Task Cards

Recording sheet · Grade 4 · Read each story and solve.

Name: _____ Date: _____

Scan to check your answers

1	2	3	4
5	6	7	8
9	10	11	12
13	14	15	16
17	18	19	20
21	22	23	24

Thanksgiving Math Task Cards: Answer Key

Grade 4 · Hard

The answers online

1. 44	**2.** $\frac{7}{8}$	**3.** 17
4. 1691	**5.** 1	**6.** $\frac{5}{12}$
7. 1656	**8.** 28	**9.** $\frac{5}{9}$
10. 264	**11.** 2	**12.** 38
13. 936	**14.** 32	**15.** $\frac{7}{10}$
16. 8	**17.** $\frac{7}{10}$	**18.** 637
19. 18	**20.** 10	**21.** $\frac{5}{12}$
22. 493	**23.** 4	**24.** 36