**Task card 1** Thanksgiving Math

There are 23 rolls. Each basket holds 3. After filling as many baskets as possible, how many rolls are left over?

**Task card 2** Thanksgiving Math

Each basket holds 6 corn muffins. The bakery fills 51 baskets. How many corn muffins is that?

**Task card 3** Thanksgiving Math

Mia eats $\frac{2}{9}$ of a pumpkin pie. Zoe eats $\frac{5}{9}$ of it. What fraction of the pumpkin pie did they eat together?

**Task card 4** Thanksgiving Math

Omar sews ribbon all the way around a rectangular tablecloth that is 8 feet long and 3 feet wide. How many feet of ribbon does Omar need?

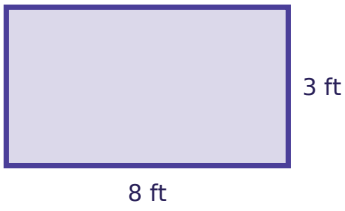


**Task card 5** Thanksgiving Math

Noah eats $\frac{2}{8}$ of a pumpkin pie. Ella eats $\frac{3}{8}$ of it. What fraction of the pumpkin pie did they eat together?

**Task card 6** Thanksgiving Math

There are 54 corn muffins. Each basket holds 5. How many baskets can be filled all the way?

**Task card 7** Thanksgiving Math

Each basket holds 6 rolls. The bakery fills 47 baskets. How many rolls is that?

**Task card 8** Thanksgiving Math

Ella sews ribbon all the way around a rectangular tablecloth that is 4 feet long and 2 feet wide. How many feet of ribbon does Ella need?

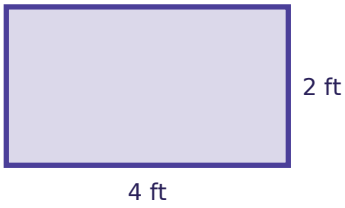


**Task card 9** Thanksgiving Math

Ava sews ribbon all the way around a rectangular tablecloth that is 6 feet long and 4 feet wide. How many feet of ribbon does Ava need?

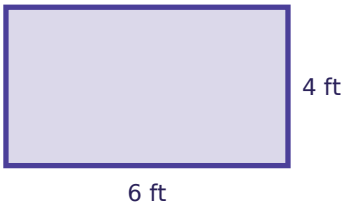


**Task card 10** Thanksgiving Math

There are 101 rolls. Each basket holds 9. After filling as many baskets as possible, how many rolls are left over?

**Task card 11** Thanksgiving Math

Leo eats $\frac{2}{8}$ of a pumpkin pie. Lily eats $\frac{3}{8}$ of it. What fraction of the pumpkin pie did they eat together?

**Task card 12** Thanksgiving Math

Sam eats $\frac{3}{12}$ of a pumpkin pie. Ava eats $\frac{8}{12}$ of it. What fraction of the pumpkin pie did they eat together?

**Task card 13** Thanksgiving Math

Lily sews ribbon all the way around a rectangular tablecloth that is 6 feet long and 2 feet wide. How many feet of ribbon does Lily need?

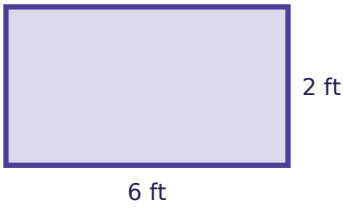


**Task card 14** Thanksgiving Math

Each basket holds 8 cranberry tarts. The bakery fills 56 baskets. How many cranberry tarts is that?

**Task card 15** Thanksgiving Math

Each basket holds 8 rolls. The bakery fills 59 baskets. How many rolls is that?

**Task card 16** Thanksgiving Math

There are 74 rolls. Each basket holds 5. How many baskets can be filled all the way?

**Task card 17** Thanksgiving Math

Each basket holds 17 rolls. The bakery fills 57 baskets. How many rolls is that?

**Task card 18** Thanksgiving Math

There are 37 corn muffins. Each basket holds 4. After filling as many baskets as possible, how many corn muffins are left over?

**Task card 19** Thanksgiving Math

Mia sews ribbon all the way around a rectangular tablecloth that is 11 feet long and 7 feet wide. How many feet of ribbon does Mia need?

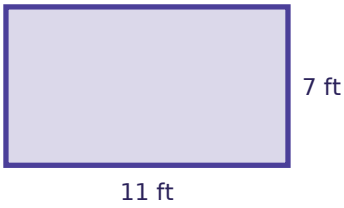


**Task card 20** Thanksgiving Math

Mia eats $\frac{4}{10}$ of a pumpkin pie. Ben eats $\frac{3}{10}$ of it. What fraction of the pumpkin pie did they eat together?

**Task card 21** Thanksgiving Math

There are 91 corn muffins. Each basket holds 8. After filling as many baskets as possible, how many corn muffins are left over?

**Task card 22** Thanksgiving Math

Ben sews ribbon all the way around a rectangular tablecloth that is 4 feet long and 3 feet wide. How many feet of ribbon does Ben need?




**Task card 23** Thanksgiving Math

Sam eats $\frac{1}{12}$ of a pumpkin pie. Ava eats $\frac{6}{12}$ of it. What fraction of the pumpkin pie did they eat together?

**Task card 24** Thanksgiving Math

Each basket holds 14 corn muffins. The bakery fills 16 baskets. How many corn muffins is that?

# Thanksgiving Math Task Cards

Recording sheet · Grade 4 · Read each story and solve.

Name: _____ Date: _____

Scan to check your answers

| | | | |
|---|---|---|---|
| 1 | 2 | 3 | 4 |
| 5 | 6 | 7 | 8 |
| 9 | 10 | 11 | 12 |
| 13 | 14 | 15 | 16 |
| 17 | 18 | 19 | 20 |
| 21 | 22 | 23 | 24 |

# Thanksgiving Math Task Cards: Answer Key

Grade 4 · Medium

The answers online

| | | |
|---|---|---|
| **1.** 2 | **2.** 306 | **3.** $\frac{7}{9}$ |
| **4.** 22 | **5.** $\frac{5}{8}$ | **6.** 10 |
| **7.** 282 | **8.** 12 | **9.** 20 |
| **10.** 2 | **11.** $\frac{5}{8}$ | **12.** $\frac{11}{12}$ |
| **13.** 16 | **14.** 448 | **15.** 472 |
| **16.** 14 | **17.** 969 | **18.** 1 |
| **19.** 36 | **20.** $\frac{7}{10}$ | **21.** 3 |
| **22.** 14 | **23.** $\frac{7}{12}$ | **24.** 224 |