Thanksgiving Math · 1

There are 23 rolls. Each basket holds 3. After filling as many baskets as possible, how many rolls are left over?

Thanksgiving Math · 2

Each basket holds 6 corn muffins. The bakery fills 51 baskets. How many corn muffins is that?

Thanksgiving Math · 3

Mia eats $\frac{2}{9}$ of a pumpkin pie. Zoe eats $\frac{5}{9}$ of it. What fraction of the pumpkin pie did they eat together?

Thanksgiving Math · 4

Omar sews ribbon all the way around a rectangular tablecloth that is 8 feet long and 3 feet wide. How many feet of ribbon does Omar need?

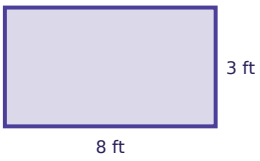


Thanksgiving Math · 5

Noah eats $\frac{2}{8}$ of a pumpkin pie. Ella eats $\frac{3}{8}$ of it. What fraction of the pumpkin pie did they eat together?

Thanksgiving Math · 6

There are 54 corn muffins. Each basket holds 5. How many baskets can be filled all the way?

Thanksgiving Math · 7

Each basket holds 6 rolls. The bakery fills 47 baskets. How many rolls is that?

Thanksgiving Math · 8

Ella sews ribbon all the way around a rectangular tablecloth that is 4 feet long and 2 feet wide. How many feet of ribbon does Ella need?

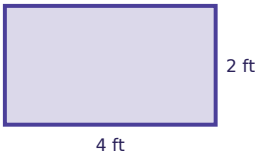

Thanksgiving Math · 2

**ANSWER**

**306**

Thanksgiving Math · 1

**ANSWER**

**2**

Thanksgiving Math · 4

**ANSWER**

**22**

Thanksgiving Math · 3

**ANSWER**

$\frac{7}{9}$

Thanksgiving Math · 6

**ANSWER**

**10**

Thanksgiving Math · 5

**ANSWER**

$\frac{5}{8}$

Thanksgiving Math · 8

**ANSWER**

**12**

Thanksgiving Math · 7

**ANSWER**

**282**

Thanksgiving Math · 9

Ava sews ribbon all the way around a rectangular tablecloth that is 6 feet long and 4 feet wide. How many feet of ribbon does Ava need?

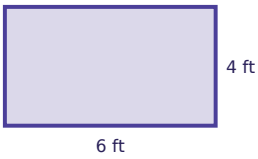


Thanksgiving Math · 10

There are 101 rolls. Each basket holds 9. After filling as many baskets as possible, how many rolls are left over?

Thanksgiving Math · 11

Leo eats $\frac{2}{8}$ of a pumpkin pie. Lily eats $\frac{3}{8}$ of it. What fraction of the pumpkin pie did they eat together?

Thanksgiving Math · 12

Sam eats $\frac{3}{12}$ of a pumpkin pie. Ava eats $\frac{8}{12}$ of it. What fraction of the pumpkin pie did they eat together?

Thanksgiving Math · 13

Lily sews ribbon all the way around a rectangular tablecloth that is 6 feet long and 2 feet wide. How many feet of ribbon does Lily need?




Thanksgiving Math · 14

Each basket holds 8 cranberry tarts. The bakery fills 56 baskets. How many cranberry tarts is that?

Thanksgiving Math · 15

Each basket holds 8 rolls. The bakery fills 59 baskets. How many rolls is that?

Thanksgiving Math · 16

There are 74 rolls. Each basket holds 5. How many baskets can be filled all the way?

Thanksgiving Math · 10

**ANSWER**

**2**

Thanksgiving Math · 9

**ANSWER**

**20**

Thanksgiving Math · 12

**ANSWER**

$$\frac{11}{12}$$

Thanksgiving Math · 11

**ANSWER**

$$\frac{5}{8}$$

Thanksgiving Math · 14

**ANSWER**

**448**

Thanksgiving Math · 13

**ANSWER**

**16**

Thanksgiving Math · 16

**ANSWER**

**14**

Thanksgiving Math · 15

**ANSWER**

**472**

Thanksgiving Math · 17

Each basket holds 17 rolls. The bakery fills 57 baskets. How many rolls is that?

Thanksgiving Math · 18

There are 37 corn muffins. Each basket holds 4. After filling as many baskets as possible, how many corn muffins are left over?

Thanksgiving Math · 19

Mia sews ribbon all the way around a rectangular tablecloth that is 11 feet long and 7 feet wide. How many feet of ribbon does Mia need?




Thanksgiving Math · 20

Mia eats $\frac{4}{10}$ of a pumpkin pie. Ben eats $\frac{3}{10}$ of it. What fraction of the pumpkin pie did they eat together?

Thanksgiving Math · 21

There are 91 corn muffins. Each basket holds 8. After filling as many baskets as possible, how many corn muffins are left over?

Thanksgiving Math · 22

Ben sews ribbon all the way around a rectangular tablecloth that is 4 feet long and 3 feet wide. How many feet of ribbon does Ben need?




Thanksgiving Math · 23

Sam eats $\frac{1}{12}$ of a pumpkin pie. Ava eats $\frac{6}{12}$ of it. What fraction of the pumpkin pie did they eat together?

Thanksgiving Math · 24

Each basket holds 14 corn muffins. The bakery fills 16 baskets. How many corn muffins is that?

Thanksgiving Math · 18

**ANSWER**

**1**

Thanksgiving Math · 17

**ANSWER**

**969**

Thanksgiving Math · 20

**ANSWER**

$$\frac{7}{10}$$

Thanksgiving Math · 19

**ANSWER**

**36**

Thanksgiving Math · 22

**ANSWER**

**14**

Thanksgiving Math · 21

**ANSWER**

**3**

Thanksgiving Math · 24

**ANSWER**

**224**

Thanksgiving Math · 23

**ANSWER**

$$\frac{7}{12}$$