Thanksgiving Math · 1

There are 23 rolls. Each basket holds 3. After filling as many baskets as possible, how many rolls are left over?

Thanksgiving Math · 2

Each basket holds 6 corn muffins. The bakery fills 51 baskets. How many corn muffins is that?

Thanksgiving Math · 3

Mia eats $\frac{2}{9}$ of a pumpkin pie. Zoe eats $\frac{5}{9}$ of it. What fraction of the pumpkin pie did they eat together?

Thanksgiving Math · 4

Omar sews ribbon all the way around a rectangular tablecloth that is 8 feet long and 3 feet wide. How many feet of ribbon does Omar need?

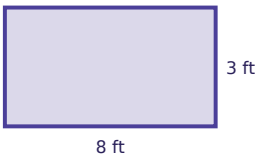

Thanksgiving Math · 5

Noah eats $\frac{2}{8}$ of a pumpkin pie. Ella eats $\frac{3}{8}$ of it. What fraction of the pumpkin pie did they eat together?

Thanksgiving Math · 6

There are 54 corn muffins. Each basket holds 5. How many baskets can be filled all the way?

Thanksgiving Math · 7

Each basket holds 6 rolls. The bakery fills 47 baskets. How many rolls is that?

Thanksgiving Math · 8

Ella sews ribbon all the way around a rectangular tablecloth that is 4 feet long and 2 feet wide. How many feet of ribbon does Ella need?

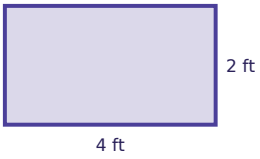

Thanksgiving Math · 2

ANSWER

306

Thanksgiving Math · 1

ANSWER

2

Thanksgiving Math · 4

ANSWER

22

Thanksgiving Math · 3

ANSWER

$\frac{7}{9}$

Thanksgiving Math · 6

ANSWER

10

Thanksgiving Math · 5

ANSWER

$\frac{5}{8}$

Thanksgiving Math · 8

ANSWER

12

Thanksgiving Math · 7

ANSWER

282

Thanksgiving Math · 9

Ava sews ribbon all the way around a rectangular tablecloth that is 6 feet long and 4 feet wide. How many feet of ribbon does Ava need?

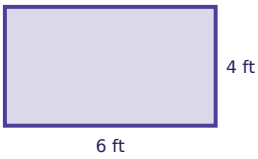

Thanksgiving Math · 10

There are 101 rolls. Each basket holds 9. After filling as many baskets as possible, how many rolls are left over?

Thanksgiving Math · 11

Leo eats $\frac{2}{8}$ of a pumpkin pie. Lily eats $\frac{3}{8}$ of it. What fraction of the pumpkin pie did they eat together?

Thanksgiving Math · 12

Sam eats $\frac{3}{12}$ of a pumpkin pie. Ava eats $\frac{8}{12}$ of it. What fraction of the pumpkin pie did they eat together?

Thanksgiving Math · 13

Lily sews ribbon all the way around a rectangular tablecloth that is 6 feet long and 2 feet wide. How many feet of ribbon does Lily need?



Thanksgiving Math · 14

Each basket holds 8 cranberry tarts. The bakery fills 56 baskets. How many cranberry tarts is that?

Thanksgiving Math · 15

Each basket holds 8 rolls. The bakery fills 59 baskets. How many rolls is that?

Thanksgiving Math · 16

There are 74 rolls. Each basket holds 5. How many baskets can be filled all the way?

Thanksgiving Math · 10

ANSWER

2

Thanksgiving Math · 9

ANSWER

20

Thanksgiving Math · 12

ANSWER

$$\frac{11}{12}$$

Thanksgiving Math · 11

ANSWER

$$\frac{5}{8}$$

Thanksgiving Math · 14

ANSWER

448

Thanksgiving Math · 13

ANSWER

16

Thanksgiving Math · 16

ANSWER

14

Thanksgiving Math · 15

ANSWER

472

Thanksgiving Math · 17

Each basket holds 17 rolls. The bakery fills 57 baskets. How many rolls is that?

Thanksgiving Math · 18

There are 37 corn muffins. Each basket holds 4. After filling as many baskets as possible, how many corn muffins are left over?

Thanksgiving Math · 19

Mia sews ribbon all the way around a rectangular tablecloth that is 11 feet long and 7 feet wide. How many feet of ribbon does Mia need?



Thanksgiving Math · 20

Mia eats $\frac{4}{10}$ of a pumpkin pie. Ben eats $\frac{3}{10}$ of it. What fraction of the pumpkin pie did they eat together?

Thanksgiving Math · 21

There are 91 corn muffins. Each basket holds 8. After filling as many baskets as possible, how many corn muffins are left over?

Thanksgiving Math · 22

Ben sews ribbon all the way around a rectangular tablecloth that is 4 feet long and 3 feet wide. How many feet of ribbon does Ben need?



Thanksgiving Math · 23

Sam eats $\frac{1}{12}$ of a pumpkin pie. Ava eats $\frac{6}{12}$ of it. What fraction of the pumpkin pie did they eat together?

Thanksgiving Math · 24

Each basket holds 14 corn muffins. The bakery fills 16 baskets. How many corn muffins is that?

Thanksgiving Math · 18

ANSWER

1

Thanksgiving Math · 17

ANSWER

969

Thanksgiving Math · 20

ANSWER

$$\frac{7}{10}$$

Thanksgiving Math · 19

ANSWER

36

Thanksgiving Math · 22

ANSWER

14

Thanksgiving Math · 21

ANSWER

3

Thanksgiving Math · 24

ANSWER

224

Thanksgiving Math · 23

ANSWER

$$\frac{7}{12}$$