Thanksgiving Math · 1

Noah eats $\frac{1}{5}$ of a pumpkin pie. Sam eats $\frac{1}{5}$ of it. What fraction of the pumpkin pie did they eat together?

Thanksgiving Math · 2

There are 31 cranberry tarts. Each basket holds 4. After filling as many baskets as possible, how many cranberry tarts are left over?

Thanksgiving Math · 3

Sam sews ribbon all the way around a rectangular tablecloth that is 6 feet long and 5 feet wide. How many feet of ribbon does Sam need?

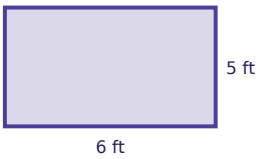

Thanksgiving Math · 4

Each basket holds 4 corn muffins. The bakery fills 21 baskets. How many corn muffins is that?

Thanksgiving Math · 5

Lily eats $\frac{1}{5}$ of a pumpkin pie. Ava eats $\frac{3}{5}$ of it. What fraction of the pumpkin pie did they eat together?

Thanksgiving Math · 6

There are 37 corn muffins. Each basket holds 8. How many baskets can be filled all the way?

Thanksgiving Math · 7

Lily sews ribbon all the way around a rectangular tablecloth that is 6 feet long and 3 feet wide. How many feet of ribbon does Lily need?

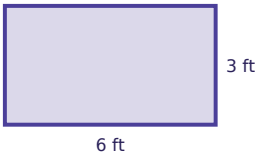

Thanksgiving Math · 8

Each basket holds 9 corn muffins. The bakery fills 14 baskets. How many corn muffins is that?

Thanksgiving Math · 2

ANSWER

3

Thanksgiving Math · 1

ANSWER

$$\frac{2}{5}$$

Thanksgiving Math · 4

ANSWER

84

Thanksgiving Math · 3

ANSWER

22

Thanksgiving Math · 6

ANSWER

4

Thanksgiving Math · 5

ANSWER

$$\frac{4}{5}$$

Thanksgiving Math · 8

ANSWER

126

Thanksgiving Math · 7

ANSWER

18

Thanksgiving Math · 9

Ava sews ribbon all the way around a rectangular tablecloth that is 6 feet long and 4 feet wide. How many feet of ribbon does Ava need?

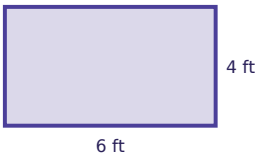

Thanksgiving Math · 10

There are 17 rolls. Each basket holds 4. How many baskets can be filled all the way?

Thanksgiving Math · 11

Each basket holds 7 corn muffins. The bakery fills 14 baskets. How many corn muffins is that?

Thanksgiving Math · 12

Omar eats $\frac{2}{7}$ of a pumpkin pie. Ava eats $\frac{1}{7}$ of it. What fraction of the pumpkin pie did they eat together?

Thanksgiving Math · 13

Ava eats $\frac{2}{8}$ of a pumpkin pie. Zoe eats $\frac{3}{8}$ of it. What fraction of the pumpkin pie did they eat together?

Thanksgiving Math · 14

There are 31 rolls. Each basket holds 6. How many baskets can be filled all the way?

Thanksgiving Math · 15

Each basket holds 8 rolls. The bakery fills 15 baskets. How many rolls is that?

Thanksgiving Math · 16

Ava sews ribbon all the way around a rectangular tablecloth that is 4 feet long and 3 feet wide. How many feet of ribbon does Ava need?

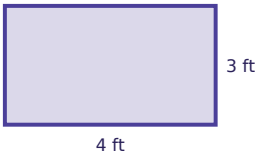

Thanksgiving Math · 10

ANSWER

4

Thanksgiving Math · 9

ANSWER

20

Thanksgiving Math · 12

ANSWER

$$\frac{3}{7}$$

Thanksgiving Math · 11

ANSWER

98

Thanksgiving Math · 14

ANSWER

5

Thanksgiving Math · 13

ANSWER

$$\frac{5}{8}$$

Thanksgiving Math · 16

ANSWER

14

Thanksgiving Math · 15

ANSWER

120

Thanksgiving Math · 17

Zoe eats $\frac{5}{7}$ of a pumpkin pie. Omar eats $\frac{1}{7}$ of it. What fraction of the pumpkin pie did they eat together?

Thanksgiving Math · 18

Each basket holds 4 corn muffins. The bakery fills 50 baskets. How many corn muffins is that?

Thanksgiving Math · 19

Zoe sews ribbon all the way around a rectangular tablecloth that is 5 feet long and 4 feet wide. How many feet of ribbon does Zoe need?



Thanksgiving Math · 20

Noah sews ribbon all the way around a rectangular tablecloth that is 5 feet long and 4 feet wide. How many feet of ribbon does Noah need?



Thanksgiving Math · 21

Each basket holds 8 cranberry tarts. The bakery fills 49 baskets. How many cranberry tarts is that?

Thanksgiving Math · 22

There are 27 corn muffins. Each basket holds 4. How many baskets can be filled all the way?

Thanksgiving Math · 23

There are 28 corn muffins. Each basket holds 6. How many baskets can be filled all the way?

Thanksgiving Math · 24

Mia eats $\frac{4}{7}$ of a pumpkin pie. Sam eats $\frac{1}{7}$ of it. What fraction of the pumpkin pie did they eat together?

Thanksgiving Math · 18

ANSWER

200

Thanksgiving Math · 17

ANSWER

$\frac{6}{7}$

Thanksgiving Math · 20

ANSWER

18

Thanksgiving Math · 19

ANSWER

18

Thanksgiving Math · 22

ANSWER

6

Thanksgiving Math · 21

ANSWER

392

Thanksgiving Math · 24

ANSWER

$\frac{5}{7}$

Thanksgiving Math · 23

ANSWER

4