Task card 1 Fractions with Denominators 10 & 1...

What part of the grid is shaded?

$$\frac{\quad}{100}$$

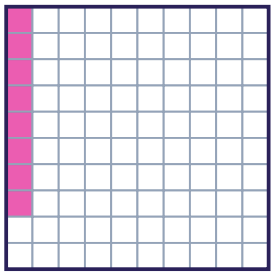

Task card 2 Fractions with Denominators 10 & 1...

$$\frac{6}{10} = \frac{\quad}{100}$$

Task card 3 Fractions with Denominators 10 & 1...

$$\frac{10}{100} + \frac{7}{10} = \frac{\quad}{100}$$

Task card 4 Fractions with Denominators 10 & 1...

$$\frac{30}{100} = \frac{\quad}{10}$$

Task card 5 Fractions with Denominators 10 & 1...

What part of the grid is shaded?

$$\frac{\quad}{100}$$



Task card 6 Fractions with Denominators 10 & 1...

$$\frac{1}{10} = \frac{\quad}{100}$$

Task card 7 Fractions with Denominators 10 & 1...

$$\frac{1}{100} + \frac{7}{10} = \frac{__}{100}$$

Task card 8 Fractions with Denominators 10 & 1...

$$\frac{20}{100} = \frac{__}{10}$$

Task card 9 Fractions with Denominators 10 & 1...

$$\frac{7}{100} + \frac{8}{10} = \frac{__}{100}$$

Task card 10 Fractions with Denominators 10 & 1...

$\frac{9}{10}$ written as a decimal is ___

Task card 11 Fractions with Denominators 10 & 1...

$$0.19 = \frac{__}{100}$$

Task card 12 Fractions with Denominators 10 & 1...

What part of the grid is shaded?

$\frac{__}{100}$

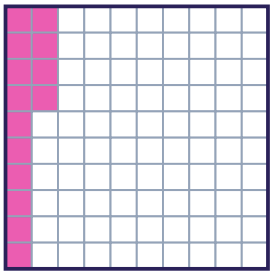

Task card 13 Fractions with Denominators 10 & 1...

$$\frac{4}{10} + \frac{17}{100} = \frac{__}{100}$$

Task card 14 Fractions with Denominators 10 & 1...

$\frac{38}{100}$ written as a decimal

is ___

Task card 15 Fractions with Denominators 10 & 1...

$$0.94 = \frac{__}{100}$$

Task card 16 Fractions with Denominators 10 & 1...

What part of the grid is shaded?

$\frac{__}{100}$

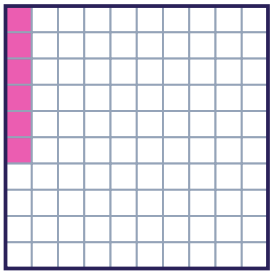

Task card 17 Fractions with Denominators 10 & 1...

$$\frac{2}{10} + \frac{14}{100} = \frac{__}{100}$$

Task card 18 Fractions with Denominators 10 & 1...

$\frac{35}{100}$ written as a decimal

is ___

Task card 19 Fractions with Denominators 10 & 1...

$$0.75 = \frac{\quad}{100}$$

Task card 20 Fractions with Denominators 10 & 1...

What part of the grid is shaded?

$$\frac{\quad}{100}$$



Task card 21 Fractions with Denominators 10 & 1...

$$\frac{73}{100} + \frac{2}{10} = \frac{\quad}{100}$$

Task card 22 Fractions with Denominators 10 & 1...

$$0.78 = \frac{\quad}{100}$$

Task card 23 Fractions with Denominators 10 & 1...

What part of the grid is shaded?

$$\frac{\quad}{100}$$



Task card 24 Fractions with Denominators 10 & 1...

What part of the grid is shaded?

$$\frac{\quad}{100}$$



Fractions with Denominators 10 & 100 Task Cards

Recording sheet · Grade 4 · Fill in each blank.

Scan to check your answers

Name: _____ Date: _____

1	2	3	4
5	6	7	8
9	10	11	12
13	14	15	16
17	18	19	20
21	22	23	24

Fractions with Denominators 10 & 100 Task Cards: Answer Key

Grade 4 · Medium

The answers online

1. 8	**2.** 60	**3.** 80
4. 3	**5.** 90	**6.** 10
7. 71	**8.** 2	**9.** 87
10. 0.9	**11.** 19	**12.** 14
13. 57	**14.** 0.38	**15.** 94
16. 6	**17.** 34	**18.** 0.35
19. 75	**20.** 53	**21.** 93
22. 78	**23.** 31	**24.** 21