Task card 1 Fractions with Denominators 10 & 1...

What part of the grid is shaded?

$$\frac{\quad}{100}$$



Task card 2 Fractions with Denominators 10 & 1...

$$\frac{9}{10} = \frac{\quad}{100}$$

Task card 3 Fractions with Denominators 10 & 1...

Each column is one tenth. What part of the grid is shaded? $\frac{\quad}{10}$



Task card 4 Fractions with Denominators 10 & 1...

$$\frac{20}{100} = \frac{\quad}{10}$$

Task card 5 Fractions with Denominators 10 & 1...

What part of the grid is shaded?

$$\frac{\quad}{100}$$



Task card 6 Fractions with Denominators 10 & 1...

$$\frac{5}{10} = \frac{\quad}{100}$$

Task card 7 Fractions with Denominators 10 & 1...

Each column is one tenth. What part of the grid is shaded? $\frac{\quad}{10}$



Task card 8 Fractions with Denominators 10 & 1...

$$\frac{90}{100} = \frac{\quad}{10}$$

Task card 9 Fractions with Denominators 10 & 1...

What part of the grid is shaded?

$\frac{\quad}{100}$



Task card 10 Fractions with Denominators 10 & 1...

Each column is one tenth. What part of the grid is shaded? $\frac{\quad}{10}$



Task card 11 Fractions with Denominators 10 & 1...

$$\frac{50}{100} = \frac{\quad}{10}$$

Task card 12 Fractions with Denominators 10 & 1...

What part of the grid is shaded?

$\frac{\quad}{100}$



Task card 13 Fractions with Denominators 10 & 1...

$$\frac{3}{10} = \frac{\quad}{100}$$

Task card 14 Fractions with Denominators 10 & 1...

$$\frac{80}{100} = \frac{\quad}{10}$$

Task card 15 Fractions with Denominators 10 & 1...

What part of the grid is shaded?

$$\frac{\quad}{100}$$



Task card 16 Fractions with Denominators 10 & 1...

$$\frac{3}{10} + \frac{4}{100} = \frac{\quad}{100}$$

Task card 17 Fractions with Denominators 10 & 1...

$$\frac{10}{100} = \frac{\quad}{10}$$

Task card 18 Fractions with Denominators 10 & 1...

What part of the grid is shaded?

$$\frac{\quad}{100}$$

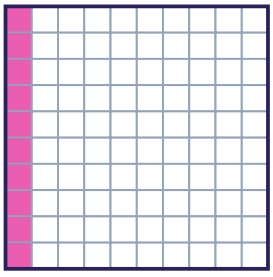

Task card 19 Fractions with Denominators 10 & 1...

$$\frac{6}{10} = \frac{\quad}{100}$$

Task card 20 Fractions with Denominators 10 & 1...

$$\frac{3}{100} + \frac{4}{10} = \frac{\quad}{100}$$

Task card 21 Fractions with Denominators 10 & 1...

$$\frac{60}{100} = \frac{\quad}{10}$$

Task card 22 Fractions with Denominators 10 & 1...

What part of the grid is shaded?

$$\frac{\quad}{100}$$



Task card 23 Fractions with Denominators 10 & 1...

$$\frac{7}{10} = \frac{\quad}{100}$$

Task card 24 Fractions with Denominators 10 & 1...

Each column is one tenth. What part of the grid is shaded? $\frac{\quad}{10}$



Fractions with Denominators 10 & 100 Task Cards

Recording sheet · Grade 4 · Fill in each blank.

Scan to check your answers

Name: _____ Date: _____

1	2	3	4
5	6	7	8
9	10	11	12
13	14	15	16
17	18	19	20
21	22	23	24

Fractions with Denominators 10 & 100 Task Cards: Answer Key

Grade 4 · Easy

The answers online

1. 25	**2.** 90	**3.** 8
4. 2	**5.** 54	**6.** 50
7. 9	**8.** 9	**9.** 94
10. 4	**11.** 5	**12.** 60
13. 30	**14.** 8	**15.** 65
16. 34	**17.** 1	**18.** 10
19. 60	**20.** 43	**21.** 6
22. 90	**23.** 70	**24.** 1