Fractions with Denominators 10 & 100 · 1

What part of the grid is $\frac{\quad}{100}$ shaded?

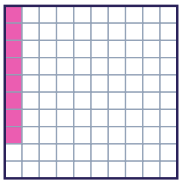

Fractions with Denominators 10 & 100 · 2

$$\frac{6}{10} = \frac{\quad}{100}$$

Fractions with Denominators 10 & 100 · 3

$$\frac{10}{100} + \frac{7}{10} = \frac{\quad}{100}$$

Fractions with Denominators 10 & 100 · 4

$$\frac{30}{100} = \frac{\quad}{10}$$

Fractions with Denominators 10 & 100 · 5

What part of the grid is $\frac{\quad}{100}$ shaded?



Fractions with Denominators 10 & 100 · 6

$$\frac{1}{10} = \frac{\quad}{100}$$

Fractions with Denominators 10 & 100 · 7

$$\frac{1}{100} + \frac{7}{10} = \frac{\quad}{100}$$

Fractions with Denominators 10 & 100 · 8

$$\frac{20}{100} = \frac{\quad}{10}$$

Fractions with Denominators 10 & 100 · 2

ANSWER

60

Fractions with Denominators 10 & 100 · 1

ANSWER

8

Fractions with Denominators 10 & 100 · 4

ANSWER

3

Fractions with Denominators 10 & 100 · 3

ANSWER

80

Fractions with Denominators 10 & 100 · 6

ANSWER

10

Fractions with Denominators 10 & 100 · 5

ANSWER

90

Fractions with Denominators 10 & 100 · 8

ANSWER

2

Fractions with Denominators 10 & 100 · 7

ANSWER

71

Fractions with Denominators 10 & 100 · 9

$\frac{7}{100} + \frac{8}{10} = \frac{__}{100}$

Fractions with Denominators 10 & 100 · 10

$\frac{9}{10}$ written as a decimal is ___

Fractions with Denominators 10 & 100 · 11

$0.19 = \frac{__}{100}$

Fractions with Denominators 10 & 100 · 12

What part of the grid is shaded? $\frac{__}{100}$



Fractions with Denominators 10 & 100 · 13

$\frac{4}{10} + \frac{17}{100} = \frac{__}{100}$

Fractions with Denominators 10 & 100 · 14

$\frac{38}{100}$ written as a decimal is ___

Fractions with Denominators 10 & 100 · 15

$0.94 = \frac{__}{100}$

Fractions with Denominators 10 & 100 · 16

What part of the grid is shaded? $\frac{__}{100}$



Fractions with Denominators 10 & 100 · 10

ANSWER

0.9

Fractions with Denominators 10 & 100 · 9

ANSWER

87

Fractions with Denominators 10 & 100 · 12

ANSWER

14

Fractions with Denominators 10 & 100 · 11

ANSWER

19

Fractions with Denominators 10 & 100 · 14

ANSWER

0.38

Fractions with Denominators 10 & 100 · 13

ANSWER

57

Fractions with Denominators 10 & 100 · 16

ANSWER

6

Fractions with Denominators 10 & 100 · 15

ANSWER

94

$\frac{2}{10} + \frac{14}{100} = \frac{__}{100}$

$\frac{35}{100}$ written as a decimal is ___

$0.75 = \frac{__}{100}$

What part of the grid is shaded? $\frac{__}{100}$



$\frac{73}{100} + \frac{2}{10} = \frac{__}{100}$

$0.78 = \frac{__}{100}$

What part of the grid is shaded? $\frac{__}{100}$



What part of the grid is shaded? $\frac{__}{100}$



Fractions with Denominators 10 & 100 · 18

ANSWER

0.35

Fractions with Denominators 10 & 100 · 17

ANSWER

34

Fractions with Denominators 10 & 100 · 20

ANSWER

53

Fractions with Denominators 10 & 100 · 19

ANSWER

75

Fractions with Denominators 10 & 100 · 22

ANSWER

78

Fractions with Denominators 10 & 100 · 21

ANSWER

93

Fractions with Denominators 10 & 100 · 24

ANSWER

21

Fractions with Denominators 10 & 100 · 23

ANSWER

31