Fractions with Denominators 10 & 100 · 1

What part of the grid is $\frac{\quad}{100}$ shaded?

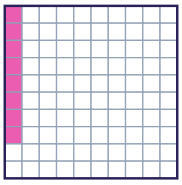

Fractions with Denominators 10 & 100 · 2

$$\frac{6}{10} = \frac{\quad}{100}$$

Fractions with Denominators 10 & 100 · 3

$$\frac{10}{100} + \frac{7}{10} = \frac{\quad}{100}$$

Fractions with Denominators 10 & 100 · 4

$$\frac{30}{100} = \frac{\quad}{10}$$

Fractions with Denominators 10 & 100 · 5

What part of the grid is $\frac{\quad}{100}$ shaded?



Fractions with Denominators 10 & 100 · 6

$$\frac{1}{10} = \frac{\quad}{100}$$

Fractions with Denominators 10 & 100 · 7

$$\frac{1}{100} + \frac{7}{10} = \frac{\quad}{100}$$

Fractions with Denominators 10 & 100 · 8

$$\frac{20}{100} = \frac{\quad}{10}$$

Fractions with Denominators 10 & 100 · 2

**ANSWER**

**60**

Fractions with Denominators 10 & 100 · 1

**ANSWER**

**8**

Fractions with Denominators 10 & 100 · 4

**ANSWER**

**3**

Fractions with Denominators 10 & 100 · 3

**ANSWER**

**80**

Fractions with Denominators 10 & 100 · 6

**ANSWER**

**10**

Fractions with Denominators 10 & 100 · 5

**ANSWER**

**90**

Fractions with Denominators 10 & 100 · 8

**ANSWER**

**2**

Fractions with Denominators 10 & 100 · 7

**ANSWER**

**71**

Fractions with Denominators 10 & 100 · 9

$\frac{7}{100} + \frac{8}{10} = \frac{__}{100}$

Fractions with Denominators 10 & 100 · 10

$\frac{9}{10}$ written as a decimal is ___

Fractions with Denominators 10 & 100 · 11

$0.19 = \frac{__}{100}$

Fractions with Denominators 10 & 100 · 12

What part of the grid is shaded? $\frac{__}{100}$



Fractions with Denominators 10 & 100 · 13

$\frac{4}{10} + \frac{17}{100} = \frac{__}{100}$

Fractions with Denominators 10 & 100 · 14

$\frac{38}{100}$ written as a decimal is ___

Fractions with Denominators 10 & 100 · 15

$0.94 = \frac{__}{100}$

Fractions with Denominators 10 & 100 · 16

What part of the grid is shaded? $\frac{__}{100}$



Fractions with Denominators 10 & 100 · 10

**ANSWER**

**0.9**

Fractions with Denominators 10 & 100 · 9

**ANSWER**

**87**

Fractions with Denominators 10 & 100 · 12

**ANSWER**

**14**

Fractions with Denominators 10 & 100 · 11

**ANSWER**

**19**

Fractions with Denominators 10 & 100 · 14

**ANSWER**

**0.38**

Fractions with Denominators 10 & 100 · 13

**ANSWER**

**57**

Fractions with Denominators 10 & 100 · 16

**ANSWER**

**6**

Fractions with Denominators 10 & 100 · 15

**ANSWER**

**94**

$\frac{2}{10} + \frac{14}{100} = \frac{__}{100}$



$\frac{35}{100}$ written as a decimal is ___



$0.75 = \frac{__}{100}$



What part of the grid is shaded? $\frac{__}{100}$





$\frac{73}{100} + \frac{2}{10} = \frac{__}{100}$



$0.78 = \frac{__}{100}$



What part of the grid is shaded? $\frac{__}{100}$





What part of the grid is shaded? $\frac{__}{100}$



Fractions with Denominators 10 & 100 · 18

**ANSWER**

**0.35**

Fractions with Denominators 10 & 100 · 17

**ANSWER**

**34**

Fractions with Denominators 10 & 100 · 20

**ANSWER**

**53**

Fractions with Denominators 10 & 100 · 19

**ANSWER**

**75**

Fractions with Denominators 10 & 100 · 22

**ANSWER**

**78**

Fractions with Denominators 10 & 100 · 21

**ANSWER**

**93**

Fractions with Denominators 10 & 100 · 24

**ANSWER**

**21**

Fractions with Denominators 10 & 100 · 23

**ANSWER**

**31**