Fractions with Denominators 10 & 100 · 1

What part of the grid is shaded? $\frac{\quad}{100}$



Fractions with Denominators 10 & 100 · 2

$$\frac{9}{10} = \frac{\quad}{100}$$

Fractions with Denominators 10 & 100 · 3

Each column is one tenth. What part of the grid is shaded? $\frac{\quad}{10}$

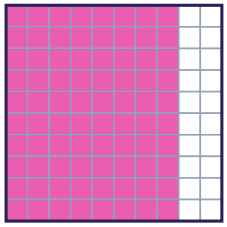

Fractions with Denominators 10 & 100 · 4

$$\frac{20}{100} = \frac{\quad}{10}$$

Fractions with Denominators 10 & 100 · 5

What part of the grid is shaded? $\frac{\quad}{100}$



Fractions with Denominators 10 & 100 · 6

$$\frac{5}{10} = \frac{\quad}{100}$$

Fractions with Denominators 10 & 100 · 7

Each column is one tenth. What part of the grid is shaded? $\frac{\quad}{10}$



Fractions with Denominators 10 & 100 · 8

$$\frac{90}{100} = \frac{\quad}{10}$$

Fractions with Denominators 10 & 100 · 2

ANSWER

90

Fractions with Denominators 10 & 100 · 1

ANSWER

25

Fractions with Denominators 10 & 100 · 4

ANSWER

2

Fractions with Denominators 10 & 100 · 3

ANSWER

8

Fractions with Denominators 10 & 100 · 6

ANSWER

50

Fractions with Denominators 10 & 100 · 5

ANSWER

54

Fractions with Denominators 10 & 100 · 8

ANSWER

9

Fractions with Denominators 10 & 100 · 7

ANSWER

9

Fractions with Denominators 10 & 100 · 9

What part of the grid is shaded? $\frac{\quad}{100}$



Fractions with Denominators 10 & 100 · 10

Each column is one tenth. What part of the grid is shaded? $\frac{\quad}{10}$



Fractions with Denominators 10 & 100 · 11

$$\frac{50}{100} = \frac{\quad}{10}$$

Fractions with Denominators 10 & 100 · 12

What part of the grid is shaded? $\frac{\quad}{100}$



Fractions with Denominators 10 & 100 · 13

$$\frac{3}{10} = \frac{\quad}{100}$$

Fractions with Denominators 10 & 100 · 14

$$\frac{80}{100} = \frac{\quad}{10}$$

Fractions with Denominators 10 & 100 · 15

What part of the grid is shaded? $\frac{\quad}{100}$



Fractions with Denominators 10 & 100 · 16

$$\frac{3}{10} + \frac{4}{100} = \frac{\quad}{100}$$

Fractions with Denominators 10 & 100 · 10

ANSWER

4

Fractions with Denominators 10 & 100 · 9

ANSWER

94

Fractions with Denominators 10 & 100 · 12

ANSWER

60

Fractions with Denominators 10 & 100 · 11

ANSWER

5

Fractions with Denominators 10 & 100 · 14

ANSWER

8

Fractions with Denominators 10 & 100 · 13

ANSWER

30

Fractions with Denominators 10 & 100 · 16

ANSWER

34

Fractions with Denominators 10 & 100 · 15

ANSWER

65

Fractions with Denominators 10 & 100 · 17

$$\frac{10}{100} = \frac{__}{10}$$

Fractions with Denominators 10 & 100 · 18

What part of the grid is shaded? $\frac{__}{100}$



Fractions with Denominators 10 & 100 · 19

$$\frac{6}{10} = \frac{__}{100}$$

Fractions with Denominators 10 & 100 · 20

$$\frac{3}{100} + \frac{4}{10} = \frac{__}{100}$$

Fractions with Denominators 10 & 100 · 21

$$\frac{60}{100} = \frac{__}{10}$$

Fractions with Denominators 10 & 100 · 22

What part of the grid is shaded? $\frac{__}{100}$



Fractions with Denominators 10 & 100 · 23

$$\frac{7}{10} = \frac{__}{100}$$

Fractions with Denominators 10 & 100 · 24

Each column is one tenth. What part of the grid is shaded? $\frac{__}{10}$

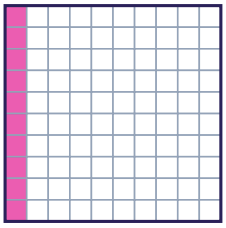

Fractions with Denominators 10 & 100 · 18

ANSWER

10

Fractions with Denominators 10 & 100 · 17

ANSWER

1

Fractions with Denominators 10 & 100 · 20

ANSWER

43

Fractions with Denominators 10 & 100 · 19

ANSWER

60

Fractions with Denominators 10 & 100 · 22

ANSWER

90

Fractions with Denominators 10 & 100 · 21

ANSWER

6

Fractions with Denominators 10 & 100 · 24

ANSWER

1

Fractions with Denominators 10 & 100 · 23

ANSWER

70