Task card 1 Summer Math

There are 122 cupcakes. Each picnic basket holds 6. How many picnic baskets can be filled all the way?

Task card 2 Summer Math

Sam eats $\frac{4}{8}$ of a watermelon. Omar eats $\frac{3}{8}$ of it. What fraction of the watermelon did they eat together?

Task card 3 Summer Math

Noah eats $\frac{2}{9}$ of a watermelon. Sam eats $\frac{2}{9}$ of it. What fraction of the watermelon did they eat together?

Task card 4 Summer Math

There are 83 lemon bars. Each picnic basket holds 4. After filling as many picnic baskets as possible, how many lemon bars are left over?

Task card 5 Summer Math

Each picnic basket holds 18 lemon bars. The bakery fills 38 picnic baskets. How many lemon bars is that?

Task card 6 Summer Math

A rectangular swimming pool is 6 feet long and 2 feet wide. Ava walks all the way around it once. How many feet does Ava walk?



Task card 7 Summer Math

A rectangular swimming pool is 10 feet long and 2 feet wide. Ava walks all the way around it once. How many feet does Ava walk?

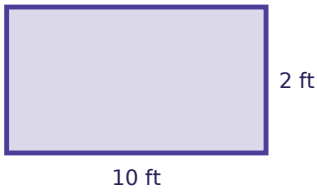

Task card 8 Summer Math

Each picnic basket holds 11 blueberry muffins. The bakery fills 17 picnic baskets. How many blueberry muffins is that?

Task card 9 Summer Math

Ava eats $\frac{3}{12}$ of a watermelon. Zoe eats $\frac{4}{12}$ of it. What fraction of the watermelon did they eat together?

Task card 10 Summer Math

Each picnic basket holds 18 cupcakes. The bakery fills 19 picnic baskets. How many cupcakes is that?

Task card 11 Summer Math

Sam eats $\frac{1}{9}$ of a watermelon. Lily eats $\frac{1}{9}$ of it. What fraction of the watermelon did they eat together?

Task card 12 Summer Math

There are 34 lemon bars. Each picnic basket holds 4. After filling as many picnic baskets as possible, how many lemon bars are left over?

Task card 13 Summer Math

A rectangular swimming pool is 8 feet long and 4 feet wide. Omar walks all the way around it once. How many feet does Omar walk?

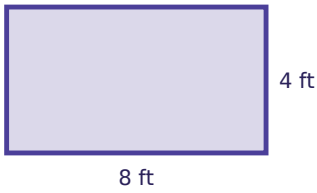

Task card 14 Summer Math

There are 18 blueberry muffins. Each picnic basket holds 4. After filling as many picnic baskets as possible, how many blueberry muffins are left over?

Task card 15 Summer Math

A rectangular swimming pool is 4 feet long and 3 feet wide. Ben walks all the way around it once. How many feet does Ben walk?

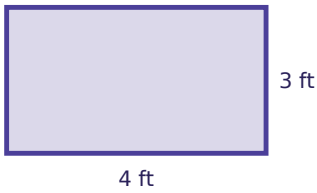

Task card 16 Summer Math

Each picnic basket holds 19 cupcakes. The bakery fills 78 picnic baskets. How many cupcakes is that?

Task card 17 Summer Math

Each picnic basket holds 16 cupcakes. The bakery fills 66 picnic baskets. How many cupcakes is that?

Task card 18 Summer Math

A rectangular swimming pool is 11 feet long and 4 feet wide. Sam walks all the way around it once. How many feet does Sam walk?

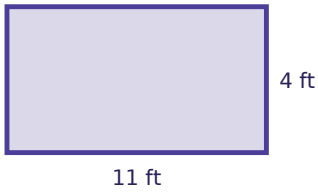

Task card 19 Summer Math

There are 62 lemon bars. Each picnic basket holds 4. How many picnic baskets can be filled all the way?

Task card 20 Summer Math

Zoe eats $\frac{5}{8}$ of a watermelon. Noah eats $\frac{2}{8}$ of it. What fraction of the watermelon did they eat together?

Task card 21 Summer Math

A rectangular swimming pool is 13 feet long and 9 feet wide. Lily walks all the way around it once. How many feet does Lily walk?

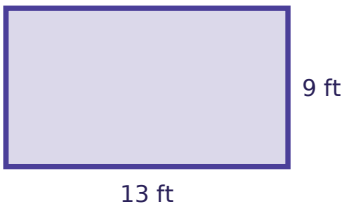

Task card 22 Summer Math

Zoe eats $\frac{4}{12}$ of a watermelon. Noah eats $\frac{1}{12}$ of it. What fraction of the watermelon did they eat together?

Task card 23 Summer Math

There are 41 blueberry muffins. Each picnic basket holds 5. After filling as many picnic baskets as possible, how many blueberry muffins are left over?

Task card 24 Summer Math

Each picnic basket holds 13 lemon bars. The bakery fills 28 picnic baskets. How many lemon bars is that?

Summer Math Task Cards

Recording sheet · Grade 4 · Read each story and solve.

Name: _____ Date: _____

Scan to check your answers

1	2	3	4
5	6	7	8
9	10	11	12
13	14	15	16
17	18	19	20
21	22	23	24

Summer Math Task Cards: Answer Key

Grade 4 · Hard

The answers online

1. 20	**2.** $\frac{7}{8}$	**3.** $\frac{4}{9}$
4. 3	**5.** 684	**6.** 16
7. 24	**8.** 187	**9.** $\frac{7}{12}$
10. 342	**11.** $\frac{2}{9}$	**12.** 2
13. 24	**14.** 2	**15.** 14
16. 1482	**17.** 1056	**18.** 30
19. 15	**20.** $\frac{7}{8}$	**21.** 44
22. $\frac{5}{12}$	**23.** 1	**24.** 364