Task card 1 Summer Math

A rectangular swimming pool is 7 feet long and 4 feet wide. Noah walks all the way around it once. How many feet does Noah walk?

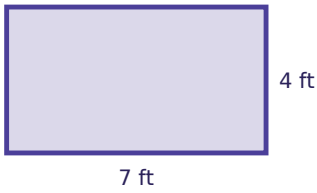

Task card 2 Summer Math

A rectangular swimming pool is 4 feet long and 3 feet wide. Ava walks all the way around it once. How many feet does Ava walk?

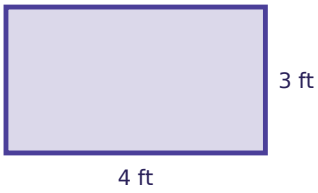

Task card 3 Summer Math

There are 55 blueberry muffins. Each picnic basket holds 6. How many picnic baskets can be filled all the way?

Task card 4 Summer Math

Each picnic basket holds 5 cupcakes. The bakery fills 50 picnic baskets. How many cupcakes is that?

Task card 5 Summer Math

Each picnic basket holds 9 blueberry muffins. The bakery fills 57 picnic baskets. How many blueberry muffins is that?

Task card 6 Summer Math

Lily eats $\frac{4}{9}$ of a watermelon. Ava eats $\frac{4}{9}$ of it. What fraction of the watermelon did they eat together?

Task card 7 Summer Math

Sam eats $\frac{1}{10}$ of a watermelon. Lily eats $\frac{2}{10}$ of it. What fraction of the watermelon did they eat together?

Task card 8 Summer Math

There are 103 blueberry muffins. Each picnic basket holds 7. How many picnic baskets can be filled all the way?

Task card 9 Summer Math

Mia eats $\frac{6}{12}$ of a watermelon. Noah eats $\frac{5}{12}$ of it. What fraction of the watermelon did they eat together?

Task card 10 Summer Math

A rectangular swimming pool is 6 feet long and 2 feet wide. Zoe walks all the way around it once. How many feet does Zoe walk?

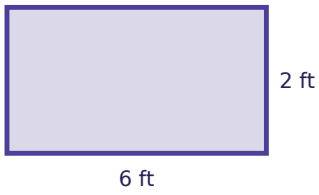

Task card 11 Summer Math

There are 41 cupcakes. Each picnic basket holds 3. How many picnic baskets can be filled all the way?

Task card 12 Summer Math

A rectangular swimming pool is 7 feet long and 4 feet wide. Omar walks all the way around it once. How many feet does Omar walk?

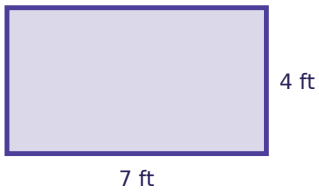

Task card 13 Summer Math

Each picnic basket holds 5 cupcakes. The bakery fills 57 picnic baskets. How many cupcakes is that?

Task card 14 Summer Math

Each picnic basket holds 8 blueberry muffins. The bakery fills 16 picnic baskets. How many blueberry muffins is that?

Task card 15 Summer Math

Ava eats $\frac{2}{10}$ of a watermelon. Lily eats $\frac{1}{10}$ of it. What fraction of the watermelon did they eat together?

Task card 16 Summer Math

There are 99 lemon bars. Each picnic basket holds 8. How many picnic baskets can be filled all the way?

Task card 17 Summer Math

Mia eats $\frac{2}{8}$ of a watermelon. Leo eats $\frac{1}{8}$ of it. What fraction of the watermelon did they eat together?

Task card 18 Summer Math

Each picnic basket holds 16 blueberry muffins. The bakery fills 74 picnic baskets. How many blueberry muffins is that?

Task card 19 Summer Math

Each picnic basket holds 15 lemon bars. The bakery fills 19 picnic baskets. How many lemon bars is that?

Task card 20 Summer Math

A rectangular swimming pool is 11 feet long and 2 feet wide. Ella walks all the way around it once. How many feet does Ella walk?

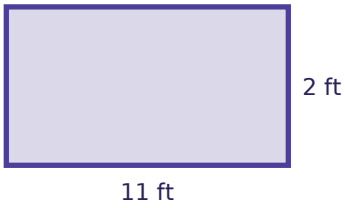

Task card 21 Summer Math

Noah eats $\frac{1}{10}$ of a watermelon. Sam eats $\frac{6}{10}$ of it. What fraction of the watermelon did they eat together?

Task card 22 Summer Math

There are 88 lemon bars. Each picnic basket holds 5. How many picnic baskets can be filled all the way?

Task card 23 Summer Math

There are 40 lemon bars. Each picnic basket holds 6. After filling as many picnic baskets as possible, how many lemon bars are left over?

Task card 24 Summer Math

A rectangular swimming pool is 8 feet long and 5 feet wide. Lily walks all the way around it once. How many feet does Lily walk?

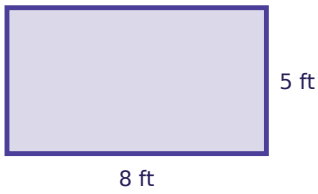

Summer Math Task Cards

Recording sheet · Grade 4 · Read each story and solve.

Name: _____ Date: _____

Scan to check your answers

1	2	3	4
5	6	7	8
9	10	11	12
13	14	15	16
17	18	19	20
21	22	23	24

Summer Math Task Cards: Answer Key

Grade 4 · Medium

The answers online

1. 22	**2.** 14	**3.** 9
4. 250	**5.** 513	**6.** $\frac{8}{9}$
7. $\frac{3}{10}$	**8.** 14	**9.** $\frac{11}{12}$
10. 16	**11.** 13	**12.** 22
13. 285	**14.** 128	**15.** $\frac{3}{10}$
16. 12	**17.** $\frac{3}{8}$	**18.** 1184
19. 285	**20.** 26	**21.** $\frac{7}{10}$
22. 17	**23.** 4	**24.** 26