**Task card 1** Summer Math

Each picnic basket holds 6 lemon bars. The bakery fills 16 picnic baskets. How many lemon bars is that?

**Task card 2** Summer Math

There are 46 cupcakes. Each picnic basket holds 8. After filling as many picnic baskets as possible, how many cupcakes are left over?

**Task card 3** Summer Math

There are 14 blueberry muffins. Each picnic basket holds 3. After filling as many picnic baskets as possible, how many blueberry muffins are left over?

**Task card 4** Summer Math

Each picnic basket holds 3 cupcakes. The bakery fills 20 picnic baskets. How many cupcakes is that?

**Task card 5** Summer Math

Mia eats $\frac{2}{5}$ of a watermelon. Omar eats $\frac{1}{5}$ of it. What fraction of the watermelon did they eat together?

**Task card 6** Summer Math

A rectangular swimming pool is 4 feet long and 3 feet wide. Leo walks all the way around it once. How many feet does Leo walk?

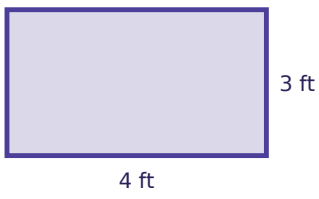

**Task card 7** Summer Math

Noah eats $\frac{2}{8}$ of a watermelon. Ava eats $\frac{1}{8}$ of it. What fraction of the watermelon did they eat together?

**Task card 8** Summer Math

A rectangular swimming pool is 7 feet long and 3 feet wide. Ben walks all the way around it once. How many feet does Ben walk?

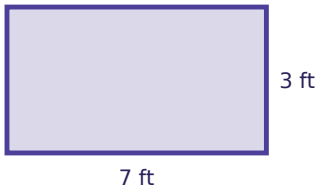


**Task card 9** Summer Math

Zoe eats $\frac{3}{8}$ of a watermelon. Mia eats $\frac{2}{8}$ of it. What fraction of the watermelon did they eat together?

**Task card 10** Summer Math

There are 64 blueberry muffins. Each picnic basket holds 9. How many picnic baskets can be filled all the way?

**Task card 11** Summer Math

A rectangular swimming pool is 4 feet long and 3 feet wide. Noah walks all the way around it once. How many feet does Noah walk?

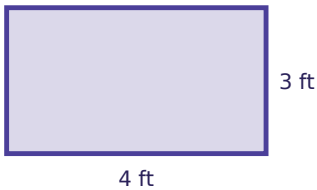


**Task card 12** Summer Math

Ella eats $\frac{2}{8}$ of a watermelon. Sam eats $\frac{1}{8}$ of it. What fraction of the watermelon did they eat together?

**Task card 13** Summer Math

There are 54 cupcakes. Each picnic basket holds 7. How many picnic baskets can be filled all the way?

**Task card 14** Summer Math

A rectangular swimming pool is 5 feet long and 3 feet wide. Sam walks all the way around it once. How many feet does Sam walk?

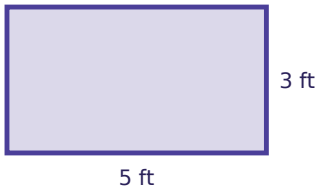


**Task card 15** Summer Math

Each picnic basket holds 4 cupcakes. The bakery fills 25 picnic baskets. How many cupcakes is that?

**Task card 16** Summer Math

Each picnic basket holds 8 blueberry muffins. The bakery fills 25 picnic baskets. How many blueberry muffins is that?

**Task card 17** Summer Math

Ella eats $\frac{1}{7}$ of a watermelon. Mia eats $\frac{3}{7}$ of it. What fraction of the watermelon did they eat together?

**Task card 18** Summer Math

A rectangular swimming pool is 8 feet long and 2 feet wide. Ben walks all the way around it once. How many feet does Ben walk?

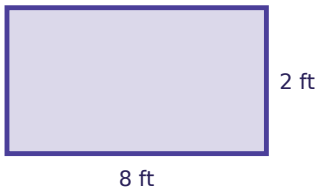

**Task card 19** Summer Math

Each picnic basket holds 9 cupcakes. The bakery fills 26 picnic baskets. How many cupcakes is that?

**Task card 20** Summer Math

Ben eats $\frac{1}{7}$ of a watermelon. Ella eats $\frac{2}{7}$ of it. What fraction of the watermelon did they eat together?

**Task card 21** Summer Math

A rectangular swimming pool is 7 feet long and 3 feet wide. Lily walks all the way around it once. How many feet does Lily walk?

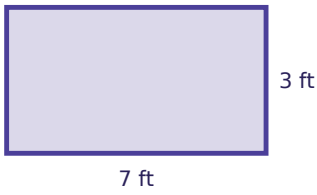


**Task card 22** Summer Math

There are 31 lemon bars. Each picnic basket holds 3. How many picnic baskets can be filled all the way?

**Task card 23** Summer Math

Each picnic basket holds 6 cupcakes. The bakery fills 32 picnic baskets. How many cupcakes is that?

**Task card 24** Summer Math

There are 29 cupcakes. Each picnic basket holds 3. How many picnic baskets can be filled all the way?

# Summer Math Task Cards

Recording sheet · Grade 4 · Read each story and solve.

Name: _____ Date: _____

Scan to check your answers

| | | | |
|---|---|---|---|
| 1 | 2 | 3 | 4 |
| 5 | 6 | 7 | 8 |
| 9 | 10 | 11 | 12 |
| 13 | 14 | 15 | 16 |
| 17 | 18 | 19 | 20 |
| 21 | 22 | 23 | 24 |

# Summer Math Task Cards: Answer Key

Grade 4 · Easy

The answers online

| | | |
|---|---|---|
| **1.** 96 | **2.** 6 | **3.** 2 |
| **4.** 60 | **5.** $\frac{3}{5}$ | **6.** 14 |
| **7.** $\frac{3}{8}$ | **8.** 20 | **9.** $\frac{5}{8}$ |
| **10.** 7 | **11.** 14 | **12.** $\frac{3}{8}$ |
| **13.** 7 | **14.** 16 | **15.** 100 |
| **16.** 200 | **17.** $\frac{4}{7}$ | **18.** 20 |
| **19.** 234 | **20.** $\frac{3}{7}$ | **21.** 20 |
| **22.** 10 | **23.** 192 | **24.** 9 |