Task card 1 Summer Math

Each picnic basket holds 6 lemon bars. The bakery fills 16 picnic baskets. How many lemon bars is that?

Task card 2 Summer Math

There are 46 cupcakes. Each picnic basket holds 8. After filling as many picnic baskets as possible, how many cupcakes are left over?

Task card 3 Summer Math

There are 14 blueberry muffins. Each picnic basket holds 3. After filling as many picnic baskets as possible, how many blueberry muffins are left over?

Task card 4 Summer Math

Each picnic basket holds 3 cupcakes. The bakery fills 20 picnic baskets. How many cupcakes is that?

Task card 5 Summer Math

Mia eats $\frac{2}{5}$ of a watermelon. Omar eats $\frac{1}{5}$ of it. What fraction of the watermelon did they eat together?

Task card 6 Summer Math

A rectangular swimming pool is 4 feet long and 3 feet wide. Leo walks all the way around it once. How many feet does Leo walk?



Task card 7 Summer Math

Noah eats $\frac{2}{8}$ of a watermelon. Ava eats $\frac{1}{8}$ of it. What fraction of the watermelon did they eat together?

Task card 8 Summer Math

A rectangular swimming pool is 7 feet long and 3 feet wide. Ben walks all the way around it once. How many feet does Ben walk?

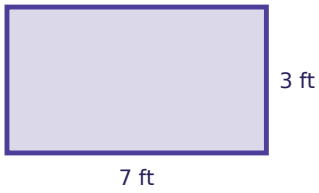

Task card 9 Summer Math

Zoe eats $\frac{3}{8}$ of a watermelon. Mia eats $\frac{2}{8}$ of it. What fraction of the watermelon did they eat together?

Task card 10 Summer Math

There are 64 blueberry muffins. Each picnic basket holds 9. How many picnic baskets can be filled all the way?

Task card 11 Summer Math

A rectangular swimming pool is 4 feet long and 3 feet wide. Noah walks all the way around it once. How many feet does Noah walk?



Task card 12 Summer Math

Ella eats $\frac{2}{8}$ of a watermelon. Sam eats $\frac{1}{8}$ of it. What fraction of the watermelon did they eat together?

Task card 13 Summer Math

There are 54 cupcakes. Each picnic basket holds 7. How many picnic baskets can be filled all the way?

Task card 14 Summer Math

A rectangular swimming pool is 5 feet long and 3 feet wide. Sam walks all the way around it once. How many feet does Sam walk?

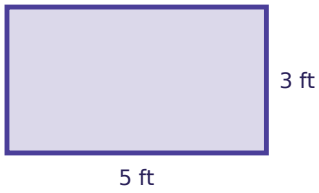

Task card 15 Summer Math

Each picnic basket holds 4 cupcakes. The bakery fills 25 picnic baskets. How many cupcakes is that?

Task card 16 Summer Math

Each picnic basket holds 8 blueberry muffins. The bakery fills 25 picnic baskets. How many blueberry muffins is that?

Task card 17 Summer Math

Ella eats $\frac{1}{7}$ of a watermelon. Mia eats $\frac{3}{7}$ of it. What fraction of the watermelon did they eat together?

Task card 18 Summer Math

A rectangular swimming pool is 8 feet long and 2 feet wide. Ben walks all the way around it once. How many feet does Ben walk?

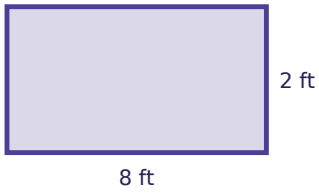

Task card 19 Summer Math

Each picnic basket holds 9 cupcakes. The bakery fills 26 picnic baskets. How many cupcakes is that?

Task card 20 Summer Math

Ben eats $\frac{1}{7}$ of a watermelon. Ella eats $\frac{2}{7}$ of it. What fraction of the watermelon did they eat together?

Task card 21 Summer Math

A rectangular swimming pool is 7 feet long and 3 feet wide. Lily walks all the way around it once. How many feet does Lily walk?

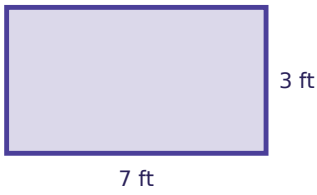

Task card 22 Summer Math

There are 31 lemon bars. Each picnic basket holds 3. How many picnic baskets can be filled all the way?

Task card 23 Summer Math

Each picnic basket holds 6 cupcakes. The bakery fills 32 picnic baskets. How many cupcakes is that?

Task card 24 Summer Math

There are 29 cupcakes. Each picnic basket holds 3. How many picnic baskets can be filled all the way?

Summer Math Task Cards

Recording sheet · Grade 4 · Read each story and solve.

Name: _____ Date: _____

Scan to check your answers

1	2	3	4
5	6	7	8
9	10	11	12
13	14	15	16
17	18	19	20
21	22	23	24

Summer Math Task Cards: Answer Key

Grade 4 · Easy

The answers online

1. 96	**2.** 6	**3.** 2
4. 60	**5.** $\frac{3}{5}$	**6.** 14
7. $\frac{3}{8}$	**8.** 20	**9.** $\frac{5}{8}$
10. 7	**11.** 14	**12.** $\frac{3}{8}$
13. 7	**14.** 16	**15.** 100
16. 200	**17.** $\frac{4}{7}$	**18.** 20
19. 234	**20.** $\frac{3}{7}$	**21.** 20
22. 10	**23.** 192	**24.** 9