Summer Math · 1

A rectangular swimming pool is 7 feet long and 4 feet wide. Noah walks all the way around it once. How many feet does Noah walk?

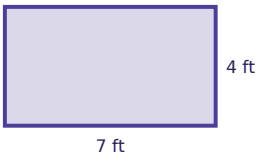

Summer Math · 2

A rectangular swimming pool is 4 feet long and 3 feet wide. Ava walks all the way around it once. How many feet does Ava walk?

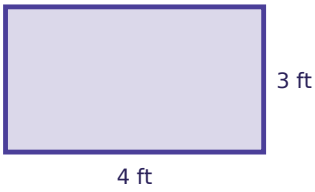

Summer Math · 3

There are 55 blueberry muffins. Each picnic basket holds 6. How many picnic baskets can be filled all the way?

Summer Math · 4

Each picnic basket holds 5 cupcakes. The bakery fills 50 picnic baskets. How many cupcakes is that?

Summer Math · 5

Each picnic basket holds 9 blueberry muffins. The bakery fills 57 picnic baskets. How many blueberry muffins is that?

Summer Math · 6

Lily eats $\frac{4}{9}$ of a watermelon. Ava eats $\frac{4}{9}$ of it. What fraction of the watermelon did they eat together?

Summer Math · 7

Sam eats $\frac{1}{10}$ of a watermelon. Lily eats $\frac{2}{10}$ of it. What fraction of the watermelon did they eat together?

Summer Math · 8

There are 103 blueberry muffins. Each picnic basket holds 7. How many picnic baskets can be filled all the way?

Summer Math · 2

ANSWER

14

Summer Math · 1

ANSWER

22

Summer Math · 4

ANSWER

250

Summer Math · 3

ANSWER

9

Summer Math · 6

ANSWER

$$\frac{8}{9}$$

Summer Math · 5

ANSWER

513

Summer Math · 8

ANSWER

14

Summer Math · 7

ANSWER

$$\frac{3}{10}$$

Summer Math · 9

Mia eats $\frac{6}{12}$ of a watermelon. Noah eats $\frac{5}{12}$ of it. What fraction of the watermelon did they eat together?

Summer Math · 10

A rectangular swimming pool is 6 feet long and 2 feet wide. Zoe walks all the way around it once. How many feet does Zoe walk?

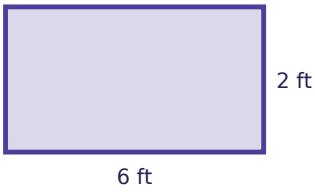

Summer Math · 11

There are 41 cupcakes. Each picnic basket holds 3. How many picnic baskets can be filled all the way?

Summer Math · 12

A rectangular swimming pool is 7 feet long and 4 feet wide. Omar walks all the way around it once. How many feet does Omar walk?

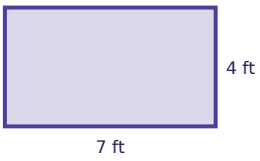

Summer Math · 13

Each picnic basket holds 5 cupcakes. The bakery fills 57 picnic baskets. How many cupcakes is that?

Summer Math · 14

Each picnic basket holds 8 blueberry muffins. The bakery fills 16 picnic baskets. How many blueberry muffins is that?

Summer Math · 15

Ava eats $\frac{2}{10}$ of a watermelon. Lily eats $\frac{1}{10}$ of it. What fraction of the watermelon did they eat together?

Summer Math · 16

There are 99 lemon bars. Each picnic basket holds 8. How many picnic baskets can be filled all the way?

Summer Math · 10

ANSWER

16

Summer Math · 9

ANSWER

$$\frac{11}{12}$$

Summer Math · 12

ANSWER

22

Summer Math · 11

ANSWER

13

Summer Math · 14

ANSWER

128

Summer Math · 13

ANSWER

285

Summer Math · 16

ANSWER

12

Summer Math · 15

ANSWER

$$\frac{3}{10}$$

Summer Math · 17

Mia eats $\frac{2}{8}$ of a watermelon. Leo eats $\frac{1}{8}$ of it. What fraction of the watermelon did they eat together?

Summer Math · 18

Each picnic basket holds 16 blueberry muffins. The bakery fills 74 picnic baskets. How many blueberry muffins is that?

Summer Math · 19

Each picnic basket holds 15 lemon bars. The bakery fills 19 picnic baskets. How many lemon bars is that?

Summer Math · 20

A rectangular swimming pool is 11 feet long and 2 feet wide. Ella walks all the way around it once. How many feet does Ella walk?



Summer Math · 21

Noah eats $\frac{1}{10}$ of a watermelon. Sam eats $\frac{6}{10}$ of it. What fraction of the watermelon did they eat together?

Summer Math · 22

There are 88 lemon bars. Each picnic basket holds 5. How many picnic baskets can be filled all the way?

Summer Math · 23

There are 40 lemon bars. Each picnic basket holds 6. After filling as many picnic baskets as possible, how many lemon bars are left over?

Summer Math · 24

A rectangular swimming pool is 8 feet long and 5 feet wide. Lily walks all the way around it once. How many feet does Lily walk?

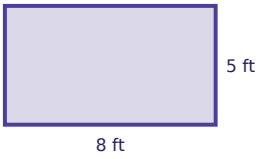

Summer Math · 18

ANSWER

1184

Summer Math · 17

ANSWER

$$\frac{3}{8}$$

Summer Math · 20

ANSWER

26

Summer Math · 19

ANSWER

285

Summer Math · 22

ANSWER

17

Summer Math · 21

ANSWER

$$\frac{7}{10}$$

Summer Math · 24

ANSWER

26

Summer Math · 23

ANSWER

4