Summer Math · 1

Each picnic basket holds 6 lemon bars. The bakery fills 16 picnic baskets. How many lemon bars is that?

Summer Math · 2

There are 46 cupcakes. Each picnic basket holds 8. After filling as many picnic baskets as possible, how many cupcakes are left over?

Summer Math · 3

There are 14 blueberry muffins. Each picnic basket holds 3. After filling as many picnic baskets as possible, how many blueberry muffins are left over?

Summer Math · 4

Each picnic basket holds 3 cupcakes. The bakery fills 20 picnic baskets. How many cupcakes is that?

Summer Math · 5

Mia eats $\frac{2}{5}$ of a watermelon. Omar eats $\frac{1}{5}$ of it. What fraction of the watermelon did they eat together?

Summer Math · 6

A rectangular swimming pool is 4 feet long and 3 feet wide. Leo walks all the way around it once. How many feet does Leo walk?

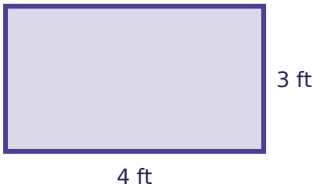

Summer Math · 7

Noah eats $\frac{2}{8}$ of a watermelon. Ava eats $\frac{1}{8}$ of it. What fraction of the watermelon did they eat together?

Summer Math · 8

A rectangular swimming pool is 7 feet long and 3 feet wide. Ben walks all the way around it once. How many feet does Ben walk?

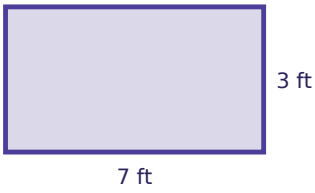

Summer Math · 2

ANSWER

6

Summer Math · 1

ANSWER

96

Summer Math · 4

ANSWER

60

Summer Math · 3

ANSWER

2

Summer Math · 6

ANSWER

14

Summer Math · 5

ANSWER

$$\frac{3}{5}$$

Summer Math · 8

ANSWER

20

Summer Math · 7

ANSWER

$$\frac{3}{8}$$

Summer Math · 9

Zoe eats $\frac{3}{8}$ of a watermelon. Mia eats $\frac{2}{8}$ of it. What fraction of the watermelon did they eat together?

Summer Math · 10

There are 64 blueberry muffins. Each picnic basket holds 9. How many picnic baskets can be filled all the way?

Summer Math · 11

A rectangular swimming pool is 4 feet long and 3 feet wide. Noah walks all the way around it once. How many feet does Noah walk?

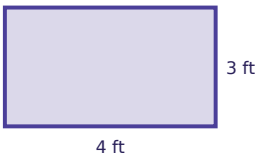

Summer Math · 12

Ella eats $\frac{2}{8}$ of a watermelon. Sam eats $\frac{1}{8}$ of it. What fraction of the watermelon did they eat together?

Summer Math · 13

There are 54 cupcakes. Each picnic basket holds 7. How many picnic baskets can be filled all the way?

Summer Math · 14

A rectangular swimming pool is 5 feet long and 3 feet wide. Sam walks all the way around it once. How many feet does Sam walk?

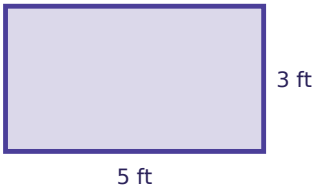

Summer Math · 15

Each picnic basket holds 4 cupcakes. The bakery fills 25 picnic baskets. How many cupcakes is that?

Summer Math · 16

Each picnic basket holds 8 blueberry muffins. The bakery fills 25 picnic baskets. How many blueberry muffins is that?

Summer Math · 10

ANSWER

7

Summer Math · 9

ANSWER

$$\frac{5}{8}$$

Summer Math · 12

ANSWER

$$\frac{3}{8}$$

Summer Math · 11

ANSWER

14

Summer Math · 14

ANSWER

16

Summer Math · 13

ANSWER

7

Summer Math · 16

ANSWER

200

Summer Math · 15

ANSWER

100

Summer Math · 17

Ella eats $\frac{1}{7}$ of a watermelon. Mia eats $\frac{3}{7}$ of it. What fraction of the watermelon did they eat together?

Summer Math · 18

A rectangular swimming pool is 8 feet long and 2 feet wide. Ben walks all the way around it once. How many feet does Ben walk?

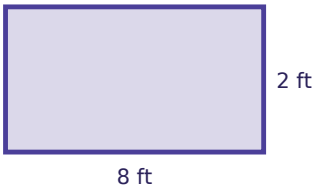

Summer Math · 19

Each picnic basket holds 9 cupcakes. The bakery fills 26 picnic baskets. How many cupcakes is that?

Summer Math · 20

Ben eats $\frac{1}{7}$ of a watermelon. Ella eats $\frac{2}{7}$ of it. What fraction of the watermelon did they eat together?

Summer Math · 21

A rectangular swimming pool is 7 feet long and 3 feet wide. Lily walks all the way around it once. How many feet does Lily walk?



Summer Math · 22

There are 31 lemon bars. Each picnic basket holds 3. How many picnic baskets can be filled all the way?

Summer Math · 23

Each picnic basket holds 6 cupcakes. The bakery fills 32 picnic baskets. How many cupcakes is that?

Summer Math · 24

There are 29 cupcakes. Each picnic basket holds 3. How many picnic baskets can be filled all the way?

Summer Math · 18

ANSWER

20

Summer Math · 17

ANSWER

$$\frac{4}{7}$$

Summer Math · 20

ANSWER

$$\frac{3}{7}$$

Summer Math · 19

ANSWER

234

Summer Math · 22

ANSWER

10

Summer Math · 21

ANSWER

20

Summer Math · 24

ANSWER

9

Summer Math · 23

ANSWER

192