Task card 1 Subtracting Mixed Numbers (Like De...

$5\frac{1}{3} - 4\frac{2}{3} = ___$

Task card 2 Subtracting Mixed Numbers (Like De...

$5\frac{3}{5} - 2\frac{4}{5} = ___$

Task card 3 Subtracting Mixed Numbers (Like De...

$5\frac{1}{5} - 1\frac{3}{5} = ___$

Task card 4 Subtracting Mixed Numbers (Like De...

The whole bar is $9\frac{2}{5}$ long. One part is $3\frac{3}{5}$ long.

How long is the other part? $9\frac{2}{5} - 3\frac{3}{5} = __$

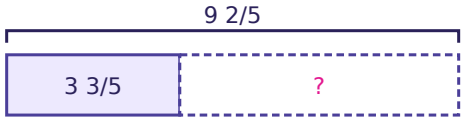

Task card 5 Subtracting Mixed Numbers (Like De...

Regroup first: $4\frac{3}{5} = 3\frac{8}{5}$. So $4\frac{3}{5} - 2\frac{4}{5} = 3\frac{8}{5} - 2\frac{4}{5} = ___$

Task card 6 Subtracting Mixed Numbers (Like De...

$9\frac{1}{3} - ___ = \frac{2}{3}$

Task card 7 Subtracting Mixed Numbers (Like De...

A tank holds $6\frac{2}{5}$ liters of water. Max uses $1\frac{3}{5}$ liters. How many liters are left in the tank?

Task card 8 Subtracting Mixed Numbers (Like De...

$4\frac{1}{5} - 3\frac{2}{5} = \frac{4}{5}$. Check it by adding: $\frac{4}{5} + 3\frac{2}{5} = $ ___

Task card 9 Subtracting Mixed Numbers (Like De...

$12\frac{2}{5} - 3\frac{3}{5} = $ ___

Task card 10 Subtracting Mixed Numbers (Like De...

$11\frac{4}{9} - 3\frac{8}{9} = $ ___

Task card 11 Subtracting Mixed Numbers (Like De...

$2\frac{3}{5} - 1\frac{4}{5} = $ ___

Task card 12 Subtracting Mixed Numbers (Like De...

The whole bar is $12\frac{2}{7}$ long. One part is $5\frac{6}{7}$ long.

How long is the other part? $12\frac{2}{7} - 5\frac{6}{7} =$ ___

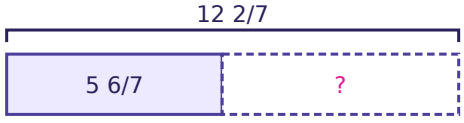

Task card 13 Subtracting Mixed Numbers (Like De...

Regroup first: $7\frac{2}{7} = 6\frac{9}{7}$. So $7\frac{2}{7} - 1\frac{5}{7} = 6\frac{9}{7} - 1\frac{5}{7} =$ ___

Task card 14 Subtracting Mixed Numbers (Like De...

$$7\frac{3}{7} - ___ = 1\frac{6}{7}$$

Task card 15 Subtracting Mixed Numbers (Like De...

A board is $7\frac{1}{5}$ feet long. Ava cuts off $2\frac{3}{5}$ feet. How many feet of board are left?

Task card 16 Subtracting Mixed Numbers (Like De...

$6\frac{2}{7} - 4\frac{5}{7} = 1\frac{4}{7}$. Check it by adding: $1\frac{4}{7} + 4\frac{5}{7} =$ ___

Task card 17 Subtracting Mixed Numbers (Like De...

$$5 - 1\frac{1}{3} = ___$$

Task card 18 Subtracting Mixed Numbers (Like De...

$$9 - 4\frac{1}{10} = ___$$

Task card 19 Subtracting Mixed Numbers (Like De...

$$2 - 1\frac{4}{5} = ___$$

Task card 20 Subtracting Mixed Numbers (Like De...

The whole bar is 4 long. One part is $2\frac{1}{5}$ long. How long is the other part? $4 - 2\frac{1}{5} = ___$

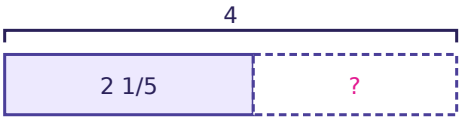

Task card 21 Subtracting Mixed Numbers (Like De...

Regroup first: $4 = 3\frac{4}{4}$. So $4 - 3\frac{3}{4} = 3\frac{4}{4} - 3\frac{3}{4} = ___$

Task card 22 Subtracting Mixed Numbers (Like De...

$$6 - ___ = 2\frac{4}{5}$$

Task card 23 Subtracting Mixed Numbers (Like De...

A board is 3 feet long. Zoe cuts off $2\frac{2}{3}$ feet. How many feet of board are left?

Task card 24 Subtracting Mixed Numbers (Like De...

$8 - 2\frac{2}{5} = 5\frac{3}{5}$. Check it by adding: $5\frac{3}{5} + 2\frac{2}{5} = ___$

Subtracting Mixed Numbers (Like Denominators) Task Cards

Recording sheet · Grade 4 · Answer each question. Write each answer in lowest terms as a mixed number, a fraction or a whole number.

Scan to check your answers

Name: _____ Date: _____

1	2	3	4
5	6	7	8
9	10	11	12
13	14	15	16
17	18	19	20
21	22	23	24

Subtracting Mixed Numbers (Like Denominators) Task Cards: Answer Key

Grade 4 · Medium

The answers online

1. $\frac{2}{3}$	**2.** $2\frac{4}{5}$	**3.** $3\frac{3}{5}$
4. $5\frac{4}{5}$	**5.** $1\frac{4}{5}$	**6.** $8\frac{2}{3}$
7. $4\frac{4}{5}$	**8.** $4\frac{1}{5}$	**9.** $8\frac{4}{5}$
10. $7\frac{5}{9}$	**11.** $\frac{4}{5}$	**12.** $6\frac{3}{7}$
13. $5\frac{4}{7}$	**14.** $5\frac{4}{7}$	**15.** $4\frac{3}{5}$
16. $6\frac{2}{7}$	**17.** $3\frac{2}{3}$	**18.** $4\frac{9}{10}$
19. $\frac{1}{5}$	**20.** $1\frac{4}{5}$	**21.** $\frac{1}{4}$
22. $3\frac{1}{5}$	**23.** $\frac{1}{3}$	**24.** 8