Task card 1 Subtracting Mixed Numbers (Like De...

$5\frac{1}{3} - 4\frac{2}{3} = ___$

Task card 2 Subtracting Mixed Numbers (Like De...

$5\frac{3}{5} - 2\frac{4}{5} = ___$

Task card 3 Subtracting Mixed Numbers (Like De...

$5\frac{1}{5} - 1\frac{3}{5} = ___$

Task card 4 Subtracting Mixed Numbers (Like De...

The whole bar is $9\frac{2}{5}$ long. One part is $3\frac{3}{5}$ long.

How long is the other part? $9\frac{2}{5} - 3\frac{3}{5} = __$

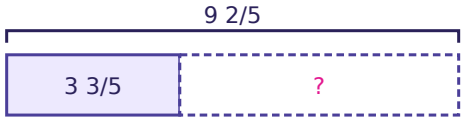

Task card 5 Subtracting Mixed Numbers (Like De...

Regroup first: $4\frac{3}{5} = 3\frac{8}{5}$. So $4\frac{3}{5} - 2\frac{4}{5} = 3\frac{8}{5} - 2\frac{4}{5} = ___$

Task card 6 Subtracting Mixed Numbers (Like De...

$9\frac{1}{3} - ___ = 3\frac{2}{3}$

Task card 7 Subtracting Mixed Numbers (Like De...

A tank holds $6\frac{2}{5}$ liters of water. Max uses $1\frac{3}{5}$ liters. How many liters are left in the tank?

Task card 8 Subtracting Mixed Numbers (Like De...

$4\frac{1}{5} - 3\frac{2}{5} = \frac{4}{5}$. Check it by adding: $\frac{4}{5} + 3\frac{2}{5} = ___$

Task card 9 Subtracting Mixed Numbers (Like De...

$$12\frac{2}{5} - 3\frac{3}{5} = ___$$

Task card 10 Subtracting Mixed Numbers (Like De...

$$11\frac{4}{9} - 3\frac{8}{9} = ___$$

Task card 11 Subtracting Mixed Numbers (Like De...

$$2\frac{3}{5} - 1\frac{4}{5} = ___$$

Task card 12 Subtracting Mixed Numbers (Like De...

The whole bar is $12\frac{2}{7}$ long. One part is $5\frac{6}{7}$ long.

How long is the other part? $12\frac{2}{7} - 5\frac{6}{7} = ___$

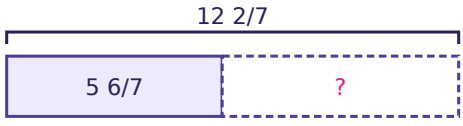

Task card 13 Subtracting Mixed Numbers (Like De...

Regroup first: $7\frac{2}{7} = 6\frac{9}{7}$. So $7\frac{2}{7} - 1\frac{5}{7} = 6\frac{9}{7} - 1\frac{5}{7} =$ ___

Task card 14 Subtracting Mixed Numbers (Like De...

$$7\frac{3}{7} - ___ = 1\frac{6}{7}$$

Task card 15 Subtracting Mixed Numbers (Like De...

A board is $7\frac{1}{5}$ feet long. Ava cuts off $2\frac{3}{5}$ feet. How many feet of board are left?

Task card 16 Subtracting Mixed Numbers (Like De...

$6\frac{2}{7} - 4\frac{5}{7} = 1\frac{4}{7}$. Check it by adding: $1\frac{4}{7} + 4\frac{5}{7} =$ ___

Task card 17 Subtracting Mixed Numbers (Like De...

$$5 - 1\frac{1}{3} = ___$$

Task card 18 Subtracting Mixed Numbers (Like De...

$$9 - 4\frac{1}{10} = ___$$

Task card 19 Subtracting Mixed Numbers (Like De...

$$2 - 1\frac{4}{5} = ___$$

Task card 20 Subtracting Mixed Numbers (Like De...

The whole bar is 4 long. One part is $2\frac{1}{5}$ long. How long is the other part? $4 - 2\frac{1}{5} = ___$

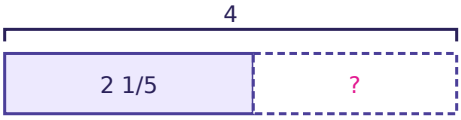

Task card 21 Subtracting Mixed Numbers (Like De...

Regroup first: $4 = 3\frac{4}{4}$. So $4 - 3\frac{3}{4} = 3\frac{4}{4} - 3\frac{3}{4} = ___$

Task card 22 Subtracting Mixed Numbers (Like De...

$$6 - ___ = 2\frac{4}{5}$$

Task card 23 Subtracting Mixed Numbers (Like De...

A board is 3 feet long. Zoe cuts off $2\frac{2}{3}$ feet. How many feet of board are left?

Task card 24 Subtracting Mixed Numbers (Like De...

$8 - 2\frac{2}{5} = 5\frac{3}{5}$. Check it by adding: $5\frac{3}{5} + 2\frac{2}{5} = ___$

Subtracting Mixed Numbers (Like Denominators) Task Cards

Recording sheet · Grade 4 · Answer each question. Write each answer in lowest terms as a mixed number, a fraction or a whole number.

Scan to check your answers

Name: _____ Date: _____

1	2	3	4
5	6	7	8
9	10	11	12
13	14	15	16
17	18	19	20
21	22	23	24

Subtracting Mixed Numbers (Like Denominators) Task Cards: Answer Key

Grade 4 · Medium

The answers online

1. $\frac{2}{3}$

2. $2\frac{4}{5}$

3. $3\frac{3}{5}$

4. $5\frac{4}{5}$

5. $1\frac{4}{5}$

6. $8\frac{2}{3}$

7. $4\frac{4}{5}$

8. $4\frac{1}{5}$

9. $8\frac{4}{5}$

10. $7\frac{5}{9}$

11. $\frac{4}{5}$

12. $6\frac{3}{7}$

13. $5\frac{4}{7}$

14. $5\frac{4}{7}$

15. $4\frac{3}{5}$

16. $6\frac{2}{7}$

17. $3\frac{2}{3}$

18. $4\frac{9}{10}$

19. $\frac{1}{5}$

20. $1\frac{4}{5}$

21. $\frac{1}{4}$

22. $3\frac{1}{5}$

23. $\frac{1}{3}$

24. 8