Subtracting Mixed Numbers (Like Denominators) · 1

$5\frac{1}{3} - 4\frac{2}{3} = ___$

Subtracting Mixed Numbers (Like Denominators) · 2

$5\frac{3}{5} - 2\frac{4}{5} = ___$

Subtracting Mixed Numbers (Like Denominators) · 3

$5\frac{1}{5} - 1\frac{3}{5} = ___$

Subtracting Mixed Numbers (Like Denominators) · 4

The whole bar is $9\frac{2}{5}$ long. One part is $3\frac{3}{5}$ long. How long is the other part? $9\frac{2}{5} - 3\frac{3}{5} = ___$

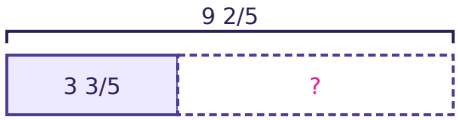

Subtracting Mixed Numbers (Like Denominators) · 5

Regroup first: $4\frac{3}{5} = 3\frac{8}{5}$. So $4\frac{3}{5} - 2\frac{4}{5} = 3\frac{8}{5} - 2\frac{4}{5} = ___$

Subtracting Mixed Numbers (Like Denominators) · 6

$9\frac{1}{3} - ___ = 3\frac{2}{3}$

Subtracting Mixed Numbers (Like Denominators) · 7

A tank holds $6\frac{2}{5}$ liters of water. Max uses $1\frac{3}{5}$ liters. How many liters are left in the tank?

Subtracting Mixed Numbers (Like Denominators) · 8

$4\frac{1}{5} - 3\frac{2}{5} = \frac{4}{5}$. Check it by adding: $\frac{4}{5} + 3\frac{2}{5} = ___$

Subtracting Mixed Numbers (Like Denominators) · 2

ANSWER

$2\frac{4}{5}$

Subtracting Mixed Numbers (Like Denominators) · 1

ANSWER

$\frac{2}{3}$

Subtracting Mixed Numbers (Like Denominators) · 4

ANSWER

$5\frac{4}{5}$

Subtracting Mixed Numbers (Like Denominators) · 3

ANSWER

$3\frac{3}{5}$

Subtracting Mixed Numbers (Like Denominators) · 6

ANSWER

$8\frac{2}{3}$

Subtracting Mixed Numbers (Like Denominators) · 5

ANSWER

$1\frac{4}{5}$

Subtracting Mixed Numbers (Like Denominators) · 8

ANSWER

$4\frac{1}{5}$

Subtracting Mixed Numbers (Like Denominators) · 7

ANSWER

$4\frac{4}{5}$

$12\frac{2}{5} - 3\frac{3}{5} = ___$

$11\frac{4}{9} - 3\frac{8}{9} = ___$

$2\frac{3}{5} - 1\frac{4}{5} = ___$

The whole bar is $12\frac{2}{7}$ long. One part is $5\frac{6}{7}$ long. How long is the other part? $12\frac{2}{7} - 5\frac{6}{7} = __$

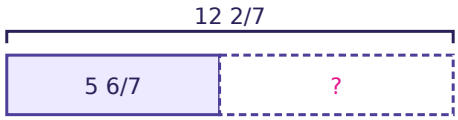

Regroup first: $7\frac{2}{7} = 6\frac{9}{7}$. So $7\frac{2}{7} - 1\frac{5}{7} = 6\frac{9}{7} - 1\frac{5}{7} = ___$

$7\frac{3}{7} - ___ = 1\frac{6}{7}$

A board is $7\frac{1}{5}$ feet long. Ava cuts off $2\frac{3}{5}$ feet. How many feet of board are left?

$6\frac{2}{7} - 4\frac{5}{7} = 1\frac{4}{7}$. Check it by adding: $1\frac{4}{7} + 4\frac{5}{7} = ___$

Subtracting Mixed Numbers (Like Denominators) · 10

ANSWER

$7\frac{5}{9}$

Subtracting Mixed Numbers (Like Denominators) · 9

ANSWER

$8\frac{4}{5}$

Subtracting Mixed Numbers (Like Denominators) · 12

ANSWER

$6\frac{3}{7}$

Subtracting Mixed Numbers (Like Denominators) · 11

ANSWER

$\frac{4}{5}$

Subtracting Mixed Numbers (Like Denominators) · 14

ANSWER

$5\frac{4}{7}$

Subtracting Mixed Numbers (Like Denominators) · 13

ANSWER

$5\frac{4}{7}$

Subtracting Mixed Numbers (Like Denominators) · 16

ANSWER

$6\frac{2}{7}$

Subtracting Mixed Numbers (Like Denominators) · 15

ANSWER

$4\frac{3}{5}$

$5 - 1\frac{1}{3} = ___$

$9 - 4\frac{1}{10} = ___$

$2 - 1\frac{4}{5} = ___$

The whole bar is 4 long. One part is $2\frac{1}{5}$ long. How long is the other part? $4 - 2\frac{1}{5} = ___$

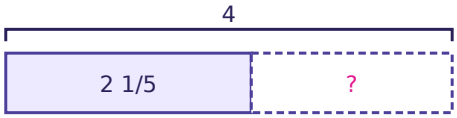

Regroup first: $4 = 3\frac{4}{4}$. So $4 - 3\frac{3}{4} = 3\frac{4}{4} - 3\frac{3}{4} = ___$

$6 - ___ = 2\frac{4}{5}$

A board is 3 feet long. Zoe cuts off $2\frac{2}{3}$ feet. How many feet of board are left?

$8 - 2\frac{2}{5} = 5\frac{3}{5}$. Check it by adding: $5\frac{3}{5} + 2\frac{2}{5} = ___$

Subtracting Mixed Numbers (Like Denominators) · 18

ANSWER

$$4\frac{9}{10}$$

Subtracting Mixed Numbers (Like Denominators) · 17

ANSWER

$$3\frac{2}{3}$$

Subtracting Mixed Numbers (Like Denominators) · 20

ANSWER

$$1\frac{4}{5}$$

Subtracting Mixed Numbers (Like Denominators) · 19

ANSWER

$$\frac{1}{5}$$

Subtracting Mixed Numbers (Like Denominators) · 22

ANSWER

$$3\frac{1}{5}$$

Subtracting Mixed Numbers (Like Denominators) · 21

ANSWER

$$\frac{1}{4}$$

Subtracting Mixed Numbers (Like Denominators) · 24

ANSWER

$$8$$

Subtracting Mixed Numbers (Like Denominators) · 23

ANSWER

$$\frac{1}{3}$$