Subtracting Mixed Numbers (Like Denominators) · 1

$$4\frac{1}{12} - 3\frac{7}{12} = ___$$

Subtracting Mixed Numbers (Like Denominators) · 2

$$4\frac{1}{12} - 1\frac{11}{12} = ___$$

Subtracting Mixed Numbers (Like Denominators) · 3

$$3\frac{1}{12} - 1\frac{7}{12} = ___$$

Subtracting Mixed Numbers (Like Denominators) · 4

The whole bar is $5\frac{1}{4}$ long. One part is $1\frac{3}{4}$ long. How long is the other part? $5\frac{1}{4} - 1\frac{3}{4} = ___$



Subtracting Mixed Numbers (Like Denominators) · 5

Regroup first: $7\frac{1}{6} = 6\frac{7}{6}$. So $7\frac{1}{6} - 2\frac{5}{6} = 6\frac{7}{6} - 2\frac{5}{6} = ___$

Subtracting Mixed Numbers (Like Denominators) · 6

$$8\frac{1}{4} - ___ = 3\frac{1}{2}$$

Subtracting Mixed Numbers (Like Denominators) · 7

A trail is $11\frac{1}{8}$ miles long. Ava has walked $4\frac{7}{8}$ miles. How many miles are left to walk?

Subtracting Mixed Numbers (Like Denominators) · 8

$2\frac{1}{8} - 1\frac{5}{8} = \frac{1}{2}$. Check it by adding: $\frac{1}{2} + 1\frac{5}{8} = ___$

Subtracting Mixed Numbers (Like Denominators) · 2

ANSWER

$2\frac{1}{6}$

Subtracting Mixed Numbers (Like Denominators) · 1

ANSWER

$\frac{1}{2}$

Subtracting Mixed Numbers (Like Denominators) · 4

ANSWER

$3\frac{1}{2}$

Subtracting Mixed Numbers (Like Denominators) · 3

ANSWER

$1\frac{1}{2}$

Subtracting Mixed Numbers (Like Denominators) · 6

ANSWER

$4\frac{3}{4}$

Subtracting Mixed Numbers (Like Denominators) · 5

ANSWER

$4\frac{1}{3}$

Subtracting Mixed Numbers (Like Denominators) · 8

ANSWER

$2\frac{1}{8}$

Subtracting Mixed Numbers (Like Denominators) · 7

ANSWER

$6\frac{1}{4}$

Subtracting Mixed Numbers (Like Denominators) · 9

$24\frac{1}{5} - 5\frac{2}{5} = ___$

Subtracting Mixed Numbers (Like Denominators) · 10

$20\frac{1}{6} - 18\frac{5}{6} = ___$

Subtracting Mixed Numbers (Like Denominators) · 11

$15\frac{1}{8} - 14\frac{3}{8} = ___$

Subtracting Mixed Numbers (Like Denominators) · 12

The whole bar is $25\frac{1}{3}$ long. One part is $11\frac{2}{3}$ long. How long is the other part? $25\frac{1}{3} - 11\frac{2}{3} = ___$

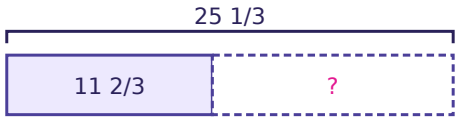

Subtracting Mixed Numbers (Like Denominators) · 13

Regroup first: $20\frac{1}{8} = 19\frac{9}{8}$. So $20\frac{1}{8} - 12\frac{3}{8} = 19\frac{9}{8} - 12\frac{3}{8} = ___$

Subtracting Mixed Numbers (Like Denominators) · 14

$10\frac{1}{3} - ___ = 5\frac{2}{3}$

Subtracting Mixed Numbers (Like Denominators) · 15

A board is $14\frac{1}{4}$ feet long. Zoe cuts off $3\frac{3}{4}$ feet. How many feet of board are left?

Subtracting Mixed Numbers (Like Denominators) · 16

$16\frac{3}{5} - 14\frac{4}{5} = 1\frac{4}{5}$. Check it by adding: $1\frac{4}{5} + 14\frac{4}{5} = ___$

Subtracting Mixed Numbers (Like Denominators) · 10

ANSWER

$$1\frac{1}{3}$$

Subtracting Mixed Numbers (Like Denominators) · 9

ANSWER

$$18\frac{4}{5}$$

Subtracting Mixed Numbers (Like Denominators) · 12

ANSWER

$$13\frac{2}{3}$$

Subtracting Mixed Numbers (Like Denominators) · 11

ANSWER

$$\frac{3}{4}$$

Subtracting Mixed Numbers (Like Denominators) · 14

ANSWER

$$4\frac{2}{3}$$

Subtracting Mixed Numbers (Like Denominators) · 13

ANSWER

$$7\frac{3}{4}$$

Subtracting Mixed Numbers (Like Denominators) · 16

ANSWER

$$16\frac{3}{5}$$

Subtracting Mixed Numbers (Like Denominators) · 15

ANSWER

$$10\frac{1}{2}$$

Subtracting Mixed Numbers (Like Denominators) · 17

$7\frac{1}{6} - 6\frac{5}{6} = ___$

Subtracting Mixed Numbers (Like Denominators) · 18

$9\frac{1}{10} - 6\frac{7}{10} = ___$

Subtracting Mixed Numbers (Like Denominators) · 19

$6\frac{1}{8} - 4\frac{3}{8} = ___$

Subtracting Mixed Numbers (Like Denominators) · 20

The whole bar is $8\frac{1}{8}$ long. One part is $4\frac{7}{8}$ long. How long is the other part? $8\frac{1}{8} - 4\frac{7}{8} = ___$

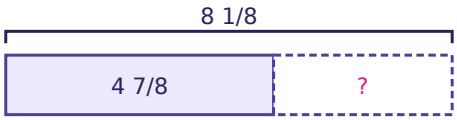

Subtracting Mixed Numbers (Like Denominators) · 21

Regroup first: $9\frac{3}{8} = 8\frac{11}{8}$. So $9\frac{3}{8} - 1\frac{7}{8} = 8\frac{11}{8} - 1\frac{7}{8} = ___$

Subtracting Mixed Numbers (Like Denominators) · 22

$7\frac{5}{8} - ___ = 3\frac{3}{4}$

Subtracting Mixed Numbers (Like Denominators) · 23

A tank holds $6\frac{3}{8}$ liters of water. Sam uses $3\frac{7}{8}$ liters. How many liters are left in the tank?

Subtracting Mixed Numbers (Like Denominators) · 24

$5\frac{1}{8} - 3\frac{7}{8} = 1\frac{1}{4}$. Check it by adding: $1\frac{1}{4} + 3\frac{7}{8} = ___$

Subtracting Mixed Numbers (Like Denominators) · 18

ANSWER

$$2\frac{2}{5}$$

Subtracting Mixed Numbers (Like Denominators) · 17

ANSWER

$$\frac{1}{3}$$

Subtracting Mixed Numbers (Like Denominators) · 20

ANSWER

$$3\frac{1}{4}$$

Subtracting Mixed Numbers (Like Denominators) · 19

ANSWER

$$1\frac{3}{4}$$

Subtracting Mixed Numbers (Like Denominators) · 22

ANSWER

$$3\frac{7}{8}$$

Subtracting Mixed Numbers (Like Denominators) · 21

ANSWER

$$7\frac{1}{2}$$

Subtracting Mixed Numbers (Like Denominators) · 24

ANSWER

$$5\frac{1}{8}$$

Subtracting Mixed Numbers (Like Denominators) · 23

ANSWER

$$2\frac{1}{2}$$