Task card 1 Subtracting Fractions with Like De...

$$3\frac{5}{3} - 3\frac{1}{3} = ___$$

Task card 2 Subtracting Fractions with Like De...

$$8\frac{18}{8} - 8\frac{7}{8} = ___$$

Task card 3 Subtracting Fractions with Like De...

$$5\frac{13}{5} - 5\frac{2}{5} = ___$$

Task card 4 Subtracting Fractions with Like De...

The shaded parts show $\frac{8}{6}$. Take away $\frac{1}{6}$.

$\frac{8}{6} - \frac{1}{6} = ___$

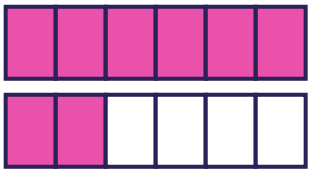

Task card 5 Subtracting Fractions with Like De...

$\frac{14}{6} - \frac{1}{6} = \frac{13}{6}$. Write $\frac{13}{6}$ as a mixed number: ___

Task card 6 Subtracting Fractions with Like De...

$$\frac{10}{4} - \frac{___}{4} = \frac{7}{4}$$

Task card 7 Subtracting Fractions with Like De...

A trail is $\frac{10}{6}$ miles long. Ben has walked $\frac{3}{6}$ of a mile. How many miles are left to walk?

Task card 8 Subtracting Fractions with Like De...

$$\frac{\quad}{5} - \frac{4}{5} = \frac{9}{5}$$

Task card 9 Subtracting Fractions with Like De...

$$\frac{15}{10} - \frac{3}{10} = ___$$

Task card 10 Subtracting Fractions with Like De...

$$\frac{19}{8} - \frac{7}{8} = ___$$

Task card 11 Subtracting Fractions with Like De...

$$\frac{9}{4} - \frac{3}{4} = ___$$

Task card 12 Subtracting Fractions with Like De...

The shaded parts show $\frac{15}{12}$. Take away $\frac{1}{12}$.

$$\frac{15}{12} - \frac{1}{12} = ___$$

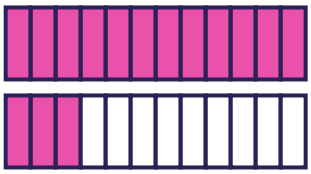

Task card 13 Subtracting Fractions with Like De...

$\frac{14}{6} - \frac{5}{6} = \frac{9}{6}$. Write $\frac{9}{6}$ as a mixed number in lowest terms: ___

Task card 14 Subtracting Fractions with Like De...

$$\frac{18}{10} - \frac{__}{10} = \frac{12}{10}$$

Task card 15 Subtracting Fractions with Like De...

A rope is $\frac{16}{6}$ meters long. Zoe cuts off $\frac{2}{6}$ of a meter. How many meters of rope are left?

Task card 16 Subtracting Fractions with Like De...

$$\frac{__}{12} - \frac{1}{12} = \frac{22}{12}$$

Task card 17 Subtracting Fractions with Like De...

$$2 - \frac{3}{8} = __$$

Task card 18 Subtracting Fractions with Like De...

$$2 - \frac{2}{8} = __$$

Task card 19 Subtracting Fractions with Like De...

$$4 - \frac{1}{5} = ___$$

Task card 20 Subtracting Fractions with Like De...

The shaded parts show 4. Take away $\frac{1}{6}$. $4 - \frac{1}{6} = ___$



Task card 21 Subtracting Fractions with Like De...

$4 = \frac{12}{3}$. So $4 - \frac{1}{3} = \frac{12}{3} - \frac{1}{3} = ___$

Task card 22 Subtracting Fractions with Like De...

$$3 - \frac{___}{10} = \frac{27}{10}$$

Task card 23 Subtracting Fractions with Like De...

A trail is 3 miles long. Ava has walked $\frac{2}{3}$ of a mile. How many miles are left to walk?

Task card 24 Subtracting Fractions with Like De...

What whole number is missing?

$$___ - \frac{2}{5} = 2\frac{3}{5}$$

Subtracting Fractions with Like Denominators Task Cards

Recording sheet · Grade 4 · Answer each question. Write fraction answers in lowest terms; write an answer greater than 1 as a mixed number.

Scan to check your answers

Name: _____ Date: _____

1	2	3	4
5	6	7	8
9	10	11	12
13	14	15	16
17	18	19	20
21	22	23	24

Subtracting Fractions with Like Denominators Task Cards: Answer Key

Grade 4 · Medium

The answers online

1. $1\frac{1}{3}$

2. $1\frac{3}{8}$

3. $2\frac{1}{5}$

4. $1\frac{1}{6}$

5. $2\frac{1}{6}$

6. 3

7. $1\frac{1}{6}$

8. 13

9. $1\frac{1}{5}$

10. $1\frac{1}{2}$

11. $1\frac{1}{2}$

12. $1\frac{1}{6}$

13. $1\frac{1}{2}$

14. 6

15. $2\frac{1}{3}$

16. 23

17. $1\frac{5}{8}$

18. $1\frac{3}{4}$

19. $3\frac{4}{5}$

20. $3\frac{5}{6}$

21. $3\frac{2}{3}$

22. 3

23. $2\frac{1}{3}$

24. 3