Subtracting Fractions with Like Denominators · 1

$\frac{5}{3} - \frac{1}{3} = ___$

Subtracting Fractions with Like Denominators · 2

$\frac{18}{8} - \frac{7}{8} = ___$

Subtracting Fractions with Like Denominators · 3

$\frac{13}{5} - \frac{2}{5} = ___$

Subtracting Fractions with Like Denominators · 4

The shaded parts show $\frac{8}{6}$. Take away $\frac{1}{6}$. $\frac{8}{6} - \frac{1}{6} = ___$



Subtracting Fractions with Like Denominators · 5

$\frac{14}{6} - \frac{1}{6} = \frac{13}{6}$. Write $\frac{13}{6}$ as a mixed number: ___

Subtracting Fractions with Like Denominators · 6

$\frac{10}{4} - \frac{__}{4} = \frac{7}{4}$

Subtracting Fractions with Like Denominators · 7

A trail is $\frac{10}{6}$ miles long. Ben has walked $\frac{3}{6}$ of a mile. How many miles are left to walk?

Subtracting Fractions with Like Denominators · 8

$\frac{__}{5} - \frac{4}{5} = \frac{9}{5}$

Subtracting Fractions with Like Denominators · 2

ANSWER

$$1\frac{3}{8}$$

Subtracting Fractions with Like Denominators · 1

ANSWER

$$1\frac{1}{3}$$

Subtracting Fractions with Like Denominators · 4

ANSWER

$$1\frac{1}{6}$$

Subtracting Fractions with Like Denominators · 3

ANSWER

$$2\frac{1}{5}$$

Subtracting Fractions with Like Denominators · 6

ANSWER

$$3$$

Subtracting Fractions with Like Denominators · 5

ANSWER

$$2\frac{1}{6}$$

Subtracting Fractions with Like Denominators · 8

ANSWER

$$13$$

Subtracting Fractions with Like Denominators · 7

ANSWER

$$1\frac{1}{6}$$

Subtracting Fractions with Like Denominators · 9

$\frac{15}{10} - \frac{3}{10} = ___$

Subtracting Fractions with Like Denominators · 10

$\frac{19}{8} - \frac{7}{8} = ___$

Subtracting Fractions with Like Denominators · 11

$\frac{9}{4} - \frac{3}{4} = ___$

Subtracting Fractions with Like Denominators · 12

The shaded parts show $\frac{15}{12}$. Take away $\frac{1}{12}$.

$\frac{15}{12} - \frac{1}{12} = ___$



Subtracting Fractions with Like Denominators · 13

$\frac{14}{6} - \frac{5}{6} = \frac{9}{6}$. Write $\frac{9}{6}$ as a mixed number in lowest terms: ___

Subtracting Fractions with Like Denominators · 14

$\frac{18}{10} - \frac{__}{10} = \frac{12}{10}$

Subtracting Fractions with Like Denominators · 15

A rope is $\frac{16}{6}$ meters long. Zoe cuts off $\frac{2}{6}$ of a meter. How many meters of rope are left?

Subtracting Fractions with Like Denominators · 16

$\frac{__}{12} - \frac{1}{12} = \frac{22}{12}$

Subtracting Fractions with Like Denominators · 10

ANSWER

$$1\frac{1}{2}$$

Subtracting Fractions with Like Denominators · 9

ANSWER

$$1\frac{1}{5}$$

Subtracting Fractions with Like Denominators · 12

ANSWER

$$1\frac{1}{6}$$

Subtracting Fractions with Like Denominators · 11

ANSWER

$$1\frac{1}{2}$$

Subtracting Fractions with Like Denominators · 14

ANSWER

$$6$$

Subtracting Fractions with Like Denominators · 13

ANSWER

$$1\frac{1}{2}$$

Subtracting Fractions with Like Denominators · 16

ANSWER

$$23$$

Subtracting Fractions with Like Denominators · 15

ANSWER

$$2\frac{1}{3}$$

$$2 - \frac{3}{8} = ___$$

$$2 - \frac{2}{8} = ___$$

$$4 - \frac{1}{5} = ___$$

The shaded parts show 4. Take away $\frac{1}{6}$. $4 - \frac{1}{6} = ___$

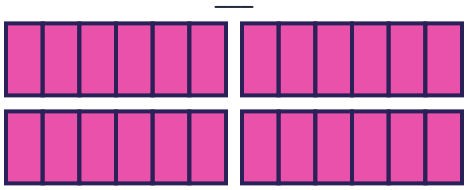

$4 = \frac{12}{3}$. So $4 - \frac{1}{3} = \frac{12}{3} - \frac{1}{3} = ___$

$$3 - \frac{___}{10} = \frac{27}{10}$$

A trail is 3 miles long. Ava has walked $\frac{2}{3}$ of a mile. How many miles are left to walk?

What whole number is missing? $___ - \frac{2}{5} = 2\frac{3}{5}$

Subtracting Fractions with Like Denominators · 18

ANSWER

$$1\frac{3}{4}$$

Subtracting Fractions with Like Denominators · 17

ANSWER

$$1\frac{5}{8}$$

Subtracting Fractions with Like Denominators · 20

ANSWER

$$3\frac{5}{6}$$

Subtracting Fractions with Like Denominators · 19

ANSWER

$$3\frac{4}{5}$$

Subtracting Fractions with Like Denominators · 22

ANSWER

$$3$$

Subtracting Fractions with Like Denominators · 21

ANSWER

$$3\frac{2}{3}$$

Subtracting Fractions with Like Denominators · 24

ANSWER

$$3$$

Subtracting Fractions with Like Denominators · 23

ANSWER

$$2\frac{1}{3}$$