Task card 1 St. Patrick's Day Math

Ella puts rainbow ribbon all the way around a rectangular poster that is 5 feet wide and 4 feet tall. How many feet of ribbon does Ella need?

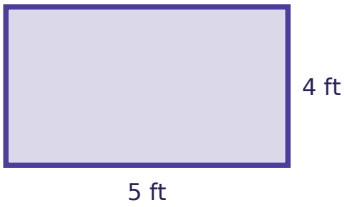

Task card 2 St. Patrick's Day Math

There are 25 shamrock cookies. Each tin holds 3. How many tins can be filled all the way?

Task card 3 St. Patrick's Day Math

There are 86 mint cupcakes. Each tin holds 6. After filling as many tins as possible, how many mint cupcakes are left over?

Task card 4 St. Patrick's Day Math

Each tin holds 9 shamrock cookies. The bakery fills 32 tins. How many shamrock cookies is that?

Task card 5 St. Patrick's Day Math

Each tin holds 4 shamrock cookies. The bakery fills 43 tins. How many shamrock cookies is that?

Task card 6 St. Patrick's Day Math

Noah puts rainbow ribbon all the way around a rectangular poster that is 10 feet wide and 5 feet tall. How many feet of ribbon does Noah need?

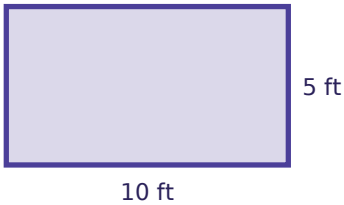

Task card 7 St. Patrick's Day Math

Ava eats $\frac{1}{9}$ of a mint cake. Zoe eats $\frac{1}{9}$ of it. What fraction of the mint cake did they eat together?

Task card 8 St. Patrick's Day Math

Mia eats $\frac{4}{12}$ of a mint cake. Zoe eats $\frac{7}{12}$ of it. What fraction of the mint cake did they eat together?

Task card 9 St. Patrick's Day Math

There are 38 green muffins. Each tin holds 7. How many tins can be filled all the way?

Task card 10 St. Patrick's Day Math

Mia eats $\frac{1}{10}$ of a mint cake. Noah eats $\frac{2}{10}$ of it. What fraction of the mint cake did they eat together?

Task card 11 St. Patrick's Day Math

Leo puts rainbow ribbon all the way around a rectangular poster that is 8 feet wide and 7 feet tall. How many feet of ribbon does Leo need?



Task card 12 St. Patrick's Day Math

Mia eats $\frac{1}{8}$ of a mint cake. Leo eats $\frac{4}{8}$ of it. What fraction of the mint cake did they eat together?

Task card 13 St. Patrick's Day Math

There are 34 shamrock cookies. Each tin holds 7. How many tins can be filled all the way?

Task card 14 St. Patrick's Day Math

Ben puts rainbow ribbon all the way around a rectangular poster that is 5 feet wide and 3 feet tall. How many feet of ribbon does Ben need?

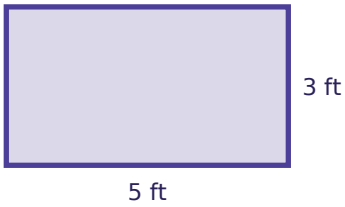

Task card 15 St. Patrick's Day Math

Each tin holds 9 shamrock cookies. The bakery fills 56 tins. How many shamrock cookies is that?

Task card 16 St. Patrick's Day Math

Each tin holds 5 shamrock cookies. The bakery fills 16 tins. How many shamrock cookies is that?

Task card 17 St. Patrick's Day Math

Each tin holds 16 green muffins. The bakery fills 67 tins. How many green muffins is that?

Task card 18 St. Patrick's Day Math

Each tin holds 19 shamrock cookies. The bakery fills 25 tins. How many shamrock cookies is that?

Task card 19 St. Patrick's Day Math

Ava eats $\frac{2}{9}$ of a mint cake. Mia eats $\frac{2}{9}$ of it. What fraction of the mint cake did they eat together?

Task card 20 St. Patrick's Day Math

There are 117 shamrock cookies. Each tin holds 8. After filling as many tins as possible, how many shamrock cookies are left over?

Task card 21 St. Patrick's Day Math

Leo eats $\frac{2}{12}$ of a mint cake. Sam eats $\frac{9}{12}$ of it. What fraction of the mint cake did they eat together?

Task card 22 St. Patrick's Day Math

Leo puts rainbow ribbon all the way around a rectangular poster that is 10 feet wide and 6 feet tall. How many feet of ribbon does Leo need?



Task card 23 St. Patrick's Day Math

Noah puts rainbow ribbon all the way around a rectangular poster that is 6 feet wide and 4 feet tall. How many feet of ribbon does Noah need?

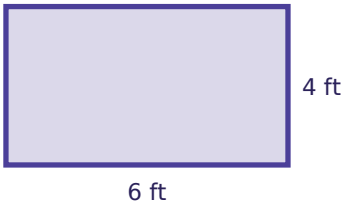

Task card 24 St. Patrick's Day Math

There are 74 green muffins. Each tin holds 7. After filling as many tins as possible, how many green muffins are left over?

St. Patrick's Day Math Task Cards

Recording sheet · Grade 4 · Read each story and solve.

Name: _____ Date: _____

Scan to check your answers

1	2	3	4
5	6	7	8
9	10	11	12
13	14	15	16
17	18	19	20
21	22	23	24

St. Patrick's Day Math Task Cards: Answer Key

Grade 4 · Medium

The answers online

1. 18	**2.** 8	**3.** 2
4. 288	**5.** 172	**6.** 30
7. $\frac{2}{9}$	**8.** $\frac{11}{12}$	**9.** 5
10. $\frac{3}{10}$	**11.** 30	**12.** $\frac{5}{8}$
13. 4	**14.** 16	**15.** 504
16. 80	**17.** 1072	**18.** 475
19. $\frac{4}{9}$	**20.** 5	**21.** $\frac{11}{12}$
22. 32	**23.** 20	**24.** 4