Task card 1 St. Patrick's Day Math

There are 34 shamrock cookies. Each tin holds 6. After filling as many tins as possible, how many shamrock cookies are left over?

Task card 2 St. Patrick's Day Math

Lily eats $\frac{1}{5}$ of a mint cake. Ava eats $\frac{2}{5}$ of it. What fraction of the mint cake did they eat together?

Task card 3 St. Patrick's Day Math

Zoe puts rainbow ribbon all the way around a rectangular poster that is 5 feet wide and 3 feet tall. How many feet of ribbon does Zoe need?



Task card 4 St. Patrick's Day Math

Each tin holds 8 mint cupcakes. The bakery fills 19 tins. How many mint cupcakes is that?

Task card 5 St. Patrick's Day Math

Each tin holds 3 green muffins. The bakery fills 30 tins. How many green muffins is that?

Task card 6 St. Patrick's Day Math

Zoe eats $\frac{3}{8}$ of a mint cake. Omar eats $\frac{2}{8}$ of it. What fraction of the mint cake did they eat together?

Task card 7 St. Patrick's Day Math

There are 47 shamrock cookies. Each tin holds 8. After filling as many tins as possible, how many shamrock cookies are left over?

Task card 8 St. Patrick's Day Math

Leo puts rainbow ribbon all the way around a rectangular poster that is 4 feet wide and 3 feet tall. How many feet of ribbon does Leo need?

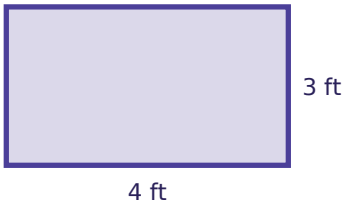

Task card 9 St. Patrick's Day Math

Each tin holds 4 shamrock cookies. The bakery fills 31 tins. How many shamrock cookies is that?

Task card 10 St. Patrick's Day Math

Sam puts rainbow ribbon all the way around a rectangular poster that is 8 feet wide and 7 feet tall. How many feet of ribbon does Sam need?

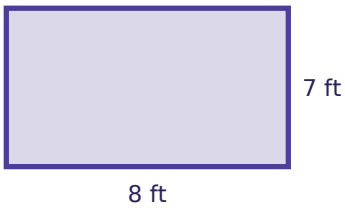

Task card 11 St. Patrick's Day Math

There are 46 mint cupcakes. Each tin holds 6. How many tins can be filled all the way?

Task card 12 St. Patrick's Day Math

Each tin holds 5 green muffins. The bakery fills 17 tins. How many green muffins is that?

Task card 13 St. Patrick's Day Math

Leo eats $\frac{1}{7}$ of a mint cake. Ben eats $\frac{2}{7}$ of it. What fraction of the mint cake did they eat together?

Task card 14 St. Patrick's Day Math

Noah puts rainbow ribbon all the way around a rectangular poster that is 8 feet wide and 6 feet tall. How many feet of ribbon does Noah need?

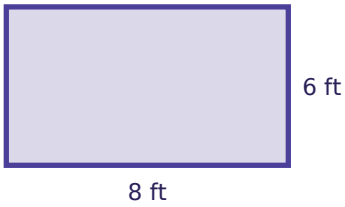

Task card 15 St. Patrick's Day Math

Ava eats $\frac{3}{5}$ of a mint cake. Omar eats $\frac{1}{5}$ of it. What fraction of the mint cake did they eat together?

Task card 16 St. Patrick's Day Math

There are 14 mint cupcakes. Each tin holds 3. After filling as many tins as possible, how many mint cupcakes are left over?

Task card 17 St. Patrick's Day Math

There are 67 shamrock cookies. Each tin holds 7. How many tins can be filled all the way?

Task card 18 St. Patrick's Day Math

Ben eats $\frac{3}{8}$ of a mint cake. Mia eats $\frac{2}{8}$ of it. What fraction of the mint cake did they eat together?

Task card 19 St. Patrick's Day Math

Each tin holds 4 green muffins. The bakery fills 15 tins. How many green muffins is that?

Task card 20 St. Patrick's Day Math

There are 51 mint cupcakes. Each tin holds 6. How many tins can be filled all the way?

Task card 21 St. Patrick's Day Math

Noah eats $\frac{2}{5}$ of a mint cake. Ava eats $\frac{1}{5}$ of it. What fraction of the mint cake did they eat together?

Task card 22 St. Patrick's Day Math

Noah puts rainbow ribbon all the way around a rectangular poster that is 9 feet wide and 8 feet tall. How many feet of ribbon does Noah need?



Task card 23 St. Patrick's Day Math

Ben puts rainbow ribbon all the way around a rectangular poster that is 5 feet wide and 3 feet tall. How many feet of ribbon does Ben need?

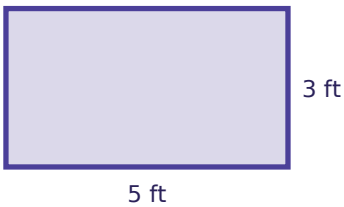

Task card 24 St. Patrick's Day Math

Each tin holds 5 green muffins. The bakery fills 29 tins. How many green muffins is that?

St. Patrick's Day Math Task Cards

Recording sheet · Grade 4 · Read each story and solve.

Name: _____ Date: _____

Scan to check your answers

1	2	3	4
5	6	7	8
9	10	11	12
13	14	15	16
17	18	19	20
21	22	23	24

St. Patrick's Day Math Task Cards: Answer Key

Grade 4 · Easy

The answers online

1. 4	**2.** $\frac{3}{5}$	**3.** 16
4. 152	**5.** 90	**6.** $\frac{5}{8}$
7. 7	**8.** 14	**9.** 124
10. 30	**11.** 7	**12.** 85
13. $\frac{3}{7}$	**14.** 28	**15.** $\frac{4}{5}$
16. 2	**17.** 9	**18.** $\frac{5}{8}$
19. 60	**20.** 8	**21.** $\frac{3}{5}$
22. 34	**23.** 16	**24.** 145