St. Patrick's Day Math · 1

Ella puts rainbow ribbon all the way around a rectangular poster that is 5 feet wide and 4 feet tall. How many feet of ribbon does Ella need?

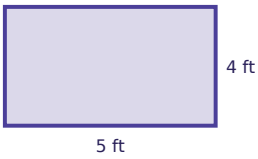

St. Patrick's Day Math · 2

There are 25 shamrock cookies. Each tin holds 3. How many tins can be filled all the way?

St. Patrick's Day Math · 3

There are 86 mint cupcakes. Each tin holds 6. After filling as many tins as possible, how many mint cupcakes are left over?

St. Patrick's Day Math · 4

Each tin holds 9 shamrock cookies. The bakery fills 32 tins. How many shamrock cookies is that?

St. Patrick's Day Math · 5

Each tin holds 4 shamrock cookies. The bakery fills 43 tins. How many shamrock cookies is that?

St. Patrick's Day Math · 6

Noah puts rainbow ribbon all the way around a rectangular poster that is 10 feet wide and 5 feet tall. How many feet of ribbon does Noah need?

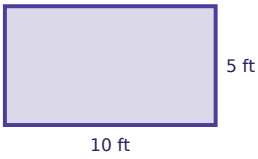

St. Patrick's Day Math · 7

Ava eats $\frac{1}{9}$ of a mint cake. Zoe eats $\frac{1}{9}$ of it. What fraction of the mint cake did they eat together?

St. Patrick's Day Math · 8

Mia eats $\frac{4}{12}$ of a mint cake. Zoe eats $\frac{7}{12}$ of it. What fraction of the mint cake did they eat together?

St. Patrick's Day Math · 2

ANSWER

8

St. Patrick's Day Math · 1

ANSWER

18

St. Patrick's Day Math · 4

ANSWER

288

St. Patrick's Day Math · 3

ANSWER

2

St. Patrick's Day Math · 6

ANSWER

30

St. Patrick's Day Math · 5

ANSWER

172

St. Patrick's Day Math · 8

ANSWER

$$\frac{11}{12}$$

St. Patrick's Day Math · 7

ANSWER

$$\frac{2}{9}$$

St. Patrick's Day Math · 9

There are 38 green muffins. Each tin holds 7. How many tins can be filled all the way?

St. Patrick's Day Math · 10

Mia eats $\frac{1}{10}$ of a mint cake. Noah eats $\frac{2}{10}$ of it. What fraction of the mint cake did they eat together?

St. Patrick's Day Math · 11

Leo puts rainbow ribbon all the way around a rectangular poster that is 8 feet wide and 7 feet tall. How many feet of ribbon does Leo need?

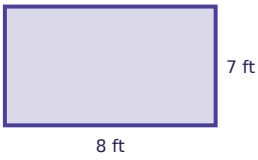

St. Patrick's Day Math · 12

Mia eats $\frac{1}{8}$ of a mint cake. Leo eats $\frac{4}{8}$ of it. What fraction of the mint cake did they eat together?

St. Patrick's Day Math · 13

There are 34 shamrock cookies. Each tin holds 7. How many tins can be filled all the way?

St. Patrick's Day Math · 14

Ben puts rainbow ribbon all the way around a rectangular poster that is 5 feet wide and 3 feet tall. How many feet of ribbon does Ben need?

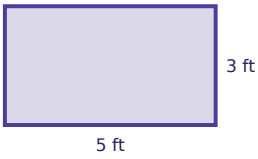

St. Patrick's Day Math · 15

Each tin holds 9 shamrock cookies. The bakery fills 56 tins. How many shamrock cookies is that?

St. Patrick's Day Math · 16

Each tin holds 5 shamrock cookies. The bakery fills 16 tins. How many shamrock cookies is that?

St. Patrick's Day Math · 10

ANSWER

$$\frac{3}{10}$$

St. Patrick's Day Math · 9

ANSWER

5

St. Patrick's Day Math · 12

ANSWER

$$\frac{5}{8}$$

St. Patrick's Day Math · 11

ANSWER

30

St. Patrick's Day Math · 14

ANSWER

16

St. Patrick's Day Math · 13

ANSWER

4

St. Patrick's Day Math · 16

ANSWER

80

St. Patrick's Day Math · 15

ANSWER

504

St. Patrick's Day Math · 17

Each tin holds 16 green muffins. The bakery fills 67 tins. How many green muffins is that?

St. Patrick's Day Math · 18

Each tin holds 19 shamrock cookies. The bakery fills 25 tins. How many shamrock cookies is that?

St. Patrick's Day Math · 19

Ava eats $\frac{2}{9}$ of a mint cake. Mia eats $\frac{2}{9}$ of it. What fraction of the mint cake did they eat together?

St. Patrick's Day Math · 20

There are 117 shamrock cookies. Each tin holds 8. After filling as many tins as possible, how many shamrock cookies are left over?

St. Patrick's Day Math · 21

Leo eats $\frac{2}{12}$ of a mint cake. Sam eats $\frac{9}{12}$ of it. What fraction of the mint cake did they eat together?

St. Patrick's Day Math · 22

Leo puts rainbow ribbon all the way around a rectangular poster that is 10 feet wide and 6 feet tall. How many feet of ribbon does Leo need?

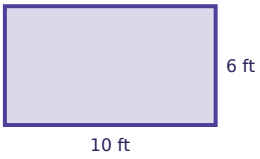

St. Patrick's Day Math · 23

Noah puts rainbow ribbon all the way around a rectangular poster that is 6 feet wide and 4 feet tall. How many feet of ribbon does Noah need?

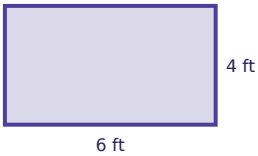

St. Patrick's Day Math · 24

There are 74 green muffins. Each tin holds 7. After filling as many tins as possible, how many green muffins are left over?

St. Patrick's Day Math · 18

ANSWER

475

St. Patrick's Day Math · 17

ANSWER

1072

St. Patrick's Day Math · 20

ANSWER

5

St. Patrick's Day Math · 19

ANSWER

$\frac{4}{9}$

St. Patrick's Day Math · 22

ANSWER

32

St. Patrick's Day Math · 21

ANSWER

$\frac{11}{12}$

St. Patrick's Day Math · 24

ANSWER

4

St. Patrick's Day Math · 23

ANSWER

20