Task card 1 Simplifying Fractions to Lowest Te...

$$\frac{6}{12} = ___$$

Task card 2 Simplifying Fractions to Lowest Te...

$$\frac{12}{24} = ___$$

Task card 3 Simplifying Fractions to Lowest Te...

The bars are the same length. Shade the second bar to match the first. In lowest terms, $\frac{9}{18} = ___$

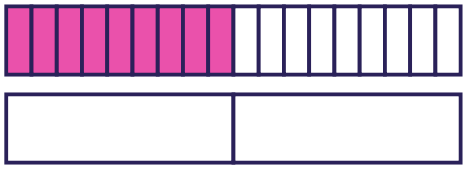

Task card 4 Simplifying Fractions to Lowest Te...

What is the greatest number that divides both 8 and 16?

Task card 5 Simplifying Fractions to Lowest Te...

Divide the top and the bottom by 4: $\frac{4}{8} = ___$

Task card 6 Simplifying Fractions to Lowest Te...

$$\frac{2}{4} = \frac{___}{2}$$

Task card 7 Simplifying Fractions to Lowest Te...

7 of the 14 seats on a bus are taken. What fraction of the seats is that, in lowest terms?

Task card 8 Simplifying Fractions to Lowest Te...

$$\frac{10}{20} = \frac{1}{___}$$

Task card 9 Simplifying Fractions to Lowest Te...

$$\frac{10}{12} = ___$$

Task card 10 Simplifying Fractions to Lowest Te...

$$\frac{2}{8} = ___$$

Task card 11 Simplifying Fractions to Lowest Te...

The bars are the same length. Shade the second bar to match the first. In lowest terms, $\frac{4}{6} = ___$

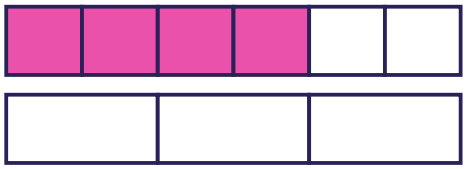

Task card 12 Simplifying Fractions to Lowest Te...

What is the greatest number that divides both 2 and 6?

Task card 13 Simplifying Fractions to Lowest Te...

Divide the top and the bottom by 2: $\frac{8}{18} = ___$

Task card 14 Simplifying Fractions to Lowest Te...

$$\frac{6}{16} = \frac{___}{8}$$

Task card 15 Simplifying Fractions to Lowest Te...

14 of the 20 seats on a bus are taken. What fraction of the seats is that, in lowest terms?

Task card 16 Simplifying Fractions to Lowest Te...

$$\frac{4}{10} = \frac{2}{___}$$

Task card 17 Simplifying Fractions to Lowest Te...

$$\frac{3}{21} = ___$$

Task card 18 Simplifying Fractions to Lowest Te...

$$\frac{3}{6} = ___$$

Task card 19 Simplifying Fractions to Lowest Te...

The bars are the same length. Shade the second bar to match the first. In lowest terms, $\frac{21}{24}$ = ___

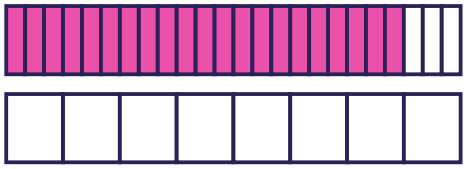

Task card 20 Simplifying Fractions to Lowest Te...

What is the greatest number that divides both 12 and 21?

Task card 21 Simplifying Fractions to Lowest Te...

Divide the top and the bottom by 3: $\frac{9}{21}$ = ___

Task card 22 Simplifying Fractions to Lowest Te...

$$\frac{6}{9} = \frac{___}{3}$$

Task card 23 Simplifying Fractions to Lowest Te...

18 of the 21 beads in a jar are red. What fraction of the beads is that, in lowest terms?

Task card 24 Simplifying Fractions to Lowest Te...

$$\frac{3}{12} = \frac{1}{___}$$

Simplifying Fractions to Lowest Terms Task Cards

Recording sheet · Grade 4 · Answer each question. Write fractions in lowest terms and write an improper fraction as a mixed number.

Scan to check your answers

Name: _____ Date: _____

1	2	3	4
5	6	7	8
9	10	11	12
13	14	15	16
17	18	19	20
21	22	23	24

Simplifying Fractions to Lowest Terms Task Cards: Answer Key

Grade 4 · Easy

The answers online

1. $\frac{1}{2}$	**2.** $\frac{1}{2}$	**3.** $\frac{1}{2}$
4. 8	**5.** $\frac{1}{2}$	**6.** 1
7. $\frac{1}{2}$	**8.** 2	**9.** $\frac{5}{6}$
10. $\frac{1}{4}$	**11.** $\frac{2}{3}$	**12.** 2
13. $\frac{4}{9}$	**14.** 3	**15.** $\frac{7}{10}$
16. 5	**17.** $\frac{1}{7}$	**18.** $\frac{1}{2}$
19. $\frac{7}{8}$	**20.** 3	**21.** $\frac{3}{7}$
22. 2	**23.** $\frac{6}{7}$	**24.** 4