Simplifying Fractions to Lowest Terms · 1

$$\frac{6}{12} = ___$$

Simplifying Fractions to Lowest Terms · 2

$$\frac{12}{24} = ___$$

Simplifying Fractions to Lowest Terms · 3

The bars are the same length. Shade the second bar to match the first. In lowest terms, $\frac{9}{18} = ___$

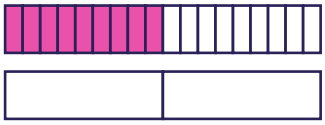

Simplifying Fractions to Lowest Terms · 4

What is the greatest number that divides both 8 and 16?

Simplifying Fractions to Lowest Terms · 5

Divide the top and the bottom by 4: $\frac{4}{8} = ___$

Simplifying Fractions to Lowest Terms · 6

$$\frac{2}{4} = \frac{___}{2}$$

Simplifying Fractions to Lowest Terms · 7

7 of the 14 seats on a bus are taken. What fraction of the seats is that, in lowest terms?

Simplifying Fractions to Lowest Terms · 8

$$\frac{10}{20} = \frac{1}{___}$$

Simplifying Fractions to Lowest Terms · 2

ANSWER

$\frac{1}{2}$

Simplifying Fractions to Lowest Terms · 1

ANSWER

$\frac{1}{2}$

Simplifying Fractions to Lowest Terms · 4

ANSWER

8

Simplifying Fractions to Lowest Terms · 3

ANSWER

$\frac{1}{2}$

Simplifying Fractions to Lowest Terms · 6

ANSWER

1

Simplifying Fractions to Lowest Terms · 5

ANSWER

$\frac{1}{2}$

Simplifying Fractions to Lowest Terms · 8

ANSWER

2

Simplifying Fractions to Lowest Terms · 7

ANSWER

$\frac{1}{2}$

Simplifying Fractions to Lowest Terms · 9

$$\frac{10}{12} = ___$$

Simplifying Fractions to Lowest Terms · 10

$$\frac{2}{8} = ___$$

Simplifying Fractions to Lowest Terms · 11

The bars are the same length. Shade the second bar to match the first. In lowest terms, $\frac{4}{6} = ___$

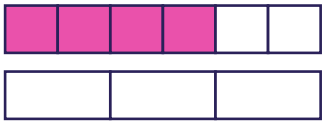

Simplifying Fractions to Lowest Terms · 12

What is the greatest number that divides both 2 and 6?

Simplifying Fractions to Lowest Terms · 13

Divide the top and the bottom by 2:

$$\frac{8}{18} = ___$$

Simplifying Fractions to Lowest Terms · 14

$$\frac{6}{16} = \frac{___}{8}$$

Simplifying Fractions to Lowest Terms · 15

14 of the 20 seats on a bus are taken. What fraction of the seats is that, in lowest terms?

Simplifying Fractions to Lowest Terms · 16

$$\frac{4}{10} = \frac{2}{___}$$

Simplifying Fractions to Lowest Terms · 10

ANSWER

$\frac{1}{4}$

Simplifying Fractions to Lowest Terms · 9

ANSWER

$\frac{5}{6}$

Simplifying Fractions to Lowest Terms · 12

ANSWER

2

Simplifying Fractions to Lowest Terms · 11

ANSWER

$\frac{2}{3}$

Simplifying Fractions to Lowest Terms · 14

ANSWER

3

Simplifying Fractions to Lowest Terms · 13

ANSWER

$\frac{4}{9}$

Simplifying Fractions to Lowest Terms · 16

ANSWER

5

Simplifying Fractions to Lowest Terms · 15

ANSWER

$\frac{7}{10}$

Simplifying Fractions to Lowest Terms · 17

$\frac{3}{21} = ___$

Simplifying Fractions to Lowest Terms · 18

$\frac{3}{6} = ___$

Simplifying Fractions to Lowest Terms · 19

The bars are the same length. Shade the second bar to match the first. In lowest terms, $\frac{21}{24} = __$

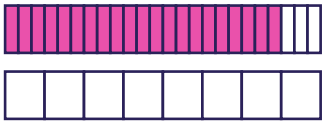

Simplifying Fractions to Lowest Terms · 20

What is the greatest number that divides both 12 and 21?

Simplifying Fractions to Lowest Terms · 21

Divide the top and the bottom by 3:

$\frac{9}{21} = __$

Simplifying Fractions to Lowest Terms · 22

$\frac{6}{9} = \frac{__}{3}$

Simplifying Fractions to Lowest Terms · 23

18 of the 21 beads in a jar are red. What fraction of the beads is that, in lowest terms?

Simplifying Fractions to Lowest Terms · 24

$\frac{3}{12} = \frac{1}{__}$

Simplifying Fractions to Lowest Terms · 18

ANSWER

$\frac{1}{2}$

Simplifying Fractions to Lowest Terms · 17

ANSWER

$\frac{1}{7}$

Simplifying Fractions to Lowest Terms · 20

ANSWER

3

Simplifying Fractions to Lowest Terms · 19

ANSWER

$\frac{7}{8}$

Simplifying Fractions to Lowest Terms · 22

ANSWER

2

Simplifying Fractions to Lowest Terms · 21

ANSWER

$\frac{3}{7}$

Simplifying Fractions to Lowest Terms · 24

ANSWER

4

Simplifying Fractions to Lowest Terms · 23

ANSWER

$\frac{6}{7}$