Task card 1 Rounding to the Nearest 10,000 & 1...

Round 42,176 to the nearest ten thousand.

Task card 2 Rounding to the Nearest 10,000 & 1...

Round 69,043 to the nearest ten thousand.

Task card 3 Rounding to the Nearest 10,000 & 1...

The dot shows 63,411. Round it to the nearest ten thousand: is it 60,000 or 70,000?

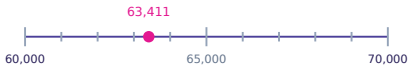

Task card 4 Rounding to the Nearest 10,000 & 1...

The dot shows 28,987. Round it to the nearest ten thousand: is it 20,000 or 30,000?

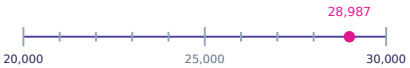

Task card 5 Rounding to the Nearest 10,000 & 1...

You want to round 93,022 to the nearest ten thousand. Which digit of 93,022 tells you whether to round up or down?

Task card 6 Rounding to the Nearest 10,000 & 1...

Which of these three numbers rounds to 60,000 when you round to the nearest ten thousand? 67,611 or 64,741 or 52,628

Task card 7 Rounding to the Nearest 10,000 & 1...

A factory made 83,060 bottles this month. About how many is that, rounded to the nearest ten thousand?

Task card 8 Rounding to the Nearest 10,000 & 1...

What is the biggest whole number that rounds to 60,000 when you round to the nearest ten thousand?

Task card 9 Rounding to the Nearest 10,000 & 1...

Round 50,963 to the nearest ten thousand.

Task card 10 Rounding to the Nearest 10,000 & 1...

Round 85,776 to the nearest ten thousand.

Task card 11 Rounding to the Nearest 10,000 & 1...

The dot shows 90,823. Round it to the nearest ten thousand: is it 90,000 or 100,000?



Task card 12 Rounding to the Nearest 10,000 & 1...

The dot shows 45,266. Round it to the nearest ten thousand: is it 40,000 or 50,000?

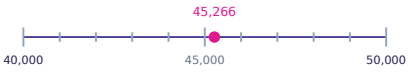

Task card 13 Rounding to the Nearest 10,000 & 1...

You want to round 19,068 to the nearest ten thousand. Which digit of 19,068 tells you whether to round up or down?

Task card 14 Rounding to the Nearest 10,000 & 1...

Which of these three numbers rounds to 90,000 when you round to the nearest ten thousand? 85,369 or 96,275 or 81,708

Task card 15 Rounding to the Nearest 10,000 & 1...

A website had 85,831 visits this week. About how many is that, rounded to the nearest ten thousand?

Task card 16 Rounding to the Nearest 10,000 & 1...

What is the biggest whole number that rounds to 50,000 when you round to the nearest ten thousand?

Task card 17 Rounding to the Nearest 10,000 & 1...

Round 809,089 to the nearest ten thousand.

Task card 18 Rounding to the Nearest 10,000 & 1...

Round 656,188 to the nearest ten thousand.

Task card 19 Rounding to the Nearest 10,000 & 1...

The dot shows 865,337. Round it to the nearest ten thousand: is it 860,000 or 870,000?

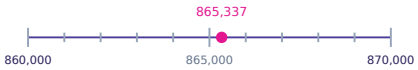

Task card 20 Rounding to the Nearest 10,000 & 1...

The dot shows 486,145. Round it to the nearest ten thousand: is it 480,000 or 490,000?

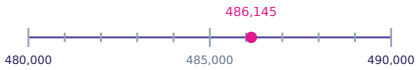

Task card 21 Rounding to the Nearest 10,000 & 1...

You want to round 705,846 to the nearest ten thousand. Which digit of 705,846 tells you whether to round up or down?

Task card 22 Rounding to the Nearest 10,000 & 1...

Which of these three numbers rounds to 310,000 when you round to the nearest ten thousand? 301,973 or 300,195 or 309,906

Task card 23 Rounding to the Nearest 10,000 & 1...

A city has 945,804 people. About how many is that, rounded to the nearest ten thousand?

Task card 24 Rounding to the Nearest 10,000 & 1...

What is the biggest whole number that rounds to 540,000 when you round to the nearest ten thousand?

Rounding to the Nearest 10,000 & 100,000 Task Cards

Recording sheet · Grade 4 · Round each number to the place named. The same kind of rounding comes in different shapes.

Scan to check your answers

Name: _____ Date: _____

1	2	3	4
5	6	7	8
9	10	11	12
13	14	15	16
17	18	19	20
21	22	23	24

Rounding to the Nearest 10,000 & 100,000 Task Cards: Answer Key

Grade 4 · Easy

The answers online

1. 40,000	**2.** 70,000	**3.** 60,000
4. 30,000	**5.** 3	**6.** 64,741
7. 80,000	**8.** 64,999	**9.** 50,000
10. 90,000	**11.** 90,000	**12.** 50,000
13. 9	**14.** 85,369	**15.** 90,000
16. 54,999	**17.** 810,000	**18.** 660,000
19. 870,000	**20.** 490,000	**21.** 5
22. 309,906	**23.** 950,000	**24.** 544,999