Rounding to the Nearest 10,000 & 100,000 · 1

Round 576,552 to the nearest ten thousand.

Rounding to the Nearest 10,000 & 100,000 · 2

Round 954,043 to the nearest hundred thousand.

Rounding to the Nearest 10,000 & 100,000 · 3

The dot shows 464,004. Round it to the nearest ten thousand: is it 460,000 or 470,000?

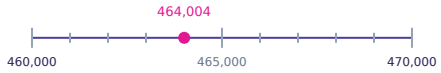

Rounding to the Nearest 10,000 & 100,000 · 4

The dot shows 256,425. Round it to the nearest hundred thousand: is it 200,000 or 300,000?

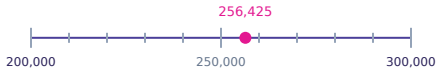

Rounding to the Nearest 10,000 & 100,000 · 5

You want to round 798,022 to the nearest ten thousand. Which digit of 798,022 tells you whether to round up or down?

Rounding to the Nearest 10,000 & 100,000 · 6

Which of these three numbers rounds to 500,000 when you round to the nearest hundred thousand? 484,822 or 579,300 or 439,426

Rounding to the Nearest 10,000 & 100,000 · 7

A factory made 997,545 bottles this month. About how many is that, rounded to the nearest ten thousand?

Rounding to the Nearest 10,000 & 100,000 · 8

What is the biggest whole number that rounds to 700,000 when you round to the nearest hundred thousand?

Rounding to the Nearest 10,000 & 100,000 · 2

ANSWER

1,000,000

Rounding to the Nearest 10,000 & 100,000 · 1

ANSWER

580,000

Rounding to the Nearest 10,000 & 100,000 · 4

ANSWER

300,000

Rounding to the Nearest 10,000 & 100,000 · 3

ANSWER

460,000

Rounding to the Nearest 10,000 & 100,000 · 6

ANSWER

484,822

Rounding to the Nearest 10,000 & 100,000 · 5

ANSWER

8

Rounding to the Nearest 10,000 & 100,000 · 8

ANSWER

749,999

Rounding to the Nearest 10,000 & 100,000 · 7

ANSWER

1,000,000

Rounding to the Nearest 10,000 & 100,000 · 9

Round 798,538 to the nearest ten thousand.

Rounding to the Nearest 10,000 & 100,000 · 10

Round 526,646 to the nearest hundred thousand.

Rounding to the Nearest 10,000 & 100,000 · 11

The dot shows 935,055. Round it to the nearest ten thousand: is it 930,000 or 940,000?

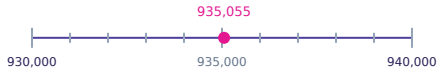

Rounding to the Nearest 10,000 & 100,000 · 12

The dot shows 969,790. Round it to the nearest hundred thousand: is it 900,000 or 1,000,000?



Rounding to the Nearest 10,000 & 100,000 · 13

You want to round 170,575 to the nearest ten thousand. Which digit of 170,575 tells you whether to round up or down?

Rounding to the Nearest 10,000 & 100,000 · 14

Which of these three numbers rounds to 1,000,000 when you round to the nearest hundred thousand? 921,380 or 943,011 or 985,466

Rounding to the Nearest 10,000 & 100,000 · 15

A factory made 245,887 bottles this month. About how many is that, rounded to the nearest ten thousand?

Rounding to the Nearest 10,000 & 100,000 · 16

What is the smallest whole number that rounds to 1,000,000 when you round to the nearest hundred thousand?

Rounding to the Nearest 10,000 & 100,000 · 10

ANSWER

500,000

Rounding to the Nearest 10,000 & 100,000 · 9

ANSWER

800,000

Rounding to the Nearest 10,000 & 100,000 · 12

ANSWER

1,000,000

Rounding to the Nearest 10,000 & 100,000 · 11

ANSWER

940,000

Rounding to the Nearest 10,000 & 100,000 · 14

ANSWER

985,466

Rounding to the Nearest 10,000 & 100,000 · 13

ANSWER

0

Rounding to the Nearest 10,000 & 100,000 · 16

ANSWER

950,000

Rounding to the Nearest 10,000 & 100,000 · 15

ANSWER

250,000

Rounding to the Nearest 10,000 & 100,000 · 17

Round 387,643 to the nearest ten thousand.

Rounding to the Nearest 10,000 & 100,000 · 18

Round 970,389 to the nearest hundred thousand.

Rounding to the Nearest 10,000 & 100,000 · 19

The dot shows 459,549. Round it to the nearest ten thousand: is it 450,000 or 460,000?



Rounding to the Nearest 10,000 & 100,000 · 20

The dot shows 306,815. Round it to the nearest hundred thousand: is it 300,000 or 400,000?



Rounding to the Nearest 10,000 & 100,000 · 21

You want to round 499,273 to the nearest ten thousand. Which digit of 499,273 tells you whether to round up or down?

Rounding to the Nearest 10,000 & 100,000 · 22

Which of these three numbers rounds to 400,000 when you round to the nearest hundred thousand? 343,322 or 339,553 or 440,778

Rounding to the Nearest 10,000 & 100,000 · 23

A factory made 495,368 bottles this month. About how many is that, rounded to the nearest ten thousand?

Rounding to the Nearest 10,000 & 100,000 · 24

What is the biggest whole number that rounds to 400,000 when you round to the nearest hundred thousand?

Rounding to the Nearest 10,000 & 100,000 · 18

ANSWER

1,000,000

Rounding to the Nearest 10,000 & 100,000 · 17

ANSWER

390,000

Rounding to the Nearest 10,000 & 100,000 · 20

ANSWER

300,000

Rounding to the Nearest 10,000 & 100,000 · 19

ANSWER

460,000

Rounding to the Nearest 10,000 & 100,000 · 22

ANSWER

440,778

Rounding to the Nearest 10,000 & 100,000 · 21

ANSWER

9

Rounding to the Nearest 10,000 & 100,000 · 24

ANSWER

449,999

Rounding to the Nearest 10,000 & 100,000 · 23

ANSWER

500,000