**Task card 1** Rounding to the Nearest 1,000

Round 44,642 to the nearest thousand.

**Task card 2** Rounding to the Nearest 1,000

Round 33,909 to the nearest thousand.

**Task card 3** Rounding to the Nearest 1,000

The dot shows 98,313. Round it to the nearest thousand: is it 98,000 or 99,000?

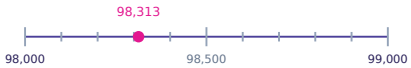


**Task card 4** Rounding to the Nearest 1,000

The dot shows 59,534. Round it to the nearest thousand: is it 59,000 or 60,000?

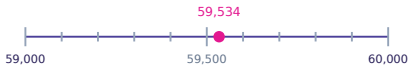


**Task card 5** Rounding to the Nearest 1,000

You want to round 33,201 to the nearest thousand. Which digit of 33,201 tells you whether to round up or down?

**Task card 6** Rounding to the Nearest 1,000

Which of these three numbers rounds to 23,000 when you round to the nearest thousand? 22,835 or 22,335 or 22,200

**Task card 7** Rounding to the Nearest 1,000

A city has 32,556 people. About how many is that, rounded to the nearest thousand?

**Task card 8** Rounding to the Nearest 1,000

What is the biggest whole number that rounds to 50,000 when you round to the nearest thousand?

**Task card 9** Rounding to the Nearest 1,000

Round 67,695 to the nearest thousand.

**Task card 10** Rounding to the Nearest 1,000

Round 56,408 to the nearest thousand.

**Task card 11** Rounding to the Nearest 1,000

The dot shows 88,837. Round it to the nearest thousand: is it 88,000 or 89,000?




**Task card 12** Rounding to the Nearest 1,000

The dot shows 99,587. Round it to the nearest thousand: is it 99,000 or 100,000?

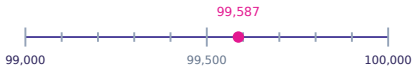

**Task card 13** Rounding to the Nearest 1,000

You want to round 92,721 to the nearest thousand. Which digit of 92,721 tells you whether to round up or down?

**Task card 14** Rounding to the Nearest 1,000

Which of these three numbers rounds to 77,000 when you round to the nearest thousand? 77,523 or 77,817 or 77,307

**Task card 15** Rounding to the Nearest 1,000

A website had 30,515 visits this week. About how many is that, rounded to the nearest thousand?

**Task card 16** Rounding to the Nearest 1,000

What is the biggest whole number that rounds to 100,000 when you round to the nearest thousand?

**Task card 17** Rounding to the Nearest 1,000

Round 872,829 to the nearest thousand.

**Task card 18** Rounding to the Nearest 1,000

Round 340,239 to the nearest thousand.

**Task card 19** Rounding to the Nearest 1,000

The dot shows 949,824. Round it to the nearest thousand: is it 949,000 or 950,000?




**Task card 20** Rounding to the Nearest 1,000

The dot shows 985,675. Round it to the nearest thousand: is it 985,000 or 986,000?

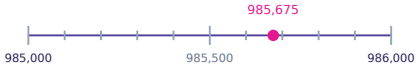


**Task card 21** Rounding to the Nearest 1,000

You want to round 760,901 to the nearest thousand. Which digit of 760,901 tells you whether to round up or down?

**Task card 22** Rounding to the Nearest 1,000

Which of these three numbers rounds to 820,000 when you round to the nearest thousand? 819,073 or 819,971 or 820,520

**Task card 23** Rounding to the Nearest 1,000

A website had 593,555 visits this week. About how many is that, rounded to the nearest thousand?

**Task card 24** Rounding to the Nearest 1,000

What is the biggest whole number that rounds to 780,000 when you round to the nearest thousand?

# Rounding to the Nearest 1,000 Task Cards

Recording sheet · Grade 4 · Round each number to the place named. The same kind of rounding comes in different shapes.

Name: _____ Date: _____

Scan to check your answers

| | | | |
|---|---|---|---|
| 1 | 2 | 3 | 4 |
| 5 | 6 | 7 | 8 |
| 9 | 10 | 11 | 12 |
| 13 | 14 | 15 | 16 |
| 17 | 18 | 19 | 20 |
| 21 | 22 | 23 | 24 |

# Rounding to the Nearest 1,000 Task Cards: Answer Key

Grade 4 · Medium

The answers online

| | | |
|---|---|---|
| **1.** 45,000 | **2.** 34,000 | **3.** 98,000 |
| **4.** 60,000 | **5.** 2 | **6.** 22,835 |
| **7.** 33,000 | **8.** 50,499 | **9.** 68,000 |
| **10.** 56,000 | **11.** 89,000 | **12.** 100,000 |
| **13.** 7 | **14.** 77,307 | **15.** 31,000 |
| **16.** 100,499 | **17.** 873,000 | **18.** 340,000 |
| **19.** 950,000 | **20.** 986,000 | **21.** 9 |
| **22.** 819,971 | **23.** 594,000 | **24.** 780,499 |