Task card 1 Rounding to the Nearest 1,000

Round 896,694 to the nearest thousand.

Task card 2 Rounding to the Nearest 1,000

Round 299,953 to the nearest thousand.

Task card 3 Rounding to the Nearest 1,000

The dot shows 428,438. Round it to the nearest thousand: is it 428,000 or 429,000?

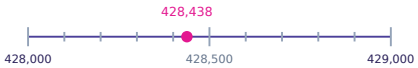

Task card 4 Rounding to the Nearest 1,000

The dot shows 642,160. Round it to the nearest thousand: is it 642,000 or 643,000?

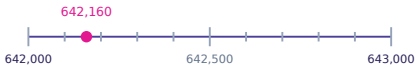

Task card 5 Rounding to the Nearest 1,000

You want to round 479,860 to the nearest thousand. Which digit of 479,860 tells you whether to round up or down?

Task card 6 Rounding to the Nearest 1,000

Which of these three numbers rounds to 294,000 when you round to the nearest thousand? 293,285 or 293,408 or 293,690

Task card 7 Rounding to the Nearest 1,000

A factory made 249,806 bottles this month. About how many is that, rounded to the nearest thousand?

Task card 8 Rounding to the Nearest 1,000

What is the smallest whole number that rounds to 159,000 when you round to the nearest thousand?

Task card 9 Rounding to the Nearest 1,000

Round 849,812 to the nearest thousand.

Task card 10 Rounding to the Nearest 1,000

Round 165,190 to the nearest thousand.

Task card 11 Rounding to the Nearest 1,000

The dot shows 534,641. Round it to the nearest thousand: is it 534,000 or 535,000?

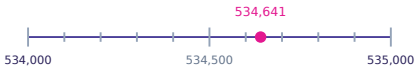

Task card 12 Rounding to the Nearest 1,000

The dot shows 739,662. Round it to the nearest thousand: is it 739,000 or 740,000?

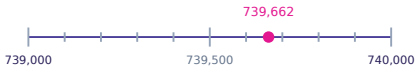

Task card 13 Rounding to the Nearest 1,000

You want to round 491,100 to the nearest thousand. Which digit of 491,100 tells you whether to round up or down?

Task card 14 Rounding to the Nearest 1,000

Which of these three numbers rounds to 470,000 when you round to the nearest thousand? 470,772 or 469,919 or 470,641

Task card 15 Rounding to the Nearest 1,000

A city has 248,591 people. About how many is that, rounded to the nearest thousand?

Task card 16 Rounding to the Nearest 1,000

What is the smallest whole number that rounds to 700,000 when you round to the nearest thousand?

Task card 17 Rounding to the Nearest 1,000

Round 908,717 to the nearest thousand.

Task card 18 Rounding to the Nearest 1,000

Round 109,849 to the nearest thousand.

Task card 19 Rounding to the Nearest 1,000

The dot shows 554,644. Round it to the nearest thousand: is it 554,000 or 555,000?

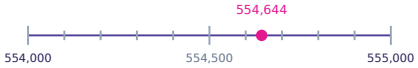

Task card 20 Rounding to the Nearest 1,000

The dot shows 662,175. Round it to the nearest thousand: is it 662,000 or 663,000?

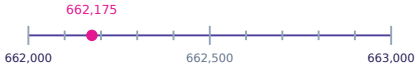

Task card 21 Rounding to the Nearest 1,000

You want to round 969,854 to the nearest thousand. Which digit of 969,854 tells you whether to round up or down?

Task card 22 Rounding to the Nearest 1,000

Which of these three numbers rounds to 692,000 when you round to the nearest thousand? 691,441 or 691,865 or 691,038

Task card 23 Rounding to the Nearest 1,000

A factory made 829,515 bottles this month. About how many is that, rounded to the nearest thousand?

Task card 24 Rounding to the Nearest 1,000

What is the smallest whole number that rounds to 860,000 when you round to the nearest thousand?

Rounding to the Nearest 1,000 Task Cards

Recording sheet · Grade 4 · Round each number to the place named. The same kind of rounding comes in different shapes.

Name: _____ Date: _____

Scan to check your answers

1	2	3	4
5	6	7	8
9	10	11	12
13	14	15	16
17	18	19	20
21	22	23	24

Rounding to the Nearest 1,000 Task Cards: Answer Key

Grade 4 · Hard

The answers online

1. 897,000	**2.** 300,000	**3.** 428,000
4. 642,000	**5.** 8	**6.** 293,690
7. 250,000	**8.** 158,500	**9.** 850,000
10. 165,000	**11.** 535,000	**12.** 740,000
13. 1	**14.** 469,919	**15.** 249,000
16. 699,500	**17.** 909,000	**18.** 110,000
19. 555,000	**20.** 662,000	**21.** 8
22. 691,865	**23.** 830,000	**24.** 859,500