Task card 1 Rounding to the Nearest 1,000

Round 3,110 to the nearest thousand.

Task card 2 Rounding to the Nearest 1,000

Round 2,423 to the nearest thousand.

Task card 3 Rounding to the Nearest 1,000

The dot shows 1,880. Round it to the nearest thousand: is it 1,000 or 2,000?

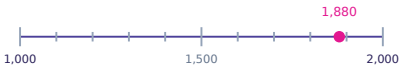

Task card 4 Rounding to the Nearest 1,000

The dot shows 5,124. Round it to the nearest thousand: is it 5,000 or 6,000?

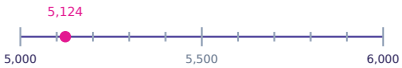

Task card 5 Rounding to the Nearest 1,000

You want to round 4,038 to the nearest thousand. Which digit of 4,038 tells you whether to round up or down?

Task card 6 Rounding to the Nearest 1,000

Which of these three numbers rounds to 3,000 when you round to the nearest thousand? 3,129 or 3,820 or 2,154

Task card 7 Rounding to the Nearest 1,000

A website had 1,859 visits today. About how many is that, rounded to the nearest thousand?

Task card 8 Rounding to the Nearest 1,000

What is the biggest whole number that rounds to 9,000 when you round to the nearest thousand?

Task card 9 Rounding to the Nearest 1,000

Round 3,973 to the nearest thousand.

Task card 10 Rounding to the Nearest 1,000

Round 5,564 to the nearest thousand.

Task card 11 Rounding to the Nearest 1,000

The dot shows 7,320. Round it to the nearest thousand: is it 7,000 or 8,000?

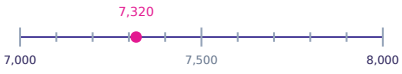

Task card 12 Rounding to the Nearest 1,000

The dot shows 6,592. Round it to the nearest thousand: is it 6,000 or 7,000?

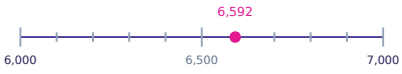

Task card 13 Rounding to the Nearest 1,000

You want to round 5,215 to the nearest thousand. Which digit of 5,215 tells you whether to round up or down?

Task card 14 Rounding to the Nearest 1,000

Which of these three numbers rounds to 9,000 when you round to the nearest thousand? 8,493 or 8,062 or 8,546

Task card 15 Rounding to the Nearest 1,000

A farm picked 8,500 apples. About how many is that, rounded to the nearest thousand?

Task card 16 Rounding to the Nearest 1,000

What is the biggest whole number that rounds to 7,000 when you round to the nearest thousand?

Task card 17 Rounding to the Nearest 1,000

Round 90,947 to the nearest thousand.

Task card 18 Rounding to the Nearest 1,000

Round 90,983 to the nearest thousand.

Task card 19 Rounding to the Nearest 1,000

The dot shows 87,709. Round it to the nearest thousand: is it 87,000 or 88,000?

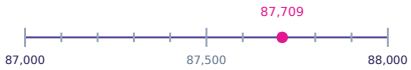

Task card 20 Rounding to the Nearest 1,000

The dot shows 92,288. Round it to the nearest thousand: is it 92,000 or 93,000?

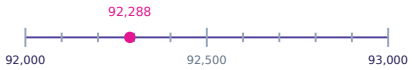

Task card 21 Rounding to the Nearest 1,000

You want to round 14,190 to the nearest thousand. Which digit of 14,190 tells you whether to round up or down?

Task card 22 Rounding to the Nearest 1,000

Which of these three numbers rounds to 42,000 when you round to the nearest thousand? 42,266 or 42,723 or 41,125

Task card 23 Rounding to the Nearest 1,000

A city has 97,573 people. About how many is that, rounded to the nearest thousand?

Task card 24 Rounding to the Nearest 1,000

What is the biggest whole number that rounds to 71,000 when you round to the nearest thousand?

Rounding to the Nearest 1,000 Task Cards

Recording sheet · Grade 4 · Round each number to the place named. The same kind of rounding comes in different shapes.

Scan to check your answers

Name: _____ Date: _____

1	2	3	4
5	6	7	8
9	10	11	12
13	14	15	16
17	18	19	20
21	22	23	24

Rounding to the Nearest 1,000 Task Cards: Answer Key

Grade 4 · Easy

The answers online

1. 3,000	**2.** 2,000	**3.** 2,000
4. 5,000	**5.** 0	**6.** 3,129
7. 2,000	**8.** 9,499	**9.** 4,000
10. 6,000	**11.** 7,000	**12.** 7,000
13. 2	**14.** 8,546	**15.** 9,000
16. 7,499	**17.** 91,000	**18.** 91,000
19. 88,000	**20.** 92,000	**21.** 1
22. 42,266	**23.** 98,000	**24.** 71,499