Rounding to the Nearest 1,000 · 1

Round 44,642 to the nearest thousand.

Rounding to the Nearest 1,000 · 2

Round 33,909 to the nearest thousand.

Rounding to the Nearest 1,000 · 3

The dot shows 98,313. Round it to the nearest thousand: is it 98,000 or 99,000?

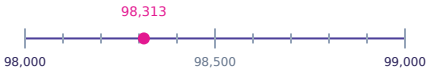

Rounding to the Nearest 1,000 · 4

The dot shows 59,534. Round it to the nearest thousand: is it 59,000 or 60,000?

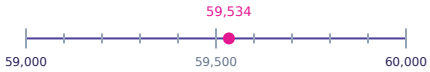

Rounding to the Nearest 1,000 · 5

You want to round 33,201 to the nearest thousand. Which digit of 33,201 tells you whether to round up or down?

Rounding to the Nearest 1,000 · 6

Which of these three numbers rounds to 23,000 when you round to the nearest thousand? 22,835 or 22,335 or 22,200

Rounding to the Nearest 1,000 · 7

A city has 32,556 people. About how many is that, rounded to the nearest thousand?

Rounding to the Nearest 1,000 · 8

What is the biggest whole number that rounds to 50,000 when you round to the nearest thousand?

Rounding to the Nearest 1,000 · 2

ANSWER

34,000

Rounding to the Nearest 1,000 · 1

ANSWER

45,000

Rounding to the Nearest 1,000 · 4

ANSWER

60,000

Rounding to the Nearest 1,000 · 3

ANSWER

98,000

Rounding to the Nearest 1,000 · 6

ANSWER

22,835

Rounding to the Nearest 1,000 · 5

ANSWER

2

Rounding to the Nearest 1,000 · 8

ANSWER

50,499

Rounding to the Nearest 1,000 · 7

ANSWER

33,000

Rounding to the Nearest 1,000 · 9

Round 67,695 to the nearest thousand.

Rounding to the Nearest 1,000 · 10

Round 56,408 to the nearest thousand.

Rounding to the Nearest 1,000 · 11

The dot shows 88,837. Round it to the nearest thousand: is it 88,000 or 89,000?



Rounding to the Nearest 1,000 · 12

The dot shows 99,587. Round it to the nearest thousand: is it 99,000 or 100,000?

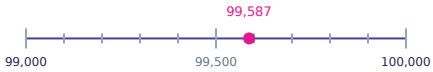

Rounding to the Nearest 1,000 · 13

You want to round 92,721 to the nearest thousand. Which digit of 92,721 tells you whether to round up or down?

Rounding to the Nearest 1,000 · 14

Which of these three numbers rounds to 77,000 when you round to the nearest thousand? 77,523 or 77,817 or 77,307

Rounding to the Nearest 1,000 · 15

A website had 30,515 visits this week. About how many is that, rounded to the nearest thousand?

Rounding to the Nearest 1,000 · 16

What is the biggest whole number that rounds to 100,000 when you round to the nearest thousand?

Rounding to the Nearest 1,000 · 10

ANSWER

56,000

Rounding to the Nearest 1,000 · 9

ANSWER

68,000

Rounding to the Nearest 1,000 · 12

ANSWER

100,000

Rounding to the Nearest 1,000 · 11

ANSWER

89,000

Rounding to the Nearest 1,000 · 14

ANSWER

77,307

Rounding to the Nearest 1,000 · 13

ANSWER

7

Rounding to the Nearest 1,000 · 16

ANSWER

100,499

Rounding to the Nearest 1,000 · 15

ANSWER

31,000

Rounding to the Nearest 1,000 · 17

Round 872,829 to the nearest thousand.

Rounding to the Nearest 1,000 · 18

Round 340,239 to the nearest thousand.

Rounding to the Nearest 1,000 · 19

The dot shows 949,824. Round it to the nearest thousand: is it 949,000 or 950,000?

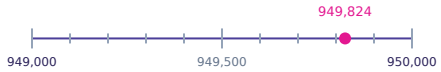

Rounding to the Nearest 1,000 · 20

The dot shows 985,675. Round it to the nearest thousand: is it 985,000 or 986,000?

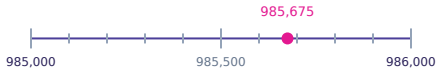

Rounding to the Nearest 1,000 · 21

You want to round 760,901 to the nearest thousand. Which digit of 760,901 tells you whether to round up or down?

Rounding to the Nearest 1,000 · 22

Which of these three numbers rounds to 820,000 when you round to the nearest thousand? 819,073 or 819,971 or 820,520

Rounding to the Nearest 1,000 · 23

A website had 593,555 visits this week. About how many is that, rounded to the nearest thousand?

Rounding to the Nearest 1,000 · 24

What is the biggest whole number that rounds to 780,000 when you round to the nearest thousand?

Rounding to the Nearest 1,000 · 18

ANSWER

340,000

Rounding to the Nearest 1,000 · 17

ANSWER

873,000

Rounding to the Nearest 1,000 · 20

ANSWER

986,000

Rounding to the Nearest 1,000 · 19

ANSWER

950,000

Rounding to the Nearest 1,000 · 22

ANSWER

819,971

Rounding to the Nearest 1,000 · 21

ANSWER

9

Rounding to the Nearest 1,000 · 24

ANSWER

780,499

Rounding to the Nearest 1,000 · 23

ANSWER

594,000