Rounding to the Nearest 1,000 · 1

Round 3,110 to the nearest thousand.

Rounding to the Nearest 1,000 · 2

Round 2,423 to the nearest thousand.

Rounding to the Nearest 1,000 · 3

The dot shows 1,880. Round it to the nearest thousand: is it 1,000 or 2,000?

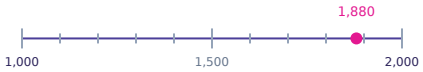

Rounding to the Nearest 1,000 · 4

The dot shows 5,124. Round it to the nearest thousand: is it 5,000 or 6,000?

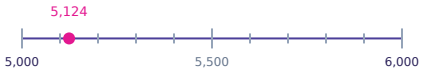

Rounding to the Nearest 1,000 · 5

You want to round 4,038 to the nearest thousand. Which digit of 4,038 tells you whether to round up or down?

Rounding to the Nearest 1,000 · 6

Which of these three numbers rounds to 3,000 when you round to the nearest thousand? 3,129 or 3,820 or 2,154

Rounding to the Nearest 1,000 · 7

A website had 1,859 visits today. About how many is that, rounded to the nearest thousand?

Rounding to the Nearest 1,000 · 8

What is the biggest whole number that rounds to 9,000 when you round to the nearest thousand?

Rounding to the Nearest 1,000 · 2

ANSWER

2,000

Rounding to the Nearest 1,000 · 1

ANSWER

3,000

Rounding to the Nearest 1,000 · 4

ANSWER

5,000

Rounding to the Nearest 1,000 · 3

ANSWER

2,000

Rounding to the Nearest 1,000 · 6

ANSWER

3,129

Rounding to the Nearest 1,000 · 5

ANSWER

0

Rounding to the Nearest 1,000 · 8

ANSWER

9,499

Rounding to the Nearest 1,000 · 7

ANSWER

2,000

Rounding to the Nearest 1,000 · 9

Round 3,973 to the nearest thousand.

Rounding to the Nearest 1,000 · 10

Round 5,564 to the nearest thousand.

Rounding to the Nearest 1,000 · 11

The dot shows 7,320. Round it to the nearest thousand: is it 7,000 or 8,000?

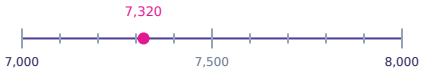

Rounding to the Nearest 1,000 · 12

The dot shows 6,592. Round it to the nearest thousand: is it 6,000 or 7,000?

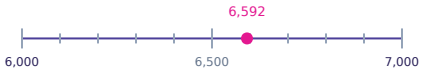

Rounding to the Nearest 1,000 · 13

You want to round 5,215 to the nearest thousand. Which digit of 5,215 tells you whether to round up or down?

Rounding to the Nearest 1,000 · 14

Which of these three numbers rounds to 9,000 when you round to the nearest thousand? 8,493 or 8,062 or 8,546

Rounding to the Nearest 1,000 · 15

A farm picked 8,500 apples. About how many is that, rounded to the nearest thousand?

Rounding to the Nearest 1,000 · 16

What is the biggest whole number that rounds to 7,000 when you round to the nearest thousand?

Rounding to the Nearest 1,000 · 10

ANSWER

6,000

Rounding to the Nearest 1,000 · 9

ANSWER

4,000

Rounding to the Nearest 1,000 · 12

ANSWER

7,000

Rounding to the Nearest 1,000 · 11

ANSWER

7,000

Rounding to the Nearest 1,000 · 14

ANSWER

8,546

Rounding to the Nearest 1,000 · 13

ANSWER

2

Rounding to the Nearest 1,000 · 16

ANSWER

7,499

Rounding to the Nearest 1,000 · 15

ANSWER

9,000

Rounding to the Nearest 1,000 · 17

Round 90,947 to the nearest thousand.

Rounding to the Nearest 1,000 · 18

Round 90,983 to the nearest thousand.

Rounding to the Nearest 1,000 · 19

The dot shows 87,709. Round it to the nearest thousand: is it 87,000 or 88,000?



Rounding to the Nearest 1,000 · 20

The dot shows 92,288. Round it to the nearest thousand: is it 92,000 or 93,000?

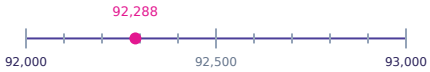

Rounding to the Nearest 1,000 · 21

You want to round 14,190 to the nearest thousand. Which digit of 14,190 tells you whether to round up or down?

Rounding to the Nearest 1,000 · 22

Which of these three numbers rounds to 42,000 when you round to the nearest thousand? 42,266 or 42,723 or 41,125

Rounding to the Nearest 1,000 · 23

A city has 97,573 people. About how many is that, rounded to the nearest thousand?

Rounding to the Nearest 1,000 · 24

What is the biggest whole number that rounds to 71,000 when you round to the nearest thousand?

Rounding to the Nearest 1,000 · 18

ANSWER

91,000

Rounding to the Nearest 1,000 · 17

ANSWER

91,000

Rounding to the Nearest 1,000 · 20

ANSWER

92,000

Rounding to the Nearest 1,000 · 19

ANSWER

88,000

Rounding to the Nearest 1,000 · 22

ANSWER

42,266

Rounding to the Nearest 1,000 · 21

ANSWER

1

Rounding to the Nearest 1,000 · 24

ANSWER

71,499

Rounding to the Nearest 1,000 · 23

ANSWER

98,000