Task card 1 Rounding to the Nearest 100

Round 873,330 to the nearest hundred.

Task card 2 Rounding to the Nearest 100

Round 139,969 to the nearest hundred.

Task card 3 Rounding to the Nearest 100

The dot shows 431,680. Round it to the nearest hundred: is it 431,600 or 431,700?



Task card 4 Rounding to the Nearest 100

The dot shows 554,255. Round it to the nearest hundred: is it 554,200 or 554,300?

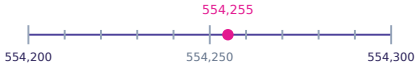

Task card 5 Rounding to the Nearest 100

You want to round 749,990 to the nearest hundred. Which digit of 749,990 tells you whether to round up or down?

Task card 6 Rounding to the Nearest 100

Which of these three numbers rounds to 974,800 when you round to the nearest hundred? 974,733 or 974,799 or 974,887

Task card 7 Rounding to the Nearest 100

A city has 195,999 people. About how many is that, rounded to the nearest hundred?

Task card 8 Rounding to the Nearest 100

What is the biggest whole number that rounds to 689,300 when you round to the nearest hundred?

Task card 9 Rounding to the Nearest 100

Round 529,968 to the nearest hundred.

Task card 10 Rounding to the Nearest 100

Round 961,460 to the nearest hundred.

Task card 11 Rounding to the Nearest 100

The dot shows 967,420. Round it to the nearest hundred: is it 967,400 or 967,500?



Task card 12 Rounding to the Nearest 100

The dot shows 609,958. Round it to the nearest hundred: is it 609,900 or 610,000?

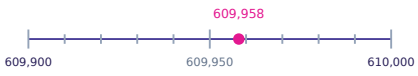

Task card 13 Rounding to the Nearest 100

You want to round 138,076 to the nearest hundred. Which digit of 138,076 tells you whether to round up or down?

Task card 14 Rounding to the Nearest 100

Which of these three numbers rounds to 223,000 when you round to the nearest hundred? 222,986 or 223,083 or 222,905

Task card 15 Rounding to the Nearest 100

A factory made 767,857 bottles this month. About how many is that, rounded to the nearest hundred?

Task card 16 Rounding to the Nearest 100

What is the biggest whole number that rounds to 370,000 when you round to the nearest hundred?

Task card 17 Rounding to the Nearest 100

Round 218,309 to the nearest hundred.

Task card 18 Rounding to the Nearest 100

Round 438,995 to the nearest hundred.

Task card 19 Rounding to the Nearest 100

The dot shows 959,773. Round it to the nearest hundred: is it 959,700 or 959,800?



Task card 20 Rounding to the Nearest 100

The dot shows 514,757. Round it to the nearest hundred: is it 514,700 or 514,800?

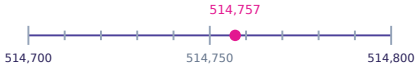

Task card 21 Rounding to the Nearest 100

You want to round 289,995 to the nearest hundred. Which digit of 289,995 tells you whether to round up or down?

Task card 22 Rounding to the Nearest 100

Which of these three numbers rounds to 923,400 when you round to the nearest hundred? 923,448 or 923,338 or 923,312

Task card 23 Rounding to the Nearest 100

A factory made 505,973 bottles this month. About how many is that, rounded to the nearest hundred?

Task card 24 Rounding to the Nearest 100

What is the biggest whole number that rounds to 199,800 when you round to the nearest hundred?

Rounding to the Nearest 100 Task Cards

Recording sheet · Grade 4 · Round each number to the place named. The same kind of rounding comes in different shapes.

Name: _____ Date: _____

Scan to check your answers

1	2	3	4
5	6	7	8
9	10	11	12
13	14	15	16
17	18	19	20
21	22	23	24

Rounding to the Nearest 100 Task Cards: Answer Key

Grade 4 · Hard

The answers online

1. 873,300	**2.** 140,000	**3.** 431,700
4. 554,300	**5.** 9	**6.** 974,799
7. 196,000	**8.** 689,349	**9.** 530,000
10. 961,500	**11.** 967,400	**12.** 610,000
13. 7	**14.** 222,986	**15.** 767,900
16. 370,049	**17.** 218,300	**18.** 439,000
19. 959,800	**20.** 514,800	**21.** 9
22. 923,448	**23.** 506,000	**24.** 199,849