Task card 1 Rounding to the Nearest 100

Round 1,486 to the nearest hundred.

Task card 2 Rounding to the Nearest 100

Round 9,898 to the nearest hundred.

Task card 3 Rounding to the Nearest 100

The dot shows 3,724. Round it to the nearest hundred: is it 3,700 or 3,800?



Task card 4 Rounding to the Nearest 100

The dot shows 9,965. Round it to the nearest hundred: is it 9,900 or 10,000?

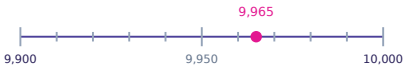

Task card 5 Rounding to the Nearest 100

You want to round 7,146 to the nearest hundred. Which digit of 7,146 tells you whether to round up or down?

Task card 6 Rounding to the Nearest 100

Which of these three numbers rounds to 5,600 when you round to the nearest hundred? 5,670 or 5,539 or 5,565

Task card 7 Rounding to the Nearest 100

A farm picked 3,253 apples. About how many is that, rounded to the nearest hundred?

Task card 8 Rounding to the Nearest 100

What is the biggest whole number that rounds to 6,000 when you round to the nearest hundred?

Task card 9 Rounding to the Nearest 100

Round 14,585 to the nearest hundred.

Task card 10 Rounding to the Nearest 100

Round 59,288 to the nearest hundred.

Task card 11 Rounding to the Nearest 100

The dot shows 61,070. Round it to the nearest hundred: is it 61,000 or 61,100?

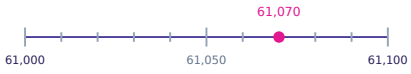

Task card 12 Rounding to the Nearest 100

The dot shows 18,997. Round it to the nearest hundred: is it 18,900 or 19,000?

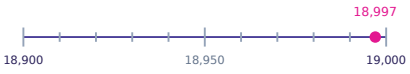

Task card 13 Rounding to the Nearest 100

You want to round 26,120 to the nearest hundred. Which digit of 26,120 tells you whether to round up or down?

Task card 14 Rounding to the Nearest 100

Which of these three numbers rounds to 19,200 when you round to the nearest hundred? 19,266 or 19,235 or 19,115

Task card 15 Rounding to the Nearest 100

A website had 51,256 visits this week. About how many is that, rounded to the nearest hundred?

Task card 16 Rounding to the Nearest 100

What is the biggest whole number that rounds to 30,000 when you round to the nearest hundred?

Task card 17 Rounding to the Nearest 100

Round 29,501 to the nearest hundred.

Task card 18 Rounding to the Nearest 100

Round 61,606 to the nearest hundred.

Task card 19 Rounding to the Nearest 100

The dot shows 66,965. Round it to the nearest hundred: is it 66,900 or 67,000?

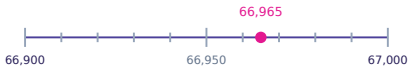

Task card 20 Rounding to the Nearest 100

The dot shows 41,332. Round it to the nearest hundred: is it 41,300 or 41,400?

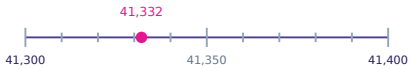

Task card 21 Rounding to the Nearest 100

You want to round 92,872 to the nearest hundred. Which digit of 92,872 tells you whether to round up or down?

Task card 22 Rounding to the Nearest 100

Which of these three numbers rounds to 97,000 when you round to the nearest hundred? 97,057 or 96,998 or 96,941

Task card 23 Rounding to the Nearest 100

A website had 75,851 visits this week. About how many is that, rounded to the nearest hundred?

Task card 24 Rounding to the Nearest 100

What is the smallest whole number that rounds to 15,000 when you round to the nearest hundred?

Rounding to the Nearest 100 Task Cards

Recording sheet · Grade 4 · Round each number to the place named. The same kind of rounding comes in different shapes.

Name: _____ Date: _____

Scan to check your answers

1	2	3	4
5	6	7	8
9	10	11	12
13	14	15	16
17	18	19	20
21	22	23	24

Rounding to the Nearest 100 Task Cards: Answer Key

Grade 4 · Medium

The answers online

1. 1,500	**2.** 9,900	**3.** 3,700
4. 10,000	**5.** 4	**6.** 5,565
7. 3,300	**8.** 6,049	**9.** 14,600
10. 59,300	**11.** 61,100	**12.** 19,000
13. 2	**14.** 19,235	**15.** 51,300
16. 30,049	**17.** 29,500	**18.** 61,600
19. 67,000	**20.** 41,300	**21.** 7
22. 96,998	**23.** 75,900	**24.** 14,950