Task card 1 Rounding to the Nearest 100

Round 546 to the nearest hundred.

Task card 2 Rounding to the Nearest 100

Round 877 to the nearest hundred.

Task card 3 Rounding to the Nearest 100

The dot shows 577. Round it to the nearest hundred: is it 500 or 600?



Task card 4 Rounding to the Nearest 100

The dot shows 806. Round it to the nearest hundred: is it 800 or 900?



Task card 5 Rounding to the Nearest 100

You want to round 947 to the nearest hundred. Which digit of 947 tells you whether to round up or down?

Task card 6 Rounding to the Nearest 100

Which of these three numbers rounds to 500 when you round to the nearest hundred? 580 or 520 or 424

Task card 7 Rounding to the Nearest 100

A box holds 929 stickers. About how many is that, rounded to the nearest hundred?

Task card 8 Rounding to the Nearest 100

What is the smallest whole number that rounds to 300 when you round to the nearest hundred?

Task card 9 Rounding to the Nearest 100

Round 586 to the nearest hundred.

Task card 10 Rounding to the Nearest 100

Round 756 to the nearest hundred.

Task card 11 Rounding to the Nearest 100

The dot shows 380. Round it to the nearest hundred: is it 300 or 400?



Task card 12 Rounding to the Nearest 100

The dot shows 259. Round it to the nearest hundred: is it 200 or 300?

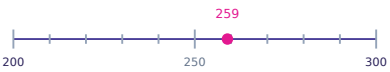

Task card 13 Rounding to the Nearest 100

You want to round 689 to the nearest hundred. Which digit of 689 tells you whether to round up or down?

Task card 14 Rounding to the Nearest 100

Which of these three numbers rounds to 400 when you round to the nearest hundred? 357 or 478 or 455

Task card 15 Rounding to the Nearest 100

A jar holds 558 beads. About how many is that, rounded to the nearest hundred?

Task card 16 Rounding to the Nearest 100

What is the smallest whole number that rounds to 400 when you round to the nearest hundred?

Task card 17 Rounding to the Nearest 100

Round 8,654 to the nearest hundred.

Task card 18 Rounding to the Nearest 100

Round 5,184 to the nearest hundred.

Task card 19 Rounding to the Nearest 100

The dot shows 3,322. Round it to the nearest hundred: is it 3,300 or 3,400?

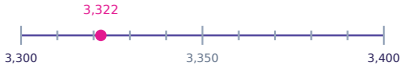

Task card 20 Rounding to the Nearest 100

The dot shows 7,026. Round it to the nearest hundred: is it 7,000 or 7,100?

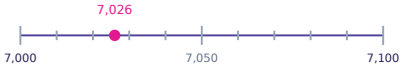

Task card 21 Rounding to the Nearest 100

You want to round 9,341 to the nearest hundred. Which digit of 9,341 tells you whether to round up or down?

Task card 22 Rounding to the Nearest 100

Which of these three numbers rounds to 4,900 when you round to the nearest hundred? 4,896 or 4,819 or 4,977

Task card 23 Rounding to the Nearest 100

A website had 9,256 visits today. About how many is that, rounded to the nearest hundred?

Task card 24 Rounding to the Nearest 100

What is the smallest whole number that rounds to 4,900 when you round to the nearest hundred?

Rounding to the Nearest 100 Task Cards

Recording sheet · Grade 4 · Round each number to the place named. The same kind of rounding comes in different shapes.

Name: _____ Date: _____

Scan to check your answers

1	2	3	4
5	6	7	8
9	10	11	12
13	14	15	16
17	18	19	20
21	22	23	24

Rounding to the Nearest 100 Task Cards: Answer Key

Grade 4 · Easy

The answers online

1. 500	**2.** 900	**3.** 600
4. 800	**5.** 4	**6.** 520
7. 900	**8.** 250	**9.** 600
10. 800	**11.** 400	**12.** 300
13. 8	**14.** 357	**15.** 600
16. 350	**17.** 8,700	**18.** 5,200
19. 3,300	**20.** 7,000	**21.** 4
22. 4,896	**23.** 9,300	**24.** 4,850