Rounding to the Nearest 100 · 1

Round 873,330 to the nearest hundred.

Rounding to the Nearest 100 · 2

Round 139,969 to the nearest hundred.

Rounding to the Nearest 100 · 3

The dot shows 431,680. Round it to the nearest hundred: is it 431,600 or 431,700?



Rounding to the Nearest 100 · 4

The dot shows 554,255. Round it to the nearest hundred: is it 554,200 or 554,300?

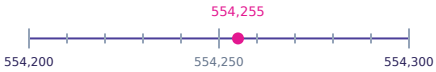

Rounding to the Nearest 100 · 5

You want to round 749,990 to the nearest hundred. Which digit of 749,990 tells you whether to round up or down?

Rounding to the Nearest 100 · 6

Which of these three numbers rounds to 974,800 when you round to the nearest hundred? 974,733 or 974,799 or 974,887

Rounding to the Nearest 100 · 7

A city has 195,999 people. About how many is that, rounded to the nearest hundred?

Rounding to the Nearest 100 · 8

What is the biggest whole number that rounds to 689,300 when you round to the nearest hundred?

Rounding to the Nearest 100 · 2

ANSWER

140,000

Rounding to the Nearest 100 · 1

ANSWER

873,300

Rounding to the Nearest 100 · 4

ANSWER

554,300

Rounding to the Nearest 100 · 3

ANSWER

431,700

Rounding to the Nearest 100 · 6

ANSWER

974,799

Rounding to the Nearest 100 · 5

ANSWER

9

Rounding to the Nearest 100 · 8

ANSWER

689,349

Rounding to the Nearest 100 · 7

ANSWER

196,000

Rounding to the Nearest 100 · 9

Round 529,968 to the nearest hundred.

Rounding to the Nearest 100 · 10

Round 961,460 to the nearest hundred.

Rounding to the Nearest 100 · 11

The dot shows 967,420. Round it to the nearest hundred: is it 967,400 or 967,500?



Rounding to the Nearest 100 · 12

The dot shows 609,958. Round it to the nearest hundred: is it 609,900 or 610,000?

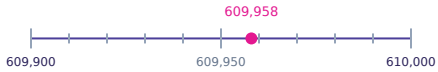

Rounding to the Nearest 100 · 13

You want to round 138,076 to the nearest hundred. Which digit of 138,076 tells you whether to round up or down?

Rounding to the Nearest 100 · 14

Which of these three numbers rounds to 223,000 when you round to the nearest hundred? 222,986 or 223,083 or 222,905

Rounding to the Nearest 100 · 15

A factory made 767,857 bottles this month. About how many is that, rounded to the nearest hundred?

Rounding to the Nearest 100 · 16

What is the biggest whole number that rounds to 370,000 when you round to the nearest hundred?

Rounding to the Nearest 100 · 10

ANSWER

961,500

Rounding to the Nearest 100 · 9

ANSWER

530,000

Rounding to the Nearest 100 · 12

ANSWER

610,000

Rounding to the Nearest 100 · 11

ANSWER

967,400

Rounding to the Nearest 100 · 14

ANSWER

222,986

Rounding to the Nearest 100 · 13

ANSWER

7

Rounding to the Nearest 100 · 16

ANSWER

370,049

Rounding to the Nearest 100 · 15

ANSWER

767,900

Rounding to the Nearest 100 · 17

Round 218,309 to the nearest hundred.

Rounding to the Nearest 100 · 18

Round 438,995 to the nearest hundred.

Rounding to the Nearest 100 · 19

The dot shows 959,773. Round it to the nearest hundred: is it 959,700 or 959,800?



Rounding to the Nearest 100 · 20

The dot shows 514,757. Round it to the nearest hundred: is it 514,700 or 514,800?

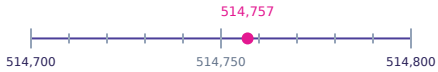

Rounding to the Nearest 100 · 21

You want to round 289,995 to the nearest hundred. Which digit of 289,995 tells you whether to round up or down?

Rounding to the Nearest 100 · 22

Which of these three numbers rounds to 923,400 when you round to the nearest hundred? 923,448 or 923,338 or 923,312

Rounding to the Nearest 100 · 23

A factory made 505,973 bottles this month. About how many is that, rounded to the nearest hundred?

Rounding to the Nearest 100 · 24

What is the biggest whole number that rounds to 199,800 when you round to the nearest hundred?

Rounding to the Nearest 100 · 18

ANSWER

439,000

Rounding to the Nearest 100 · 17

ANSWER

218,300

Rounding to the Nearest 100 · 20

ANSWER

514,800

Rounding to the Nearest 100 · 19

ANSWER

959,800

Rounding to the Nearest 100 · 22

ANSWER

923,448

Rounding to the Nearest 100 · 21

ANSWER

9

Rounding to the Nearest 100 · 24

ANSWER

199,849

Rounding to the Nearest 100 · 23

ANSWER

506,000