Rounding to the Nearest 100 · 1

Round 546 to the nearest hundred.

Rounding to the Nearest 100 · 2

Round 877 to the nearest hundred.

Rounding to the Nearest 100 · 3

The dot shows 577. Round it to the nearest hundred: is it 500 or 600?

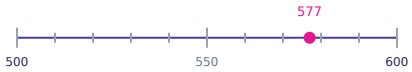

Rounding to the Nearest 100 · 4

The dot shows 806. Round it to the nearest hundred: is it 800 or 900?



Rounding to the Nearest 100 · 5

You want to round 947 to the nearest hundred. Which digit of 947 tells you whether to round up or down?

Rounding to the Nearest 100 · 6

Which of these three numbers rounds to 500 when you round to the nearest hundred? 580 or 520 or 424

Rounding to the Nearest 100 · 7

A box holds 929 stickers. About how many is that, rounded to the nearest hundred?

Rounding to the Nearest 100 · 8

What is the smallest whole number that rounds to 300 when you round to the nearest hundred?

Rounding to the Nearest 100 · 2

ANSWER

900

Rounding to the Nearest 100 · 1

ANSWER

500

Rounding to the Nearest 100 · 4

ANSWER

800

Rounding to the Nearest 100 · 3

ANSWER

600

Rounding to the Nearest 100 · 6

ANSWER

520

Rounding to the Nearest 100 · 5

ANSWER

4

Rounding to the Nearest 100 · 8

ANSWER

250

Rounding to the Nearest 100 · 7

ANSWER

900

Rounding to the Nearest 100 · 9

Round 586 to the nearest hundred.

Rounding to the Nearest 100 · 10

Round 756 to the nearest hundred.

Rounding to the Nearest 100 · 11

The dot shows 380. Round it to the nearest hundred: is it 300 or 400?

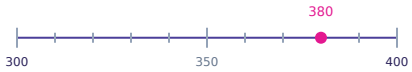

Rounding to the Nearest 100 · 12

The dot shows 259. Round it to the nearest hundred: is it 200 or 300?

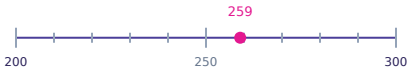

Rounding to the Nearest 100 · 13

You want to round 689 to the nearest hundred. Which digit of 689 tells you whether to round up or down?

Rounding to the Nearest 100 · 14

Which of these three numbers rounds to 400 when you round to the nearest hundred? 357 or 478 or 455

Rounding to the Nearest 100 · 15

A jar holds 558 beads. About how many is that, rounded to the nearest hundred?

Rounding to the Nearest 100 · 16

What is the smallest whole number that rounds to 400 when you round to the nearest hundred?

Rounding to the Nearest 100 · 10

ANSWER

800

Rounding to the Nearest 100 · 9

ANSWER

600

Rounding to the Nearest 100 · 12

ANSWER

300

Rounding to the Nearest 100 · 11

ANSWER

400

Rounding to the Nearest 100 · 14

ANSWER

357

Rounding to the Nearest 100 · 13

ANSWER

8

Rounding to the Nearest 100 · 16

ANSWER

350

Rounding to the Nearest 100 · 15

ANSWER

600

Rounding to the Nearest 100 · 17

Round 8,654 to the nearest hundred.

Rounding to the Nearest 100 · 18

Round 5,184 to the nearest hundred.

Rounding to the Nearest 100 · 19

The dot shows 3,322. Round it to the nearest hundred: is it 3,300 or 3,400?

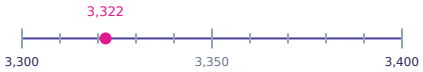

Rounding to the Nearest 100 · 20

The dot shows 7,026. Round it to the nearest hundred: is it 7,000 or 7,100?

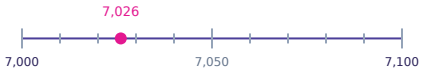

Rounding to the Nearest 100 · 21

You want to round 9,341 to the nearest hundred. Which digit of 9,341 tells you whether to round up or down?

Rounding to the Nearest 100 · 22

Which of these three numbers rounds to 4,900 when you round to the nearest hundred? 4,896 or 4,819 or 4,977

Rounding to the Nearest 100 · 23

A website had 9,256 visits today. About how many is that, rounded to the nearest hundred?

Rounding to the Nearest 100 · 24

What is the smallest whole number that rounds to 4,900 when you round to the nearest hundred?

Rounding to the Nearest 100 · 18

ANSWER

5,200

Rounding to the Nearest 100 · 17

ANSWER

8,700

Rounding to the Nearest 100 · 20

ANSWER

7,000

Rounding to the Nearest 100 · 19

ANSWER

3,300

Rounding to the Nearest 100 · 22

ANSWER

4,896

Rounding to the Nearest 100 · 21

ANSWER

4

Rounding to the Nearest 100 · 24

ANSWER

4,850

Rounding to the Nearest 100 · 23

ANSWER

9,300