Task card 1 Rounding to the Nearest 10

Round 28,227 to the nearest ten.

Task card 2 Rounding to the Nearest 10

Round 33,698 to the nearest ten.

Task card 3 Rounding to the Nearest 10

The dot shows 46,327. Round it to the nearest ten: is it 46,320 or 46,330?



Task card 4 Rounding to the Nearest 10

The dot shows 11,005. Round it to the nearest ten: is it 11,000 or 11,010?

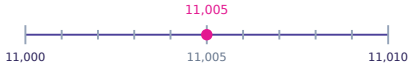

Task card 5 Rounding to the Nearest 10

You want to round 29,995 to the nearest ten. Which digit of 29,995 tells you whether to round up or down?

Task card 6 Rounding to the Nearest 10

Which of these three numbers rounds to 32,200 when you round to the nearest ten? 32,203 or 32,192 or 32,208

Task card 7 Rounding to the Nearest 10

A website had 38,699 visits this week. About how many is that, rounded to the nearest ten?

Task card 8 Rounding to the Nearest 10

What is the biggest whole number that rounds to 29,390 when you round to the nearest ten?

Task card 9 Rounding to the Nearest 10

Round 89,999 to the nearest ten.

Task card 10 Rounding to the Nearest 10

Round 70,003 to the nearest ten.

Task card 11 Rounding to the Nearest 10

The dot shows 51,722. Round it to the nearest ten: is it 51,720 or 51,730?

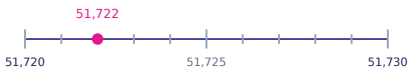

Task card 12 Rounding to the Nearest 10

The dot shows 60,796. Round it to the nearest ten: is it 60,790 or 60,800?

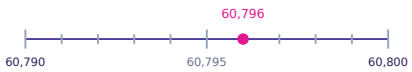

Task card 13 Rounding to the Nearest 10

You want to round 40,248 to the nearest ten. Which digit of 40,248 tells you whether to round up or down?

Task card 14 Rounding to the Nearest 10

Which of these three numbers rounds to 39,000 when you round to the nearest ten? 38,998 or 38,992 or 38,991

Task card 15 Rounding to the Nearest 10

A city has 65,465 people. About how many is that, rounded to the nearest ten?

Task card 16 Rounding to the Nearest 10

What is the smallest whole number that rounds to 20,200 when you round to the nearest ten?

Task card 17 Rounding to the Nearest 10

Round 77,211 to the nearest ten.

Task card 18 Rounding to the Nearest 10

Round 72,999 to the nearest ten.

Task card 19 Rounding to the Nearest 10

The dot shows 89,543. Round it to the nearest ten: is it 89,540 or 89,550?



Task card 20 Rounding to the Nearest 10

The dot shows 86,524. Round it to the nearest ten: is it 86,520 or 86,530?

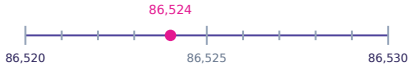

Task card 21 Rounding to the Nearest 10

You want to round 47,699 to the nearest ten. Which digit of 47,699 tells you whether to round up or down?

Task card 22 Rounding to the Nearest 10

Which of these three numbers rounds to 54,170 when you round to the nearest ten? 54,163 or 54,169 or 54,177

Task card 23 Rounding to the Nearest 10

A factory made 93,897 bottles this month. About how many is that, rounded to the nearest ten?

Task card 24 Rounding to the Nearest 10

What is the smallest whole number that rounds to 77,460 when you round to the nearest ten?

Rounding to the Nearest 10 Task Cards

Recording sheet · Grade 4 · Round each number to the place named. The same kind of rounding comes in different shapes.

Name: _____ Date: _____

Scan to check your answers

1	2	3	4
5	6	7	8
9	10	11	12
13	14	15	16
17	18	19	20
21	22	23	24

Rounding to the Nearest 10 Task Cards: Answer Key

Grade 4 · Hard

The answers online

1. 28,230	**2.** 33,700	**3.** 46,330
4. 11,010	**5.** 5	**6.** 32,203
7. 38,700	**8.** 29,394	**9.** 90,000
10. 70,000	**11.** 51,720	**12.** 60,800
13. 8	**14.** 38,998	**15.** 65,470
16. 20,195	**17.** 77,210	**18.** 73,000
19. 89,540	**20.** 86,520	**21.** 9
22. 54,169	**23.** 93,900	**24.** 77,455