Task card 1 Rounding to the Nearest 10

Round 718 to the nearest ten.

Task card 2 Rounding to the Nearest 10

Round 312 to the nearest ten.

Task card 3 Rounding to the Nearest 10

The dot shows 168. Round it to the nearest ten: is it 160 or 170?

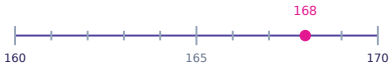

Task card 4 Rounding to the Nearest 10

The dot shows 998. Round it to the nearest ten: is it 990 or 1,000?



Task card 5 Rounding to the Nearest 10

You want to round 808 to the nearest ten. Which digit of 808 tells you whether to round up or down?

Task card 6 Rounding to the Nearest 10

Which of these three numbers rounds to 400 when you round to the nearest ten? 394 or 404 or 406

Task card 7 Rounding to the Nearest 10

A box holds 415 stickers. About how many is that, rounded to the nearest ten?

Task card 8 Rounding to the Nearest 10

What is the smallest whole number that rounds to 1,000 when you round to the nearest ten?

Task card 9 Rounding to the Nearest 10

Round 2,434 to the nearest ten.

Task card 10 Rounding to the Nearest 10

Round 6,027 to the nearest ten.

Task card 11 Rounding to the Nearest 10

The dot shows 4,337. Round it to the nearest ten: is it 4,330 or 4,340?



Task card 12 Rounding to the Nearest 10

The dot shows 3,996. Round it to the nearest ten: is it 3,990 or 4,000?

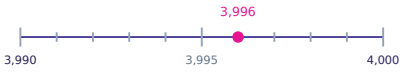

Task card 13 Rounding to the Nearest 10

You want to round 1,412 to the nearest ten. Which digit of 1,412 tells you whether to round up or down?

Task card 14 Rounding to the Nearest 10

Which of these three numbers rounds to 2,620 when you round to the nearest ten? 2,614 or 2,622 or 2,613

Task card 15 Rounding to the Nearest 10

A website had 5,255 visits today. About how many is that, rounded to the nearest ten?

Task card 16 Rounding to the Nearest 10

What is the smallest whole number that rounds to 7,000 when you round to the nearest ten?

Task card 17 Rounding to the Nearest 10

Round 3,928 to the nearest ten.

Task card 18 Rounding to the Nearest 10

Round 8,451 to the nearest ten.

Task card 19 Rounding to the Nearest 10

The dot shows 1,899. Round it to the nearest ten: is it 1,890 or 1,900?

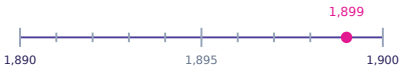

Task card 20 Rounding to the Nearest 10

The dot shows 9,678. Round it to the nearest ten: is it 9,670 or 9,680?



Task card 21 Rounding to the Nearest 10

You want to round 7,409 to the nearest ten. Which digit of 7,409 tells you whether to round up or down?

Task card 22 Rounding to the Nearest 10

Which of these three numbers rounds to 5,200 when you round to the nearest ten? 5,206 or 5,193 or 5,198

Task card 23 Rounding to the Nearest 10

A factory made 8,425 bottles today. About how many is that, rounded to the nearest ten?

Task card 24 Rounding to the Nearest 10

What is the biggest whole number that rounds to 3,600 when you round to the nearest ten?

Rounding to the Nearest 10 Task Cards

Recording sheet · Grade 4 · Round each number to the place named. The same kind of rounding comes in different shapes.

Name: _____ Date: _____

Scan to check your answers

1	2	3	4
5	6	7	8
9	10	11	12
13	14	15	16
17	18	19	20
21	22	23	24

Rounding to the Nearest 10 Task Cards: Answer Key

Grade 4 · Medium

The answers online

1. 720	**2.** 310	**3.** 170
4. 1,000	**5.** 8	**6.** 404
7. 420	**8.** 995	**9.** 2,430
10. 6,030	**11.** 4,340	**12.** 4,000
13. 2	**14.** 2,622	**15.** 5,260
16. 6,995	**17.** 3,930	**18.** 8,450
19. 1,900	**20.** 9,680	**21.** 9
22. 5,198	**23.** 8,430	**24.** 3,604