Task card 1 Rounding to the Nearest 10

Round 75 to the nearest ten.

Task card 2 Rounding to the Nearest 10

Round 89 to the nearest ten.

Task card 3 Rounding to the Nearest 10

The dot shows 82. Round it to the nearest ten: is it 80 or 90?

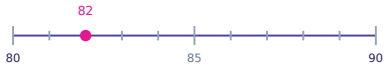

Task card 4 Rounding to the Nearest 10

The dot shows 57. Round it to the nearest ten: is it 50 or 60?

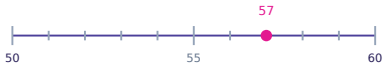

Task card 5 Rounding to the Nearest 10

You want to round 65 to the nearest ten. Which digit of 65 tells you whether to round up or down?

Task card 6 Rounding to the Nearest 10

Which of these three numbers rounds to 20 when you round to the nearest ten? 29 or 15 or 25

Task card 7 Rounding to the Nearest 10

A shop sold 41 apples today. About how many is that, rounded to the nearest ten?

Task card 8 Rounding to the Nearest 10

What is the biggest whole number that rounds to 30 when you round to the nearest ten?

Task card 9 Rounding to the Nearest 10

Round 26 to the nearest ten.

Task card 10 Rounding to the Nearest 10

Round 85 to the nearest ten.

Task card 11 Rounding to the Nearest 10

The dot shows 44. Round it to the nearest ten: is it 40 or 50?

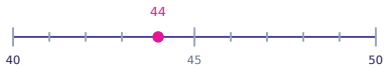

Task card 12 Rounding to the Nearest 10

The dot shows 45. Round it to the nearest ten: is it 40 or 50?

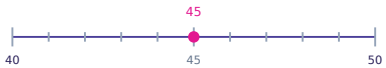

Task card 13 Rounding to the Nearest 10

You want to round 82 to the nearest ten. Which digit of 82 tells you whether to round up or down?

Task card 14 Rounding to the Nearest 10

Which of these three numbers rounds to 40 when you round to the nearest ten? 35 or 33 or 49

Task card 15 Rounding to the Nearest 10

A shop sold 35 apples today. About how many is that, rounded to the nearest ten?

Task card 16 Rounding to the Nearest 10

What is the smallest whole number that rounds to 30 when you round to the nearest ten?

Task card 17 Rounding to the Nearest 10

Round 549 to the nearest ten.

Task card 18 Rounding to the Nearest 10

Round 125 to the nearest ten.

Task card 19 Rounding to the Nearest 10

The dot shows 919. Round it to the nearest ten: is it 910 or 920?

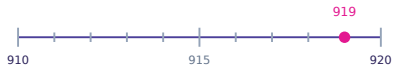

Task card 20 Rounding to the Nearest 10

The dot shows 427. Round it to the nearest ten: is it 420 or 430?



Task card 21 Rounding to the Nearest 10

You want to round 613 to the nearest ten. Which digit of 613 tells you whether to round up or down?

Task card 22 Rounding to the Nearest 10

Which of these three numbers rounds to 490 when you round to the nearest ten? 482 or 484 or 485

Task card 23 Rounding to the Nearest 10

A jar holds 545 beads. About how many is that, rounded to the nearest ten?

Task card 24 Rounding to the Nearest 10

What is the biggest whole number that rounds to 990 when you round to the nearest ten?

Rounding to the Nearest 10 Task Cards

Recording sheet · Grade 4 · Round each number to the place named. The same kind of rounding comes in different shapes.

Name: _____ Date: _____

Scan to check your answers

1	2	3	4
5	6	7	8
9	10	11	12
13	14	15	16
17	18	19	20
21	22	23	24

Rounding to the Nearest 10 Task Cards: Answer Key

Grade 4 · Easy

The answers online

1. 80	**2.** 90	**3.** 80
4. 60	**5.** 5	**6.** 15
7. 40	**8.** 34	**9.** 30
10. 90	**11.** 40	**12.** 50
13. 2	**14.** 35	**15.** 40
16. 25	**17.** 550	**18.** 130
19. 920	**20.** 430	**21.** 3
22. 485	**23.** 550	**24.** 994