Rounding to the Nearest 10 · 1

Round 718 to the nearest ten.

Rounding to the Nearest 10 · 2

Round 312 to the nearest ten.

Rounding to the Nearest 10 · 3

The dot shows 168. Round it to the nearest ten: is it 160 or 170?

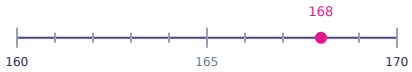

Rounding to the Nearest 10 · 4

The dot shows 998. Round it to the nearest ten: is it 990 or 1,000?



Rounding to the Nearest 10 · 5

You want to round 808 to the nearest ten. Which digit of 808 tells you whether to round up or down?

Rounding to the Nearest 10 · 6

Which of these three numbers rounds to 400 when you round to the nearest ten? 394 or 404 or 406

Rounding to the Nearest 10 · 7

A box holds 415 stickers. About how many is that, rounded to the nearest ten?

Rounding to the Nearest 10 · 8

What is the smallest whole number that rounds to 1,000 when you round to the nearest ten?

Rounding to the Nearest 10 · 2

ANSWER

310

Rounding to the Nearest 10 · 1

ANSWER

720

Rounding to the Nearest 10 · 4

ANSWER

1,000

Rounding to the Nearest 10 · 3

ANSWER

170

Rounding to the Nearest 10 · 6

ANSWER

404

Rounding to the Nearest 10 · 5

ANSWER

8

Rounding to the Nearest 10 · 8

ANSWER

995

Rounding to the Nearest 10 · 7

ANSWER

420

Rounding to the Nearest 10 · 9

Round 2,434 to the nearest ten.

Rounding to the Nearest 10 · 10

Round 6,027 to the nearest ten.

Rounding to the Nearest 10 · 11

The dot shows 4,337. Round it to the nearest ten: is it 4,330 or 4,340?



Rounding to the Nearest 10 · 12

The dot shows 3,996. Round it to the nearest ten: is it 3,990 or 4,000?

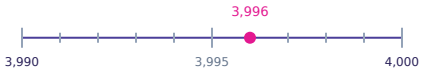

Rounding to the Nearest 10 · 13

You want to round 1,412 to the nearest ten. Which digit of 1,412 tells you whether to round up or down?

Rounding to the Nearest 10 · 14

Which of these three numbers rounds to 2,620 when you round to the nearest ten? 2,614 or 2,622 or 2,613

Rounding to the Nearest 10 · 15

A website had 5,255 visits today. About how many is that, rounded to the nearest ten?

Rounding to the Nearest 10 · 16

What is the smallest whole number that rounds to 7,000 when you round to the nearest ten?

Rounding to the Nearest 10 · 10

ANSWER

6,030

Rounding to the Nearest 10 · 9

ANSWER

2,430

Rounding to the Nearest 10 · 12

ANSWER

4,000

Rounding to the Nearest 10 · 11

ANSWER

4,340

Rounding to the Nearest 10 · 14

ANSWER

2,622

Rounding to the Nearest 10 · 13

ANSWER

2

Rounding to the Nearest 10 · 16

ANSWER

6,995

Rounding to the Nearest 10 · 15

ANSWER

5,260

Rounding to the Nearest 10 · 17

Round 3,928 to the nearest ten.

Rounding to the Nearest 10 · 18

Round 8,451 to the nearest ten.

Rounding to the Nearest 10 · 19

The dot shows 1,899. Round it to the nearest ten: is it 1,890 or 1,900?



Rounding to the Nearest 10 · 20

The dot shows 9,678. Round it to the nearest ten: is it 9,670 or 9,680?



Rounding to the Nearest 10 · 21

You want to round 7,409 to the nearest ten. Which digit of 7,409 tells you whether to round up or down?

Rounding to the Nearest 10 · 22

Which of these three numbers rounds to 5,200 when you round to the nearest ten? 5,206 or 5,193 or 5,198

Rounding to the Nearest 10 · 23

A factory made 8,425 bottles today. About how many is that, rounded to the nearest ten?

Rounding to the Nearest 10 · 24

What is the biggest whole number that rounds to 3,600 when you round to the nearest ten?

Rounding to the Nearest 10 · 18

ANSWER

8,450

Rounding to the Nearest 10 · 17

ANSWER

3,930

Rounding to the Nearest 10 · 20

ANSWER

9,680

Rounding to the Nearest 10 · 19

ANSWER

1,900

Rounding to the Nearest 10 · 22

ANSWER

5,198

Rounding to the Nearest 10 · 21

ANSWER

9

Rounding to the Nearest 10 · 24

ANSWER

3,604

Rounding to the Nearest 10 · 23

ANSWER

8,430