Task card 1 Points, Lines, Line Segments & Ray...

What is this figure called: point, line, line segment, or ray?



Task card 2 Points, Lines, Line Segments & Ray...

What is this figure called: point, line, line segment, or ray?



Task card 3 Points, Lines, Line Segments & Ray...

What is this figure called: point, line, line segment, or ray?



Task card 4 Points, Lines, Line Segments & Ray...

How many endpoints does this figure have?

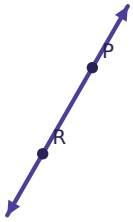

Task card 5 Points, Lines, Line Segments & Ray...

In how many directions does this figure go on forever?



Task card 6 Points, Lines, Line Segments & Ray...

It is straight and goes on forever in both directions. What is it called: point, line, line segment, or ray?

Task card 7 Points, Lines, Line Segments & Ray...

Think of a beam of light that starts at a flashlight and keeps on going. Which one is that most like: point, line, line segment, or ray?

Task card 8 Points, Lines, Line Segments & Ray...

Which letter marks the endpoint of this ray?



Task card 9 Points, Lines, Line Segments & Ray...

What is this figure called: point, line, line segment, or ray?



Task card 10 Points, Lines, Line Segments & Ray...

What is this figure called: point, line, line segment, or ray?



Task card 11 Points, Lines, Line Segments & Ray...

What is this figure called: point, line, line segment, or ray?



Task card 12 Points, Lines, Line Segments & Ray...

How many endpoints does this figure have?

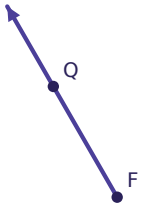

Task card 13 Points, Lines, Line Segments & Ray...

In how many directions does this figure go on forever?

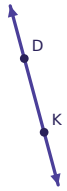

Task card 14 Points, Lines, Line Segments & Ray...

It is straight, has one endpoint and goes on forever in one direction. What is it called: point, line, line segment, or ray?

Task card 15 Points, Lines, Line Segments & Ray...

Think of a straight road that never ends in either direction. Which one is that most like: point, line, line segment, or ray?

Task card 16 Points, Lines, Line Segments & Ray...

Which letter marks the endpoint of this ray?



Task card 17 Points, Lines, Line Segments & Ray...

What is this figure called: point, line, line segment, ray, or angle?

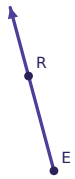

Task card 18 Points, Lines, Line Segments & Ray...

What is this figure called: point, line, line segment, ray, or angle?

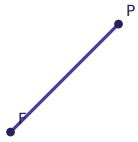

Task card 19 Points, Lines, Line Segments & Ray...

What is this figure called: point, line, line segment, ray, or angle?

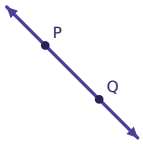

Task card 20 Points, Lines, Line Segments & Ray...

How many endpoints does this figure have?



Task card 21 Points, Lines, Line Segments & Ray...

In how many directions does this figure go on forever?



Task card 22 Points, Lines, Line Segments & Ray...

It is straight, has one endpoint and goes on forever in one direction. What is it called: point, line, line segment, ray, or angle?

Task card 23 Points, Lines, Line Segments & Ray...

Think of the edge of a ruler, from one end to the other. Which one is that most like: point, line, line segment, ray, or angle?

Task card 24 Points, Lines, Line Segments & Ray...

Which letter marks the endpoint of this ray?

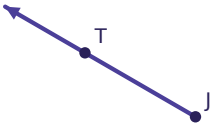

Points, Lines, Line Segments & Rays Task Cards

Recording sheet · Grade 4 · Answer each question. When words are given, use one of them. The same figures come in different shapes.

Scan to check your answers

Name: _____ Date: _____

1	2	3	4
5	6	7	8
9	10	11	12
13	14	15	16
17	18	19	20
21	22	23	24

Points, Lines, Line Segments & Rays Task Cards: Answer Key

Grade 4 · Easy

The answers online

1. point	**2.** line	**3.** ray
4. 0	**5.** 1	**6.** line
7. ray	**8.** B	**9.** point
10. ray	**11.** line	**12.** 1
13. 2	**14.** ray	**15.** line
16. T	**17.** ray	**18.** line segment
19. line	**20.** 1	**21.** 0
22. ray	**23.** line segment	**24.** J