Points, Lines, Line Segments & Rays · 1

What is this figure called: point, line, line segment, or ray?



Points, Lines, Line Segments & Rays · 2

What is this figure called: point, line, line segment, or ray?



Points, Lines, Line Segments & Rays · 3

What is this figure called: point, line, line segment, or ray?



Points, Lines, Line Segments & Rays · 4

How many endpoints does this figure have?



Points, Lines, Line Segments & Rays · 5

In how many directions does this figure go on forever?



Points, Lines, Line Segments & Rays · 6

It is straight and goes on forever in both directions. What is it called: point, line, line segment, or ray?

Points, Lines, Line Segments & Rays · 7

Think of a beam of light that starts at a flashlight and keeps on going. Which one is that most like: point, line, line segment, or ray?

Points, Lines, Line Segments & Rays · 8

Which letter marks the endpoint of this ray?



Points, Lines, Line Segments & Rays · 2

ANSWER

line

Points, Lines, Line Segments & Rays · 1

ANSWER

point

Points, Lines, Line Segments & Rays · 4

ANSWER

0

Points, Lines, Line Segments & Rays · 3

ANSWER

ray

Points, Lines, Line Segments & Rays · 6

ANSWER

line

Points, Lines, Line Segments & Rays · 5

ANSWER

1

Points, Lines, Line Segments & Rays · 8

ANSWER

B

Points, Lines, Line Segments & Rays · 7

ANSWER

ray

Points, Lines, Line Segments & Rays · 9

What is this figure called: point, line, line segment, or ray?



Points, Lines, Line Segments & Rays · 10

What is this figure called: point, line, line segment, or ray?



Points, Lines, Line Segments & Rays · 11

What is this figure called: point, line, line segment, or ray?



Points, Lines, Line Segments & Rays · 12

How many endpoints does this figure have?

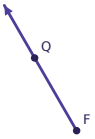

Points, Lines, Line Segments & Rays · 13

In how many directions does this figure go on forever?



Points, Lines, Line Segments & Rays · 14

It is straight, has one endpoint and goes on forever in one direction. What is it called: point, line, line segment, or ray?

Points, Lines, Line Segments & Rays · 15

Think of a straight road that never ends in either direction. Which one is that most like: point, line, line segment, or ray?

Points, Lines, Line Segments & Rays · 16

Which letter marks the endpoint of this ray?



Points, Lines, Line Segments & Rays · 10

ANSWER

ray

Points, Lines, Line Segments & Rays · 9

ANSWER

point

Points, Lines, Line Segments & Rays · 12

ANSWER

1

Points, Lines, Line Segments & Rays · 11

ANSWER

line

Points, Lines, Line Segments & Rays · 14

ANSWER

ray

Points, Lines, Line Segments & Rays · 13

ANSWER

2

Points, Lines, Line Segments & Rays · 16

ANSWER

T

Points, Lines, Line Segments & Rays · 15

ANSWER

line

Points, Lines, Line Segments & Rays · 17

What is this figure called: point, line, line segment, ray, or angle?

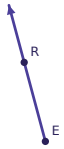

Points, Lines, Line Segments & Rays · 18

What is this figure called: point, line, line segment, ray, or angle?



Points, Lines, Line Segments & Rays · 19

What is this figure called: point, line, line segment, ray, or angle?

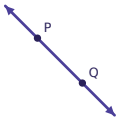

Points, Lines, Line Segments & Rays · 20

How many endpoints does this figure have?



Points, Lines, Line Segments & Rays · 21

In how many directions does this figure go on forever?



Points, Lines, Line Segments & Rays · 22

It is straight, has one endpoint and goes on forever in one direction. What is it called: point, line, line segment, ray, or angle?

Points, Lines, Line Segments & Rays · 23

Think of the edge of a ruler, from one end to the other. Which one is that most like: point, line, line segment, ray, or angle?

Points, Lines, Line Segments & Rays · 24

Which letter marks the endpoint of this ray?



Points, Lines, Line Segments & Rays · 18

ANSWER

line segment

Points, Lines, Line Segments & Rays · 17

ANSWER

ray

Points, Lines, Line Segments & Rays · 20

ANSWER

1

Points, Lines, Line Segments & Rays · 19

ANSWER

line

Points, Lines, Line Segments & Rays · 22

ANSWER

ray

Points, Lines, Line Segments & Rays · 21

ANSWER

0

Points, Lines, Line Segments & Rays · 24

ANSWER

J

Points, Lines, Line Segments & Rays · 23

ANSWER

line segment