**Task card 1** Division with Partial Quotients

Add the lengths on top.

84 ÷ 6 = ___

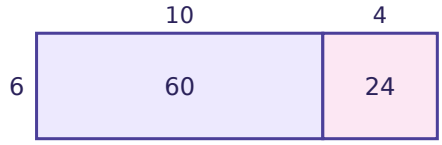


**Task card 2** Division with Partial Quotients

Add the lengths on top.

220 ÷ 5 = ___

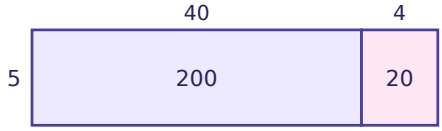


**Task card 3** Division with Partial Quotients

Add the lengths on top.

368 ÷ 4 = ___

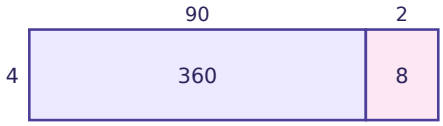


**Task card 4** Division with Partial Quotients

Add the lengths on top.

147 ÷ 3 = ___

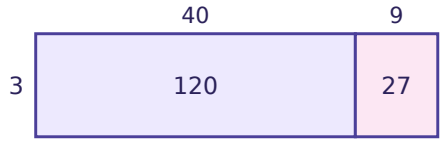


**Task card 5** Division with Partial Quotients

6 × 30 = ___ (the missing part of 234)

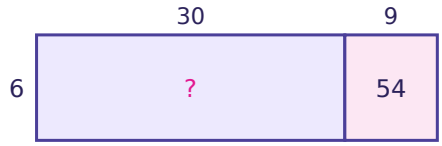


**Task card 6** Division with Partial Quotients

Add the lengths on top.

66 ÷ 2 = ___

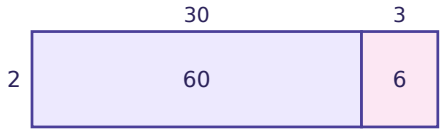

**Task card 7** Division with Partial Quotients

$24 \div 4 = ___$

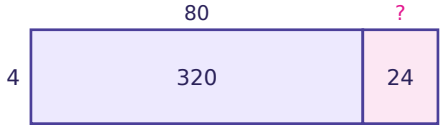


**Task card 8** Division with Partial Quotients

$240 \div 8 = ___$

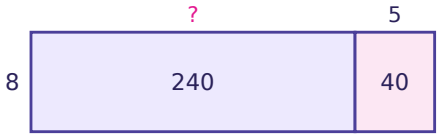


**Task card 9** Division with Partial Quotients

$4 \times 3 = ___$ (the missing part of 172)

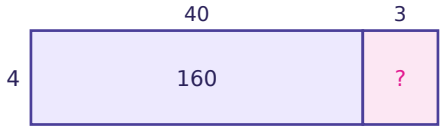


**Task card 10** Division with Partial Quotients

$280 \div 7 = ___$




**Task card 11** Division with Partial Quotients

$40 \div 5 = ___$

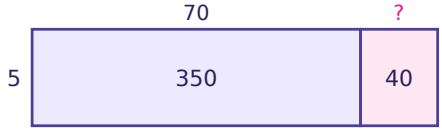


**Task card 12** Division with Partial Quotients

Add the lengths on top.

$425 \div 5 = ___$

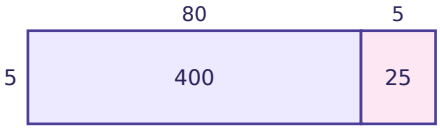

**Task card 13** Division with Partial Quotients

Add the lengths on top.

270 ÷ 6 = ___

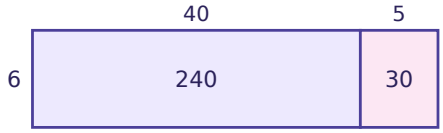


**Task card 14** Division with Partial Quotients

Add the lengths on top.

686 ÷ 7 = ___

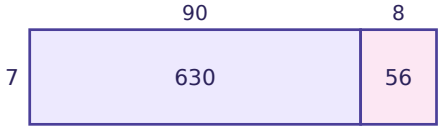


**Task card 15** Division with Partial Quotients

Add the lengths on top.

384 ÷ 8 = ___

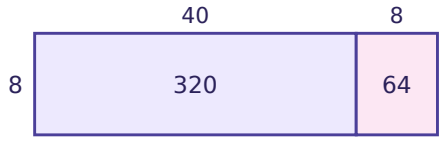


**Task card 16** Division with Partial Quotients

Add the lengths on top.

159 ÷ 3 = ___




**Task card 17** Division with Partial Quotients

Add the lengths on top.

1605 ÷ 5 = ___

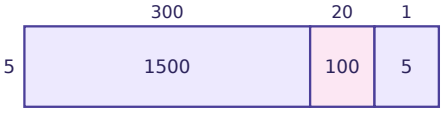


**Task card 18** Division with Partial Quotients

1540 ÷ 4 = ___



**Task card 19** Division with Partial Quotients

$4 \times 400 = ___$ (the missing part of 1660)




**Task card 20** Division with Partial Quotients

$1820 \div 7 = ___$

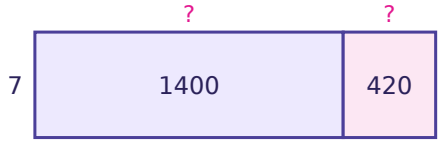


**Task card 21** Division with Partial Quotients

Add the lengths on top.

$2793 \div 7 = ___$




**Task card 22** Division with Partial Quotients

$1107 \div 9 = ___$




**Task card 23** Division with Partial Quotients

$2965 \div 5 = ___$




**Task card 24** Division with Partial Quotients

Add the lengths on top.

$3048 \div 6 = ___$

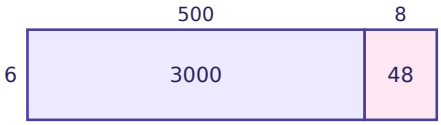

# Division with Partial Quotients Task Cards

Recording sheet · Grade 4 · Use the area model. The number on the side is the divisor, the numbers inside are the parts of the dividend. Fill in the blank.

Name: _____ Date: _____

Scan to check your answers

| | | | |
|---|---|---|---|
| 1 | 2 | 3 | 4 |
| 5 | 6 | 7 | 8 |
| 9 | 10 | 11 | 12 |
| 13 | 14 | 15 | 16 |
| 17 | 18 | 19 | 20 |
| 21 | 22 | 23 | 24 |

# Division with Partial Quotients Task Cards: Answer Key

Grade 4 · Medium

The answers online

| | | |
|---|---|---|
| **1.** 14 | **2.** 44 | **3.** 92 |
| **4.** 49 | **5.** 180 | **6.** 33 |
| **7.** 6 | **8.** 30 | **9.** 12 |
| **10.** 40 | **11.** 8 | **12.** 85 |
| **13.** 45 | **14.** 98 | **15.** 48 |
| **16.** 53 | **17.** 321 | **18.** 385 |
| **19.** 1600 | **20.** 260 | **21.** 399 |
| **22.** 123 | **23.** 593 | **24.** 508 |